Task card 1 Winter Math

One batch of a recipe uses $\frac{5}{8}$ cup of mini marshmallows. Zoe makes 2 batches. How many cups of mini marshmallows does Zoe use?

Task card 2 Winter Math

One cup of hot cocoa costs $3.20. Leo buys 8 cups of hot cocoa. How much does Leo spend?

Task card 3 Winter Math

A cookie box is 8 inches long, 8 inches wide and 4 inches tall. What is its volume in cubic inches?

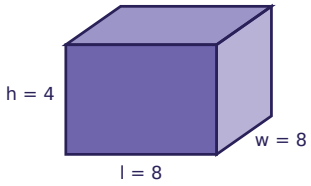

Task card 4 Winter Math

Mia buys a pair of mittens for $9.71 and pays with a $10 bill. How much change does Mia get?

Task card 5 Winter Math

One winter hat costs $6.75. Noah buys 9 winter hats. How much does Noah spend?

Task card 6 Winter Math

Leo buys a pair of mittens for $9.99 and pays with a $10 bill. How much change does Leo get?

Task card 7 Winter Math

A cookie box is 5 inches long, 8 inches wide and 4 inches tall. What is its volume in cubic inches?

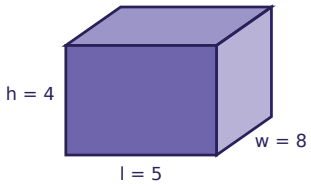

Task card 8 Winter Math

One batch of a recipe uses $\frac{5}{8}$ cup of mini marshmallows. Noah makes 5 batches. How many cups of mini marshmallows does Noah use?

Task card 9 Winter Math

Sam buys a cup of hot cocoa for $2.43 and pays with a $10 bill. How much change does Sam get?

Task card 10 Winter Math

One batch of a recipe uses $\frac{2}{3}$ cup of mini marshmallows. Lily makes 3 batches. How many cups of mini marshmallows does Lily use?

Task card 11 Winter Math

A cookie box is 12 inches long, 9 inches wide and 3 inches tall. What is its volume in cubic inches?

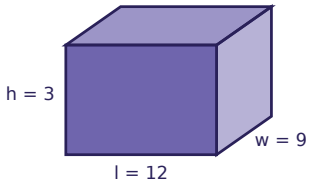

Task card 12 Winter Math

One cup of hot cocoa costs $3.55. Mia buys 9 cups of hot cocoa. How much does Mia spend?

Task card 13 Winter Math

One cup of hot cocoa costs $2.30. Ben buys 9 cups of hot cocoa. How much does Ben spend?

Task card 14 Winter Math

A cookie box is 5 inches long, 7 inches wide and 3 inches tall. What is its volume in cubic inches?

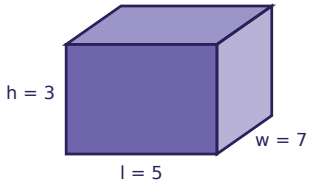

Task card 15 Winter Math

Leo buys a winter hat for $7.20 and pays with a $10 bill. How much change does Leo get?

Task card 16 Winter Math

One batch of a recipe uses $\frac{3}{4}$ cup of mini marshmallows. Ava makes 6 batches. How many cups of mini marshmallows does Ava use?

Task card 17 Winter Math

A cookie box is 10 inches long, 8 inches wide and 7 inches tall. What is its volume in cubic inches?

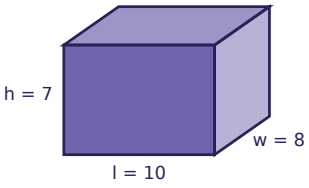

Task card 18 Winter Math

One batch of a recipe uses $\frac{5}{6}$ cup of mini marshmallows. Omar makes 6 batches. How many cups of mini marshmallows does Omar use?

Task card 19 Winter Math

One cup of hot cocoa costs $3.60. Omar buys 5 cups of hot cocoa. How much does Omar spend?

Task card 20 Winter Math

One winter hat costs $13.80. Mia buys 4 winter hats. How much does Mia spend?

Task card 21 Winter Math

Ella buys a cup of hot cocoa for $2.44 and pays with a $10 bill. How much change does Ella get?

Task card 22 Winter Math

One batch of a recipe uses $\frac{5}{8}$ cup of mini marshmallows. Omar makes 6 batches. How many cups of mini marshmallows does Omar use?

Task card 23 Winter Math

A cookie box is 12 inches long, 4 inches wide and 8 inches tall. What is its volume in cubic inches?

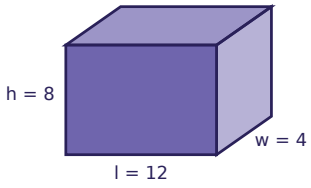

Task card 24 Winter Math

Ava buys a pair of mittens for $6.87 and pays with a $10 bill. How much change does Ava get?

Winter Math Task Cards

Recording sheet · Grade 5 · Read each story and solve. Write money like $4.50 and fractions like 1 1/2.

Name: _____ Date: _____

Scan to check your answers

1	2	3	4
5	6	7	8
9	10	11	12
13	14	15	16
17	18	19	20
21	22	23	24

Winter Math Task Cards: Answer Key

Grade 5 · Hard

The answers online

1. $1\frac{1}{4}$	**2.** $25.60	**3.** 256
4. $0.29	**5.** $60.75	**6.** $0.01
7. 160	**8.** $3\frac{1}{8}$	**9.** $7.57
10. 2	**11.** 324	**12.** $31.95
13. $20.70	**14.** 105	**15.** $2.80
16. $4\frac{1}{2}$	**17.** 560	**18.** 5
19. $18.00	**20.** $55.20	**21.** $7.56
22. $3\frac{3}{4}$	**23.** 384	**24.** $3.13