Task card 1 Winter Math

Omar buys a cup of hot cocoa for $3.75 and pays with a $10 bill. How much change does Omar get?

Task card 2 Winter Math

One pair of mittens costs $6.35. Omar buys 2 pairs of mittens. How much does Omar spend?

Task card 3 Winter Math

Lily buys a winter hat for $12.20 and pays with a $20 bill. How much change does Lily get?

Task card 4 Winter Math

A cookie box is 6 inches long, 4 inches wide and 4 inches tall. What is its volume in cubic inches?

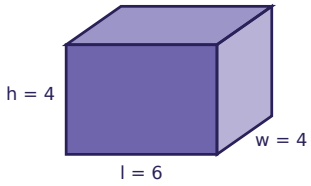

Task card 5 Winter Math

A cookie box is 5 inches long, 4 inches wide and 2 inches tall. What is its volume in cubic inches?

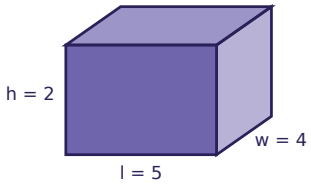

Task card 6 Winter Math

One pair of mittens costs $8.30. Sam buys 3 pairs of mittens. How much does Sam spend?

Task card 7 Winter Math

One batch of a recipe uses $\frac{3}{4}$ cup of mini marshmallows. Omar makes 2 batches. How many cups of mini marshmallows does Omar use?

Task card 8 Winter Math

One batch of a recipe uses $\frac{3}{4}$ cup of mini marshmallows. Mia makes 2 batches. How many cups of mini marshmallows does Mia use?

Task card 9 Winter Math

A cookie box is 8 inches long, 4 inches wide and 2 inches tall. What is its volume in cubic inches?

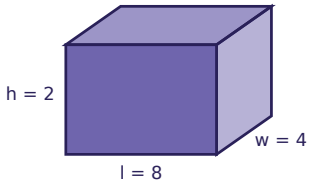

Task card 10 Winter Math

One batch of a recipe uses $\frac{3}{4}$ cup of mini marshmallows. Ava makes 2 batches. How many cups of mini marshmallows does Ava use?

Task card 11 Winter Math

One pair of mittens costs $7.05. Ava buys 2 pairs of mittens. How much does Ava spend?

Task card 12 Winter Math

A cookie box is 5 inches long, 5 inches wide and 3 inches tall. What is its volume in cubic inches?

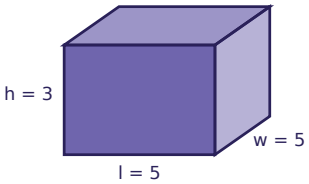

Task card 13 Winter Math

One pair of mittens costs $10.70. Ava buys 5 pairs of mittens. How much does Ava spend?

Task card 14 Winter Math

One batch of a recipe uses $\frac{3}{4}$ cup of mini marshmallows. Omar makes 4 batches. How many cups of mini marshmallows does Omar use?

Task card 15 Winter Math

Lily buys a pair of mittens for $8.75 and pays with a $10 bill. How much change does Lily get?

Task card 16 Winter Math

Leo buys a pair of mittens for $9.00 and pays with a $10 bill. How much change does Leo get?

Task card 17 Winter Math

One batch of a recipe uses $\frac{1}{2}$ cup of mini marshmallows. Ben makes 3 batches. How many cups of mini marshmallows does Ben use?

Task card 18 Winter Math

One winter hat costs $10.95. Zoe buys 2 winter hats. How much does Zoe spend?

Task card 19 Winter Math

One cup of hot cocoa costs $2.30. Sam buys 5 cups of hot cocoa. How much does Sam spend?

Task card 20 Winter Math

One batch of a recipe uses $\frac{3}{4}$ cup of mini marshmallows. Ava makes 4 batches. How many cups of mini marshmallows does Ava use?

Task card 21 Winter Math

A cookie box is 4 inches long, 4 inches wide and 5 inches tall. What is its volume in cubic inches?

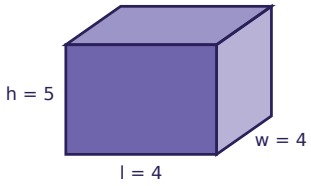

Task card 22 Winter Math

A cookie box is 7 inches long, 5 inches wide and 6 inches tall. What is its volume in cubic inches?

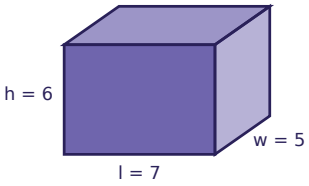

Task card 23 Winter Math

Zoe buys a winter hat for $6.40 and pays with a $10 bill. How much change does Zoe get?

Task card 24 Winter Math

Zoe buys a cup of hot cocoa for $2.70 and pays with a $10 bill. How much change does Zoe get?

Winter Math Task Cards

Recording sheet · Grade 5 · Read each story and solve. Write money like $4.50 and fractions like 1 1/2.

Name: _____ Date: _____

Scan to check your answers

1	2	3	4
5	6	7	8
9	10	11	12
13	14	15	16
17	18	19	20
21	22	23	24

Winter Math Task Cards: Answer Key

Grade 5 · Easy

The answers online

1. $6.25	**2.** $12.70	**3.** $7.80
4. 96	**5.** 40	**6.** $24.90
7. $1\frac{1}{2}$	**8.** $1\frac{1}{2}$	**9.** 64
10. $1\frac{1}{2}$	**11.** $14.10	**12.** 75
13. $53.50	**14.** 3	**15.** $1.25
16. $1.00	**17.** $1\frac{1}{2}$	**18.** $21.90
19. $11.50	**20.** 3	**21.** 80
22. 210	**23.** $3.60	**24.** $7.30