Winter Math · 1

One winter hat costs $12.80. Ben buys 2 winter hats. How much does Ben spend?

Winter Math · 2

One batch of a recipe uses $\frac{3}{4}$ cup of mini marshmallows. Zoe makes 3 batches. How many cups of mini marshmallows does Zoe use?

Winter Math · 3

A cookie box is 4 inches long, 4 inches wide and 7 inches tall. What is its volume in cubic inches?

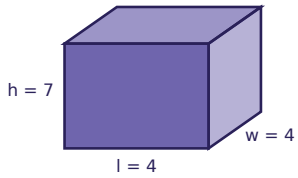

Winter Math · 4

A cookie box is 9 inches long, 8 inches wide and 3 inches tall. What is its volume in cubic inches?

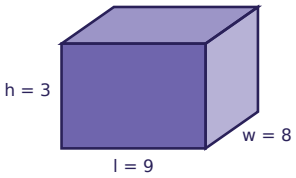

Winter Math · 5

One cup of hot cocoa costs $3.50. Omar buys 3 cups of hot cocoa. How much does Omar spend?

Winter Math · 6

One batch of a recipe uses $\frac{1}{4}$ cup of mini marshmallows. Ava makes 5 batches. How many cups of mini marshmallows does Ava use?

Winter Math · 7

Sam buys a winter hat for $9.60 and pays with a $10 bill. How much change does Sam get?

Winter Math · 8

Noah buys a pair of mittens for $7.90 and pays with a $10 bill. How much change does Noah get?

Winter Math · 2

ANSWER

$2\frac{1}{4}$

Winter Math · 1

ANSWER

$25.60

Winter Math · 4

ANSWER

216

Winter Math · 3

ANSWER

112

Winter Math · 6

ANSWER

$1\frac{1}{4}$

Winter Math · 5

ANSWER

$10.50

Winter Math · 8

ANSWER

$2.10

Winter Math · 7

ANSWER

$0.40

Winter Math · 9

One batch of a recipe uses $\frac{3}{4}$ cup of mini marshmallows. Ava makes 2 batches. How many cups of mini marshmallows does Ava use?

Winter Math · 10

One cup of hot cocoa costs $3.25. Ava buys 8 cups of hot cocoa. How much does Ava spend?

Winter Math · 11

A cookie box is 10 inches long, 3 inches wide and 5 inches tall. What is its volume in cubic inches?

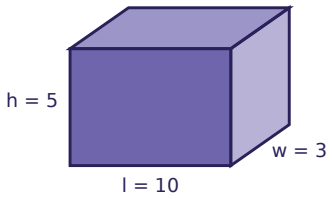

Winter Math · 12

Lily buys a winter hat for $8.56 and pays with a $10 bill. How much change does Lily get?

Winter Math · 13

A cookie box is 11 inches long, 6 inches wide and 7 inches tall. What is its volume in cubic inches?

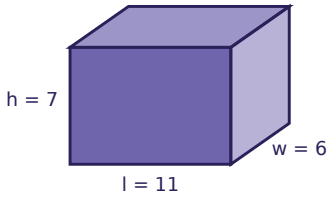

Winter Math · 14

Omar buys a winter hat for $6.75 and pays with a $10 bill. How much change does Omar get?

Winter Math · 15

One batch of a recipe uses $\frac{5}{6}$ cup of mini marshmallows. Ella makes 4 batches. How many cups of mini marshmallows does Ella use?

Winter Math · 16

One pair of mittens costs $5.15. Zoe buys 3 pairs of mittens. How much does Zoe spend?

Winter Math · 10

ANSWER

$26.00

Winter Math · 9

ANSWER

$1\frac{1}{2}$

Winter Math · 12

ANSWER

$1.44

Winter Math · 11

ANSWER

150

Winter Math · 14

ANSWER

$3.25

Winter Math · 13

ANSWER

462

Winter Math · 16

ANSWER

$15.45

Winter Math · 15

ANSWER

$3\frac{1}{3}$

Winter Math · 17

A cookie box is 8 inches long, 8 inches wide and 7 inches tall. What is its volume in cubic inches?

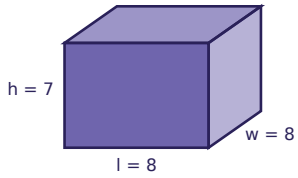

Winter Math · 18

Ben buys a cup of hot cocoa for $3.37 and pays with a $10 bill. How much change does Ben get?

Winter Math · 19

Mia buys a cup of hot cocoa for $3.57 and pays with a $10 bill. How much change does Mia get?

Winter Math · 20

A cookie box is 8 inches long, 7 inches wide and 4 inches tall. What is its volume in cubic inches?

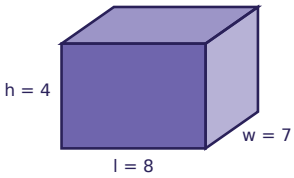

Winter Math · 21

One batch of a recipe uses $\frac{5}{6}$ cup of mini marshmallows. Sam makes 3 batches. How many cups of mini marshmallows does Sam use?

Winter Math · 22

One batch of a recipe uses $\frac{5}{8}$ cup of mini marshmallows. Noah makes 5 batches. How many cups of mini marshmallows does Noah use?

Winter Math · 23

One winter hat costs $11.35. Ben buys 4 winter hats. How much does Ben spend?

Winter Math · 24

One winter hat costs $8.50. Mia buys 2 winter hats. How much does Mia spend?

Winter Math · 18

ANSWER

$6.63

Winter Math · 17

ANSWER

448

Winter Math · 20

ANSWER

224

Winter Math · 19

ANSWER

$6.43

Winter Math · 22

ANSWER

$3\frac{1}{8}$

Winter Math · 21

ANSWER

$2\frac{1}{2}$

Winter Math · 24

ANSWER

$17.00

Winter Math · 23

ANSWER

$45.40