Winter Math · 1

One batch of a recipe uses $\frac{5}{8}$ cup of mini marshmallows. Zoe makes 2 batches. How many cups of mini marshmallows does Zoe use?

Winter Math · 2

One cup of hot cocoa costs $3.20. Leo buys 8 cups of hot cocoa. How much does Leo spend?

Winter Math · 3

A cookie box is 8 inches long, 8 inches wide and 4 inches tall. What is its volume in cubic inches?

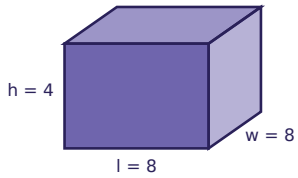

Winter Math · 4

Mia buys a pair of mittens for $9.71 and pays with a $10 bill. How much change does Mia get?

Winter Math · 5

One winter hat costs $6.75. Noah buys 9 winter hats. How much does Noah spend?

Winter Math · 6

Leo buys a pair of mittens for $9.99 and pays with a $10 bill. How much change does Leo get?

Winter Math · 7

A cookie box is 5 inches long, 8 inches wide and 4 inches tall. What is its volume in cubic inches?

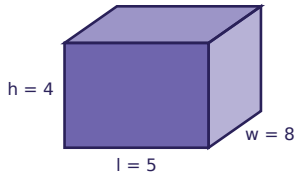

Winter Math · 8

One batch of a recipe uses $\frac{5}{8}$ cup of mini marshmallows. Noah makes 5 batches. How many cups of mini marshmallows does Noah use?

Winter Math · 2

ANSWER

$25.60

Winter Math · 1

ANSWER

$1\frac{1}{4}$

Winter Math · 4

ANSWER

$0.29

Winter Math · 3

ANSWER

256

Winter Math · 6

ANSWER

$0.01

Winter Math · 5

ANSWER

$60.75

Winter Math · 8

ANSWER

$3\frac{1}{8}$

Winter Math · 7

ANSWER

160

Winter Math · 9

Sam buys a cup of hot cocoa for $2.43 and pays with a $10 bill. How much change does Sam get?

Winter Math · 10

One batch of a recipe uses $\frac{2}{3}$ cup of mini marshmallows. Lily makes 3 batches. How many cups of mini marshmallows does Lily use?

Winter Math · 11

A cookie box is 12 inches long, 9 inches wide and 3 inches tall. What is its volume in cubic inches?

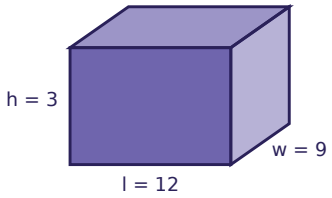

Winter Math · 12

One cup of hot cocoa costs $3.55. Mia buys 9 cups of hot cocoa. How much does Mia spend?

Winter Math · 13

One cup of hot cocoa costs $2.30. Ben buys 9 cups of hot cocoa. How much does Ben spend?

Winter Math · 14

A cookie box is 5 inches long, 7 inches wide and 3 inches tall. What is its volume in cubic inches?

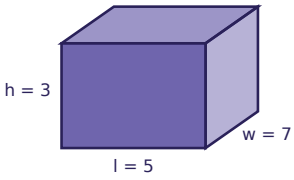

Winter Math · 15

Leo buys a winter hat for $7.20 and pays with a $10 bill. How much change does Leo get?

Winter Math · 16

One batch of a recipe uses $\frac{3}{4}$ cup of mini marshmallows. Ava makes 6 batches. How many cups of mini marshmallows does Ava use?

Winter Math · 10

ANSWER

2

Winter Math · 9

ANSWER

$7.57

Winter Math · 12

ANSWER

$31.95

Winter Math · 11

ANSWER

324

Winter Math · 14

ANSWER

105

Winter Math · 13

ANSWER

$20.70

Winter Math · 16

ANSWER

$$4\frac{1}{2}$$

Winter Math · 15

ANSWER

$2.80

Winter Math · 17

A cookie box is 10 inches long, 8 inches wide and 7 inches tall. What is its volume in cubic inches?

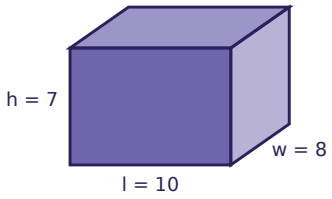

Winter Math · 18

One batch of a recipe uses $\frac{5}{6}$ cup of mini marshmallows. Omar makes 6 batches. How many cups of mini marshmallows does Omar use?

Winter Math · 19

One cup of hot cocoa costs $3.60. Omar buys 5 cups of hot cocoa. How much does Omar spend?

Winter Math · 20

One winter hat costs $13.80. Mia buys 4 winter hats. How much does Mia spend?

Winter Math · 21

Ella buys a cup of hot cocoa for $2.44 and pays with a $10 bill. How much change does Ella get?

Winter Math · 22

One batch of a recipe uses $\frac{5}{8}$ cup of mini marshmallows. Omar makes 6 batches. How many cups of mini marshmallows does Omar use?

Winter Math · 23

A cookie box is 12 inches long, 4 inches wide and 8 inches tall. What is its volume in cubic inches?

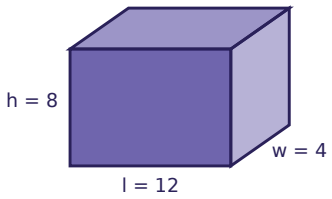

Winter Math · 24

Ava buys a pair of mittens for $6.87 and pays with a $10 bill. How much change does Ava get?

Winter Math · 18

ANSWER

5

Winter Math · 17

ANSWER

560

Winter Math · 20

ANSWER

$55.20

Winter Math · 19

ANSWER

$18.00

Winter Math · 22

ANSWER

$$3\frac{3}{4}$$

Winter Math · 21

ANSWER

$7.56

Winter Math · 24

ANSWER

$3.13

Winter Math · 23

ANSWER

384