Winter Math · 1

Omar buys a cup of hot cocoa for $3.75 and pays with a $10 bill. How much change does Omar get?

Winter Math · 2

One pair of mittens costs $6.35. Omar buys 2 pairs of mittens. How much does Omar spend?

Winter Math · 3

Lily buys a winter hat for $12.20 and pays with a $20 bill. How much change does Lily get?

Winter Math · 4

A cookie box is 6 inches long, 4 inches wide and 4 inches tall. What is its volume in cubic inches?

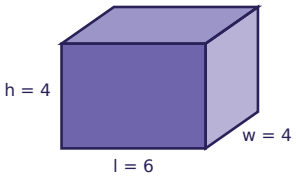

Winter Math · 5

A cookie box is 5 inches long, 4 inches wide and 2 inches tall. What is its volume in cubic inches?

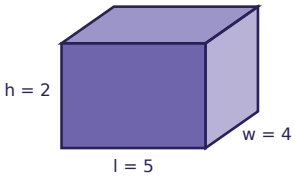

Winter Math · 6

One pair of mittens costs $8.30. Sam buys 3 pairs of mittens. How much does Sam spend?

Winter Math · 7

One batch of a recipe uses $\frac{3}{4}$ cup of mini marshmallows. Omar makes 2 batches. How many cups of mini marshmallows does Omar use?

Winter Math · 8

One batch of a recipe uses $\frac{3}{4}$ cup of mini marshmallows. Mia makes 2 batches. How many cups of mini marshmallows does Mia use?

Winter Math · 2

ANSWER

$12.70

Winter Math · 1

ANSWER

$6.25

Winter Math · 4

ANSWER

96

Winter Math · 3

ANSWER

$7.80

Winter Math · 6

ANSWER

$24.90

Winter Math · 5

ANSWER

40

Winter Math · 8

ANSWER

$$1\frac{1}{2}$$

Winter Math · 7

ANSWER

$$1\frac{1}{2}$$

Winter Math · 9

A cookie box is 8 inches long, 4 inches wide and 2 inches tall. What is its volume in cubic inches?

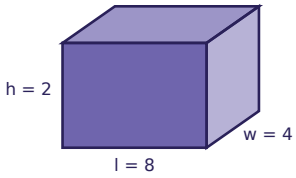

Winter Math · 10

One batch of a recipe uses $\frac{3}{4}$ cup of mini marshmallows. Ava makes 2 batches. How many cups of mini marshmallows does Ava use?

Winter Math · 11

One pair of mittens costs $7.05. Ava buys 2 pairs of mittens. How much does Ava spend?

Winter Math · 12

A cookie box is 5 inches long, 5 inches wide and 3 inches tall. What is its volume in cubic inches?

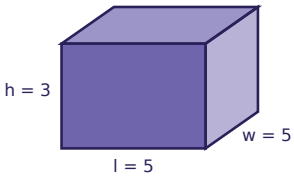

Winter Math · 13

One pair of mittens costs $10.70. Ava buys 5 pairs of mittens. How much does Ava spend?

Winter Math · 14

One batch of a recipe uses $\frac{3}{4}$ cup of mini marshmallows. Omar makes 4 batches. How many cups of mini marshmallows does Omar use?

Winter Math · 15

Lily buys a pair of mittens for $8.75 and pays with a $10 bill. How much change does Lily get?

Winter Math · 16

Leo buys a pair of mittens for $9.00 and pays with a $10 bill. How much change does Leo get?

Winter Math · 10

ANSWER

$1\frac{1}{2}$

Winter Math · 9

ANSWER

64

Winter Math · 12

ANSWER

75

Winter Math · 11

ANSWER

$14.10

Winter Math · 14

ANSWER

3

Winter Math · 13

ANSWER

$53.50

Winter Math · 16

ANSWER

$1.00

Winter Math · 15

ANSWER

$1.25

Winter Math · 17

One batch of a recipe uses $\frac{1}{2}$ cup of mini marshmallows. Ben makes 3 batches. How many cups of mini marshmallows does Ben use?

Winter Math · 18

One winter hat costs $10.95. Zoe buys 2 winter hats. How much does Zoe spend?

Winter Math · 19

One cup of hot cocoa costs $2.30. Sam buys 5 cups of hot cocoa. How much does Sam spend?

Winter Math · 20

One batch of a recipe uses $\frac{3}{4}$ cup of mini marshmallows. Ava makes 4 batches. How many cups of mini marshmallows does Ava use?

Winter Math · 21

A cookie box is 4 inches long, 4 inches wide and 5 inches tall. What is its volume in cubic inches?

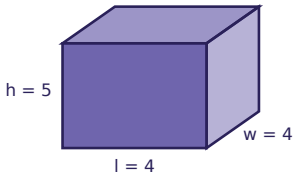

Winter Math · 22

A cookie box is 7 inches long, 5 inches wide and 6 inches tall. What is its volume in cubic inches?

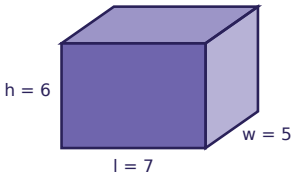

Winter Math · 23

Zoe buys a winter hat for $6.40 and pays with a $10 bill. How much change does Zoe get?

Winter Math · 24

Zoe buys a cup of hot cocoa for $2.70 and pays with a $10 bill. How much change does Zoe get?

Winter Math · 18

ANSWER

$21.90

Winter Math · 17

ANSWER

$$1\frac{1}{2}$$

Winter Math · 20

ANSWER

3

Winter Math · 19

ANSWER

$11.50

Winter Math · 22

ANSWER

210

Winter Math · 21

ANSWER

80

Winter Math · 24

ANSWER

$7.30

Winter Math · 23

ANSWER

$3.60