Volume by Counting Cubes · 1

How many unit cubes make this solid? Give the volume in cubic units.

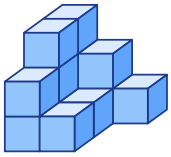

Volume by Counting Cubes · 2

How many unit cubes make this solid? Give the volume in cubic units.

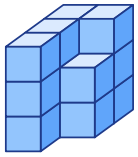

Volume by Counting Cubes · 3

How many unit cubes make this solid? Give the volume in cubic units.

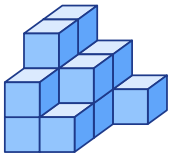

Volume by Counting Cubes · 4

How many cubes of this solid are in the bottom layer, touching the floor?

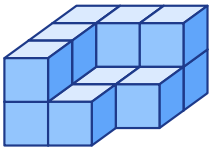

Volume by Counting Cubes · 5

How many cubes are in the tallest stack of this solid?

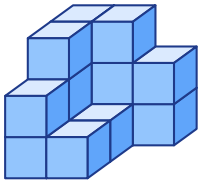

Volume by Counting Cubes · 6

Count the cubes in both solids. What is their volume together, in cubic units?

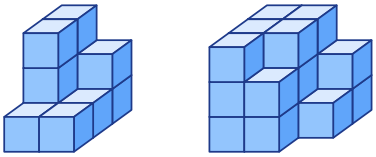

Volume by Counting Cubes · 7

How many more cubes are needed to fill this solid in, so it becomes a full box 3 cubes long, 3 cubes wide and 3 cubes tall?

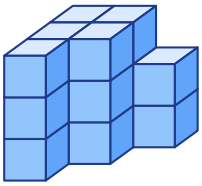

Volume by Counting Cubes · 8

One more cube is put on top of every stack of this solid. What is the volume now, in cubic units?

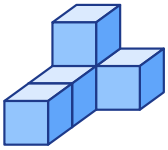

Volume by Counting Cubes · 2

ANSWER

14

Volume by Counting Cubes · 1

ANSWER

13

Volume by Counting Cubes · 4

ANSWER

8

Volume by Counting Cubes · 3

ANSWER

14

Volume by Counting Cubes · 6

ANSWER

31

Volume by Counting Cubes · 5

ANSWER

3

Volume by Counting Cubes · 8

ANSWER

9

Volume by Counting Cubes · 7

ANSWER

10

Volume by Counting Cubes · 9

How many unit cubes make this solid? Give the volume in cubic units.

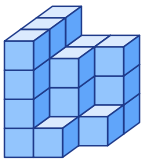

Volume by Counting Cubes · 10

How many unit cubes make this solid? Give the volume in cubic units.

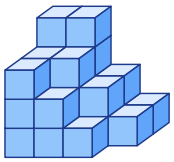

Volume by Counting Cubes · 11

How many unit cubes make this solid? Give the volume in cubic units.

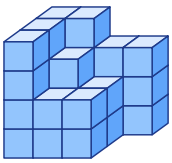

Volume by Counting Cubes · 12

How many cubes of this solid are in the bottom layer, touching the floor?

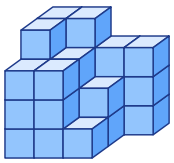

Volume by Counting Cubes · 13

How many cubes are in the tallest stack of this solid?

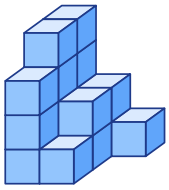

Volume by Counting Cubes · 14

Count the cubes in both solids. What is their volume together, in cubic units?

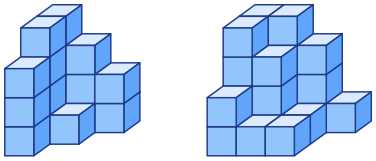

Volume by Counting Cubes · 15

How many more cubes are needed to fill this solid in, so it becomes a full box 3 cubes long, 3 cubes wide and 4 cubes tall?

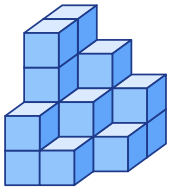

Volume by Counting Cubes · 16

One more cube is put on top of every stack of this solid. What is the volume now, in cubic units?

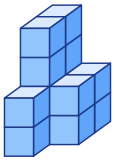

Volume by Counting Cubes · 10

ANSWER

26

Volume by Counting Cubes · 9

ANSWER

23

Volume by Counting Cubes · 12

ANSWER

10

Volume by Counting Cubes · 11

ANSWER

31

Volume by Counting Cubes · 14

ANSWER

41

Volume by Counting Cubes · 13

ANSWER

4

Volume by Counting Cubes · 16

ANSWER

19

Volume by Counting Cubes · 15

ANSWER

17

Volume by Counting Cubes · 17

How many unit cubes make this solid? Give the volume in cubic units.

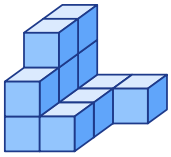

Volume by Counting Cubes · 18

How many unit cubes make this solid? Give the volume in cubic units.

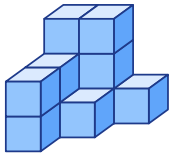

Volume by Counting Cubes · 19

How many unit cubes make this solid? Give the volume in cubic units.

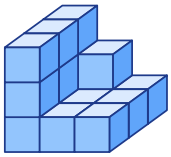

Volume by Counting Cubes · 20

How many cubes of this solid are in the bottom layer, touching the floor?

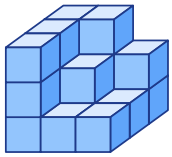

Volume by Counting Cubes · 21

How many cubes are in the tallest stack of this solid?

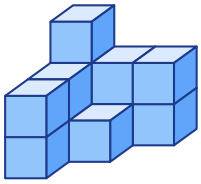

Volume by Counting Cubes · 22

Count the cubes in both solids. What is their volume together, in cubic units?

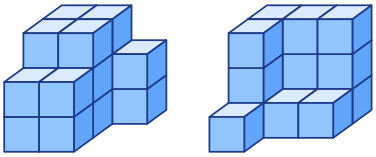

Volume by Counting Cubes · 23

How many more cubes are needed to fill this solid in, so it becomes a full box 3 cubes long, 3 cubes wide and 3 cubes tall?

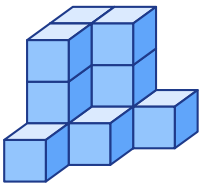

Volume by Counting Cubes · 24

One more cube is put on top of every stack of this solid. What is the volume now, in cubic units?

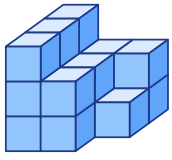

Volume by Counting Cubes · 18

ANSWER

12

Volume by Counting Cubes · 17

ANSWER

12

Volume by Counting Cubes · 20

ANSWER

9

Volume by Counting Cubes · 19

ANSWER

16

Volume by Counting Cubes · 22

ANSWER

33

Volume by Counting Cubes · 21

ANSWER

3

Volume by Counting Cubes · 24

ANSWER

26

Volume by Counting Cubes · 23

ANSWER

15