Task card 1 Valentine's Day Math

One batch of a recipe uses $\frac{3}{4}$ cup of pink frosting. Mia makes 4 batches. How many cups of pink frosting does Mia use?

Task card 2 Valentine's Day Math

One pack of valentine cards costs $4.65. Ben buys 9 packs of valentine cards. How much does Ben spend?

Task card 3 Valentine's Day Math

One box of chocolates costs $6.60. Mia buys 6 boxes of chocolates. How much does Mia spend?

Task card 4 Valentine's Day Math

Ella buys a box of chocolates for $10.77 and pays with a $20 bill. How much change does Ella get?

Task card 5 Valentine's Day Math

Ella buys a pack of valentine cards for $2.54 and pays with a $10 bill. How much change does Ella get?

Task card 6 Valentine's Day Math

A chocolate box is 4 inches long, 7 inches wide and 3 inches tall. What is its volume in cubic inches?

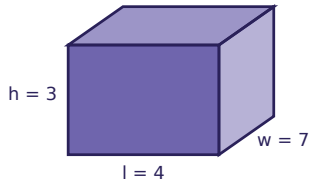

Task card 7 Valentine's Day Math

A chocolate box is 5 inches long, 6 inches wide and 8 inches tall. What is its volume in cubic inches?

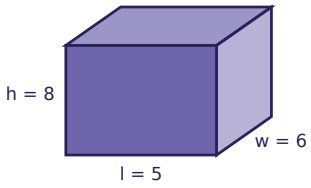

Task card 8 Valentine's Day Math

One batch of a recipe uses $\frac{3}{8}$ cup of pink frosting. Ava makes 2 batches. How many cups of pink frosting does Ava use?

Task card 9 Valentine's Day Math

One box of chocolates costs $8.40. Ella buys 6 boxes of chocolates. How much does Ella spend?

Task card 10 Valentine's Day Math

A chocolate box is 14 inches long, 10 inches wide and 3 inches tall. What is its volume in cubic inches?

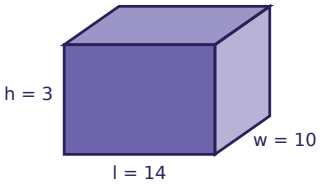

Task card 11 Valentine's Day Math

One batch of a recipe uses $\frac{5}{6}$ cup of pink frosting. Ella makes 3 batches. How many cups of pink frosting does Ella use?

Task card 12 Valentine's Day Math

Ella buys a box of chocolates for $8.88 and pays with a $10 bill. How much change does Ella get?

Task card 13 Valentine's Day Math

Noah buys a box of chocolates for $4.49 and pays with a $10 bill. How much change does Noah get?

Task card 14 Valentine's Day Math

One pack of valentine cards costs $4.00. Ava buys 3 packs of valentine cards. How much does Ava spend?

Task card 15 Valentine's Day Math

A chocolate box is 11 inches long, 6 inches wide and 6 inches tall. What is its volume in cubic inches?

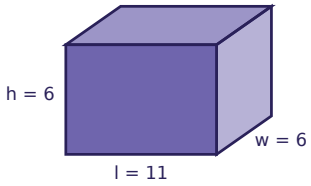

Task card 16 Valentine's Day Math

One batch of a recipe uses $\frac{5}{8}$ cup of pink frosting. Lily makes 4 batches. How many cups of pink frosting does Lily use?

Task card 17 Valentine's Day Math

One pack of valentine cards costs $4.25. Zoe buys 9 packs of valentine cards. How much does Zoe spend?

Task card 18 Valentine's Day Math

A chocolate box is 11 inches long, 6 inches wide and 4 inches tall. What is its volume in cubic inches?

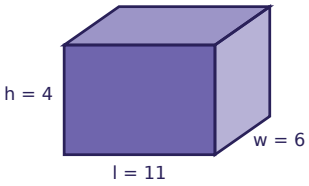

Task card 19 Valentine's Day Math

One pack of valentine cards costs $4.10. Ava buys 2 packs of valentine cards. How much does Ava spend?

Task card 20 Valentine's Day Math

Sam buys a bunch of roses for $8.35 and pays with a $10 bill. How much change does Sam get?

Task card 21 Valentine's Day Math

One batch of a recipe uses $\frac{5}{6}$ cup of pink frosting. Ava makes 5 batches. How many cups of pink frosting does Ava use?

Task card 22 Valentine's Day Math

One batch of a recipe uses $\frac{5}{8}$ cup of pink frosting. Ella makes 2 batches. How many cups of pink frosting does Ella use?

Task card 23 Valentine's Day Math

A chocolate box is 5 inches long, 4 inches wide and 8 inches tall. What is its volume in cubic inches?

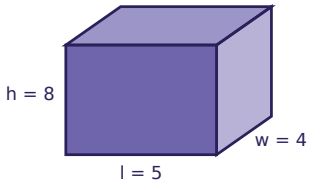

Task card 24 Valentine's Day Math

Ella buys a box of chocolates for $9.89 and pays with a $10 bill. How much change does Ella get?

Valentine's Day Math Task Cards

Recording sheet · Grade 5 · Read each story and solve. Write money like $4.50 and fractions like 1 1/2.

Name: _____ Date: _____

Scan to check your answers

1	2	3	4
5	6	7	8
9	10	11	12
13	14	15	16
17	18	19	20
21	22	23	24

Valentine's Day Math Task Cards: Answer Key

Grade 5 · Hard

The answers online

1. 3	**2.** $41.85	**3.** $39.60
4. $9.23	**5.** $7.46	**6.** 84
7. 240	**8.** $\frac{3}{4}$	**9.** $50.40
10. 420	**11.** $2\frac{1}{2}$	**12.** $1.12
13. $5.51	**14.** $12.00	**15.** 396
16. $2\frac{1}{2}$	**17.** $38.25	**18.** 264
19. $8.20	**20.** $1.65	**21.** $4\frac{1}{6}$
22. $1\frac{1}{4}$	**23.** 160	**24.** $0.11