Task card 1 Valentine's Day Math

A chocolate box is 7 inches long, 5 inches wide and 4 inches tall. What is its volume in cubic inches?

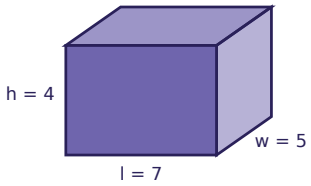

Task card 2 Valentine's Day Math

One box of chocolates costs $7.40. Leo buys 3 boxes of chocolates. How much does Leo spend?

Task card 3 Valentine's Day Math

A chocolate box is 6 inches long, 7 inches wide and 3 inches tall. What is its volume in cubic inches?

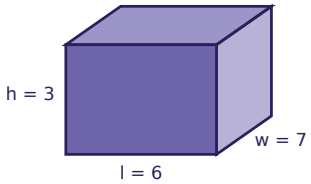

Task card 4 Valentine's Day Math

One batch of a recipe uses $\frac{1}{3}$ cup of pink frosting. Zoe makes 4 batches. How many cups of pink frosting does Zoe use?

Task card 5 Valentine's Day Math

One batch of a recipe uses $\frac{3}{4}$ cup of pink frosting. Mia makes 3 batches. How many cups of pink frosting does Mia use?

Task card 6 Valentine's Day Math

Mia buys a bunch of roses for $14.80 and pays with a $20 bill. How much change does Mia get?

Task card 7 Valentine's Day Math

Ben buys a pack of valentine cards for $2.50 and pays with a $10 bill. How much change does Ben get?

Task card 8 Valentine's Day Math

One box of chocolates costs $6.25. Sam buys 2 boxes of chocolates. How much does Sam spend?

Task card 9 Valentine's Day Math

One batch of a recipe uses $\frac{5}{6}$ cup of pink frosting. Ava makes 2 batches. How many cups of pink frosting does Ava use?

Task card 10 Valentine's Day Math

A chocolate box is 9 inches long, 5 inches wide and 3 inches tall. What is its volume in cubic inches?

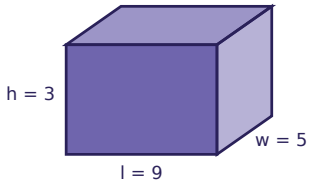

Task card 11 Valentine's Day Math

Omar buys a box of chocolates for $12.02 and pays with a $20 bill. How much change does Omar get?

Task card 12 Valentine's Day Math

One bunch of roses costs $11.95. Ben buys 5 bunches of roses. How much does Ben spend?

Task card 13 Valentine's Day Math

One box of chocolates costs $6.50. Ben buys 4 boxes of chocolates. How much does Ben spend?

Task card 14 Valentine's Day Math

One batch of a recipe uses $\frac{2}{3}$ cup of pink frosting. Ava makes 3 batches. How many cups of pink frosting does Ava use?

Task card 15 Valentine's Day Math

Ben buys a pack of valentine cards for $4.93 and pays with a $10 bill. How much change does Ben get?

Task card 16 Valentine's Day Math

A chocolate box is 7 inches long, 8 inches wide and 3 inches tall. What is its volume in cubic inches?

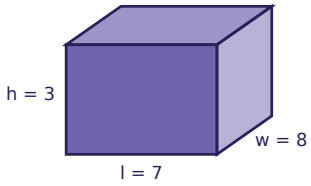

Task card 17 Valentine's Day Math

Zoe buys a box of chocolates for $9.35 and pays with a $10 bill. How much change does Zoe get?

Task card 18 Valentine's Day Math

One box of chocolates costs $9.60. Ella buys 5 boxes of chocolates. How much does Ella spend?

Task card 19 Valentine's Day Math

One batch of a recipe uses $\frac{2}{3}$ cup of pink frosting. Ava makes 4 batches. How many cups of pink frosting does Ava use?

Task card 20 Valentine's Day Math

Ava buys a bunch of roses for $6.36 and pays with a $10 bill. How much change does Ava get?

Task card 21 Valentine's Day Math

A chocolate box is 4 inches long, 8 inches wide and 7 inches tall. What is its volume in cubic inches?

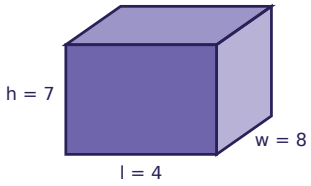

Task card 22 Valentine's Day Math

A chocolate box is 8 inches long, 3 inches wide and 4 inches tall. What is its volume in cubic inches?

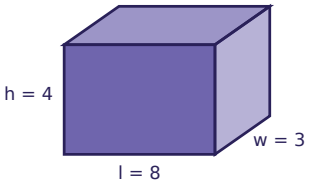

Task card 23 Valentine's Day Math

One batch of a recipe uses $\frac{5}{6}$ cup of pink frosting. Ava makes 3 batches. How many cups of pink frosting does Ava use?

Task card 24 Valentine's Day Math

One box of chocolates costs $10.10. Ava buys 9 boxes of chocolates. How much does Ava spend?

Valentine's Day Math Task Cards

Recording sheet · Grade 5 · Read each story and solve. Write money like $4.50 and fractions like 1 1/2.

Name: _____ Date: _____

Scan to check your answers

1	2	3	4
5	6	7	8
9	10	11	12
13	14	15	16
17	18	19	20
21	22	23	24

Valentine's Day Math Task Cards: Answer Key

Grade 5 · Medium

The answers online

1. 140	**2.** $22.20	**3.** 126
4. $1\frac{1}{3}$	**5.** $2\frac{1}{4}$	**6.** $5.20
7. $7.50	**8.** $12.50	**9.** $1\frac{2}{3}$
10. 135	**11.** $7.98	**12.** $59.75
13. $26.00	**14.** 2	**15.** $5.07
16. 168	**17.** $0.65	**18.** $48.00
19. $2\frac{2}{3}$	**20.** $3.64	**21.** 224
22. 96	**23.** $2\frac{1}{2}$	**24.** $90.90