Task card 1 Valentine's Day Math

One batch of a recipe uses $\frac{3}{4}$ cup of pink frosting. Omar makes 3 batches. How many cups of pink frosting does Omar use?

Task card 2 Valentine's Day Math

A chocolate box is 4 inches long, 3 inches wide and 2 inches tall. What is its volume in cubic inches?

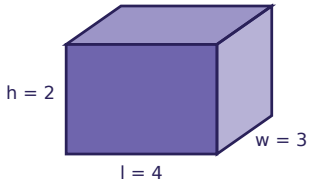

Task card 3 Valentine's Day Math

One batch of a recipe uses $\frac{1}{3}$ cup of pink frosting. Ben makes 2 batches. How many cups of pink frosting does Ben use?

Task card 4 Valentine's Day Math

One pack of valentine cards costs $4.25. Sam buys 2 packs of valentine cards. How much does Sam spend?

Task card 5 Valentine's Day Math

Noah buys a box of chocolates for $8.85 and pays with a $10 bill. How much change does Noah get?

Task card 6 Valentine's Day Math

A chocolate box is 5 inches long, 4 inches wide and 2 inches tall. What is its volume in cubic inches?

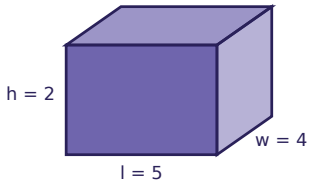

Task card 7 Valentine's Day Math

One pack of valentine cards costs $2.70. Ben buys 4 packs of valentine cards. How much does Ben spend?

Task card 8 Valentine's Day Math

Mia buys a box of chocolates for $6.50 and pays with a $10 bill. How much change does Mia get?

Task card 9 Valentine's Day Math

One box of chocolates costs $5.10. Leo buys 4 boxes of chocolates. How much does Leo spend?

Task card 10 Valentine's Day Math

A chocolate box is 8 inches long, 6 inches wide and 4 inches tall. What is its volume in cubic inches?

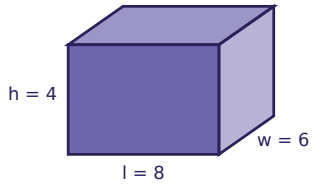

Task card 11 Valentine's Day Math

Zoe buys a pack of valentine cards for $3.45 and pays with a $10 bill. How much change does Zoe get?

Task card 12 Valentine's Day Math

One pack of valentine cards costs $3.15. Zoe buys 5 packs of valentine cards. How much does Zoe spend?

Task card 13 Valentine's Day Math

Ben buys a bunch of roses for $6.70 and pays with a $10 bill. How much change does Ben get?

Task card 14 Valentine's Day Math

One batch of a recipe uses $\frac{1}{2}$ cup of pink frosting. Leo makes 2 batches. How many cups of pink frosting does Leo use?

Task card 15 Valentine's Day Math

One batch of a recipe uses $\frac{1}{3}$ cup of pink frosting. Ella makes 3 batches. How many cups of pink frosting does Ella use?

Task card 16 Valentine's Day Math

Noah buys a box of chocolates for $9.35 and pays with a $10 bill. How much change does Noah get?

Task card 17 Valentine's Day Math

One batch of a recipe uses $\frac{1}{3}$ cup of pink frosting. Zoe makes 2 batches. How many cups of pink frosting does Zoe use?

Task card 18 Valentine's Day Math

One pack of valentine cards costs $3.15. Zoe buys 3 packs of valentine cards. How much does Zoe spend?

Task card 19 Valentine's Day Math

A chocolate box is 8 inches long, 3 inches wide and 2 inches tall. What is its volume in cubic inches?

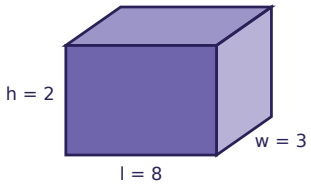

Task card 20 Valentine's Day Math

A chocolate box is 9 inches long, 5 inches wide and 6 inches tall. What is its volume in cubic inches?

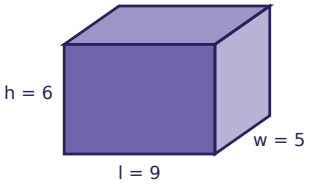

Task card 21 Valentine's Day Math

Zoe buys a box of chocolates for $4.95 and pays with a $10 bill. How much change does Zoe get?

Task card 22 Valentine's Day Math

One pack of valentine cards costs $2.75. Lily buys 5 packs of valentine cards. How much does Lily spend?

Task card 23 Valentine's Day Math

Mia buys a bunch of roses for $8.90 and pays with a $10 bill. How much change does Mia get?

Task card 24 Valentine's Day Math

Ben buys a box of chocolates for $4.80 and pays with a $10 bill. How much change does Ben get?

Valentine's Day Math Task Cards

Recording sheet · Grade 5 · Read each story and solve. Write money like $4.50 and fractions like 1 1/2.

Name: _____ Date: _____

Scan to check your answers

1	2	3	4
5	6	7	8
9	10	11	12
13	14	15	16
17	18	19	20
21	22	23	24

Valentine's Day Math Task Cards: Answer Key

Grade 5 · Easy

The answers online

1. $2\frac{1}{4}$	**2.** 24	**3.** $\frac{2}{3}$
4. $8.50	**5.** $1.15	**6.** 40
7. $10.80	**8.** $3.50	**9.** $20.40
10. 192	**11.** $6.55	**12.** $15.75
13. $3.30	**14.** 1	**15.** 1
16. $0.65	**17.** $\frac{2}{3}$	**18.** $9.45
19. 48	**20.** 270	**21.** $5.05
22. $13.75	**23.** $1.10	**24.** $5.20