Valentine's Day Math · 1

One batch of a recipe uses $\frac{3}{4}$ cup of pink frosting. Mia makes 4 batches. How many cups of pink frosting does Mia use?

Valentine's Day Math · 2

One pack of valentine cards costs $4.65. Ben buys 9 packs of valentine cards. How much does Ben spend?

Valentine's Day Math · 3

One box of chocolates costs $6.60. Mia buys 6 boxes of chocolates. How much does Mia spend?

Valentine's Day Math · 4

Ella buys a box of chocolates for $10.77 and pays with a $20 bill. How much change does Ella get?

Valentine's Day Math · 5

Ella buys a pack of valentine cards for $2.54 and pays with a $10 bill. How much change does Ella get?

Valentine's Day Math · 6

A chocolate box is 4 inches long, 7 inches wide and 3 inches tall. What is its volume in cubic inches?

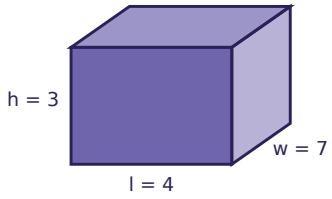

Valentine's Day Math · 7

A chocolate box is 5 inches long, 6 inches wide and 8 inches tall. What is its volume in cubic inches?

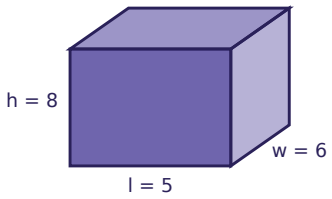

Valentine's Day Math · 8

One batch of a recipe uses $\frac{3}{8}$ cup of pink frosting. Ava makes 2 batches. How many cups of pink frosting does Ava use?

Valentine's Day Math · 2

ANSWER

$41.85

Valentine's Day Math · 1

ANSWER

3

Valentine's Day Math · 4

ANSWER

$9.23

Valentine's Day Math · 3

ANSWER

$39.60

Valentine's Day Math · 6

ANSWER

84

Valentine's Day Math · 5

ANSWER

$7.46

Valentine's Day Math · 8

ANSWER

$$\frac{3}{4}$$

Valentine's Day Math · 7

ANSWER

240

Valentine's Day Math · 9

One box of chocolates costs $8.40. Ella buys 6 boxes of chocolates. How much does Ella spend?

Valentine's Day Math · 10

A chocolate box is 14 inches long, 10 inches wide and 3 inches tall. What is its volume in cubic inches?

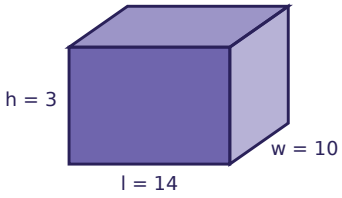

Valentine's Day Math · 11

One batch of a recipe uses $\frac{5}{6}$ cup of pink frosting. Ella makes 3 batches. How many cups of pink frosting does Ella use?

Valentine's Day Math · 12

Ella buys a box of chocolates for $8.88 and pays with a $10 bill. How much change does Ella get?

Valentine's Day Math · 13

Noah buys a box of chocolates for $4.49 and pays with a $10 bill. How much change does Noah get?

Valentine's Day Math · 14

One pack of valentine cards costs $4.00. Ava buys 3 packs of valentine cards. How much does Ava spend?

Valentine's Day Math · 15

A chocolate box is 11 inches long, 6 inches wide and 6 inches tall. What is its volume in cubic inches?

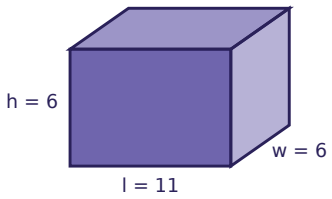

Valentine's Day Math · 16

One batch of a recipe uses $\frac{5}{8}$ cup of pink frosting. Lily makes 4 batches. How many cups of pink frosting does Lily use?

Valentine's Day Math · 10

ANSWER

420

Valentine's Day Math · 9

ANSWER

$50.40

Valentine's Day Math · 12

ANSWER

$1.12

Valentine's Day Math · 11

ANSWER

$$2\frac{1}{2}$$

Valentine's Day Math · 14

ANSWER

$12.00

Valentine's Day Math · 13

ANSWER

$5.51

Valentine's Day Math · 16

ANSWER

$$2\frac{1}{2}$$

Valentine's Day Math · 15

ANSWER

396

Valentine's Day Math · 17

One pack of valentine cards costs $4.25. Zoe buys 9 packs of valentine cards. How much does Zoe spend?

Valentine's Day Math · 18

A chocolate box is 11 inches long, 6 inches wide and 4 inches tall. What is its volume in cubic inches?

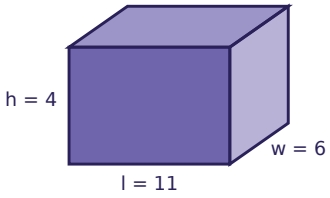

Valentine's Day Math · 19

One pack of valentine cards costs $4.10. Ava buys 2 packs of valentine cards. How much does Ava spend?

Valentine's Day Math · 20

Sam buys a bunch of roses for $8.35 and pays with a $10 bill. How much change does Sam get?

Valentine's Day Math · 21

One batch of a recipe uses $\frac{5}{6}$ cup of pink frosting. Ava makes 5 batches. How many cups of pink frosting does Ava use?

Valentine's Day Math · 22

One batch of a recipe uses $\frac{5}{8}$ cup of pink frosting. Ella makes 2 batches. How many cups of pink frosting does Ella use?

Valentine's Day Math · 23

A chocolate box is 5 inches long, 4 inches wide and 8 inches tall. What is its volume in cubic inches?

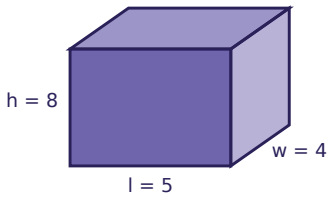

Valentine's Day Math · 24

Ella buys a box of chocolates for $9.89 and pays with a $10 bill. How much change does Ella get?

Valentine's Day Math · 18

ANSWER

264

Valentine's Day Math · 17

ANSWER

$38.25

Valentine's Day Math · 20

ANSWER

$1.65

Valentine's Day Math · 19

ANSWER

$8.20

Valentine's Day Math · 22

ANSWER

$$1\frac{1}{4}$$

Valentine's Day Math · 21

ANSWER

$$4\frac{1}{6}$$

Valentine's Day Math · 24

ANSWER

$0.11

Valentine's Day Math · 23

ANSWER

160