Valentine's Day Math · 1

One batch of a recipe uses $\frac{3}{4}$ cup of pink frosting. Omar makes 3 batches. How many cups of pink frosting does Omar use?

Valentine's Day Math · 2

A chocolate box is 4 inches long, 3 inches wide and 2 inches tall. What is its volume in cubic inches?

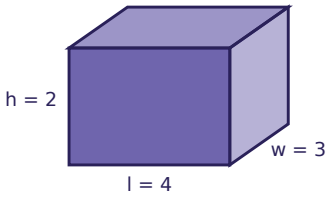

Valentine's Day Math · 3

One batch of a recipe uses $\frac{1}{3}$ cup of pink frosting. Ben makes 2 batches. How many cups of pink frosting does Ben use?

Valentine's Day Math · 4

One pack of valentine cards costs $4.25. Sam buys 2 packs of valentine cards. How much does Sam spend?

Valentine's Day Math · 5

Noah buys a box of chocolates for $8.85 and pays with a $10 bill. How much change does Noah get?

Valentine's Day Math · 6

A chocolate box is 5 inches long, 4 inches wide and 2 inches tall. What is its volume in cubic inches?

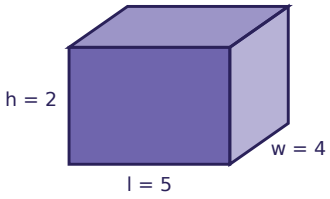

Valentine's Day Math · 7

One pack of valentine cards costs $2.70. Ben buys 4 packs of valentine cards. How much does Ben spend?

Valentine's Day Math · 8

Mia buys a box of chocolates for $6.50 and pays with a $10 bill. How much change does Mia get?

Valentine's Day Math · 2

ANSWER

24

Valentine's Day Math · 1

ANSWER

$2\frac{1}{4}$

Valentine's Day Math · 4

ANSWER

$8.50

Valentine's Day Math · 3

ANSWER

$\frac{2}{3}$

Valentine's Day Math · 6

ANSWER

40

Valentine's Day Math · 5

ANSWER

$1.15

Valentine's Day Math · 8

ANSWER

$3.50

Valentine's Day Math · 7

ANSWER

$10.80

Valentine's Day Math · 9

One box of chocolates costs $5.10. Leo buys 4 boxes of chocolates. How much does Leo spend?

Valentine's Day Math · 10

A chocolate box is 8 inches long, 6 inches wide and 4 inches tall. What is its volume in cubic inches?

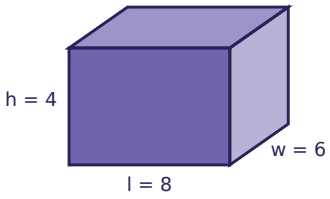

Valentine's Day Math · 11

Zoe buys a pack of valentine cards for $3.45 and pays with a $10 bill. How much change does Zoe get?

Valentine's Day Math · 12

One pack of valentine cards costs $3.15. Zoe buys 5 packs of valentine cards. How much does Zoe spend?

Valentine's Day Math · 13

Ben buys a bunch of roses for $6.70 and pays with a $10 bill. How much change does Ben get?

Valentine's Day Math · 14

One batch of a recipe uses $\frac{1}{2}$ cup of pink frosting. Leo makes 2 batches. How many cups of pink frosting does Leo use?

Valentine's Day Math · 15

One batch of a recipe uses $\frac{1}{3}$ cup of pink frosting. Ella makes 3 batches. How many cups of pink frosting does Ella use?

Valentine's Day Math · 16

Noah buys a box of chocolates for $9.35 and pays with a $10 bill. How much change does Noah get?

Valentine's Day Math · 10

ANSWER

192

Valentine's Day Math · 9

ANSWER

$20.40

Valentine's Day Math · 12

ANSWER

$15.75

Valentine's Day Math · 11

ANSWER

$6.55

Valentine's Day Math · 14

ANSWER

1

Valentine's Day Math · 13

ANSWER

$3.30

Valentine's Day Math · 16

ANSWER

$0.65

Valentine's Day Math · 15

ANSWER

1

Valentine's Day Math · 17

One batch of a recipe uses $\frac{1}{3}$ cup of pink frosting. Zoe makes 2 batches. How many cups of pink frosting does Zoe use?

Valentine's Day Math · 18

One pack of valentine cards costs $3.15. Zoe buys 3 packs of valentine cards. How much does Zoe spend?

Valentine's Day Math · 19

A chocolate box is 8 inches long, 3 inches wide and 2 inches tall. What is its volume in cubic inches?

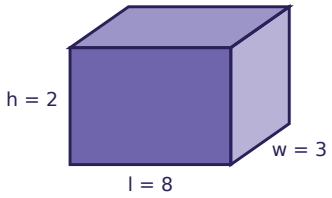

Valentine's Day Math · 20

A chocolate box is 9 inches long, 5 inches wide and 6 inches tall. What is its volume in cubic inches?

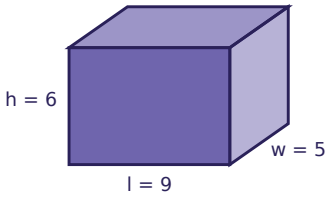

Valentine's Day Math · 21

Zoe buys a box of chocolates for $4.95 and pays with a $10 bill. How much change does Zoe get?

Valentine's Day Math · 22

One pack of valentine cards costs $2.75. Lily buys 5 packs of valentine cards. How much does Lily spend?

Valentine's Day Math · 23

Mia buys a bunch of roses for $8.90 and pays with a $10 bill. How much change does Mia get?

Valentine's Day Math · 24

Ben buys a box of chocolates for $4.80 and pays with a $10 bill. How much change does Ben get?

Valentine's Day Math · 18

ANSWER

$9.45

Valentine's Day Math · 17

ANSWER

$$\frac{2}{3}$$

Valentine's Day Math · 20

ANSWER

270

Valentine's Day Math · 19

ANSWER

48

Valentine's Day Math · 22

ANSWER

$13.75

Valentine's Day Math · 21

ANSWER

$5.05

Valentine's Day Math · 24

ANSWER

$5.20

Valentine's Day Math · 23

ANSWER

$1.10