Classify an angle of 263°: acute, right, obtuse, straight, reflex, or full turn?

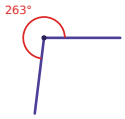

Careful! Classify an angle of exactly 180°: acute, right, obtuse, straight, reflex, or full turn?

Which of these angles is a full turn: 5°, 180°, 359°, 360°?

An angle measures 168°. What is the reflex angle on the other side of its arms, in degrees?

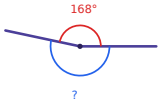

Three angles meet at a point and make a full turn. Two of them are 113° and 108°. How many degrees is the third angle?

Two angles meet at a point and make a full turn. One is 283°. What type is the other angle: acute, right, obtuse, straight, reflex, or full turn?

An angle of 147° is doubled. What type is the new angle: acute, right, obtuse, straight, reflex, or full turn?

Two angles meet at a point and make a full turn. One is 270°. What type is the other angle: acute, right, obtuse, straight, reflex, or full turn?

ANSWER

straight

ANSWER

reflex

ANSWER

192

ANSWER

360

ANSWER

acute

ANSWER

139

ANSWER

right

ANSWER

reflex

Classify an angle of 256°: acute, right, obtuse, straight, reflex, or full turn?

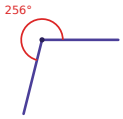

Careful! Classify an angle of exactly 179°: acute, right, obtuse, straight, reflex, or full turn?

Which of these angles is an obtuse angle: 88°, 179°, 180°, 360°?

A reflex angle measures 218°. What is the smaller angle on the other side of its arms, in degrees?

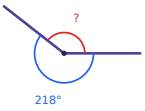

Three angles meet at a point and make a full turn. Two of them are 90° and 87°. How many degrees is the third angle?

Two angles meet at a point and make a full turn. One is 90°. What type is the other angle: acute, right, obtuse, straight, reflex, or full turn?

An angle of 180° is doubled. What type is the new angle: acute, right, obtuse, straight, reflex, or full turn?

Two angles meet at a point and make a full turn. One is 188°. What type is the other angle: acute, right, obtuse, straight, reflex, or full turn?

ANSWER

obtuse

ANSWER

reflex

ANSWER

142

ANSWER

179

ANSWER

reflex

ANSWER

183

ANSWER

obtuse

ANSWER

full turn

Classify an angle of 180°: acute, right, obtuse, straight, reflex, or full turn?



Which of these angles is a straight angle: 88°, 170°, 180°, 360°?

A reflex angle measures 198°. What is the smaller angle on the other side of its arms, in degrees?

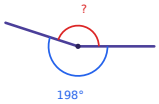

Three angles meet at a point and make a full turn. Two of them are 87° and 88°. How many degrees is the third angle?

Two angles make a straight angle. One is 90°. What type is the other angle: acute, right, obtuse, straight, reflex, or full turn?

Classify an angle of 90°: acute, right, obtuse, straight, reflex, or full turn?

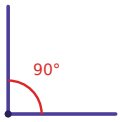

Which of these angles is a full turn: 111°, 180°, 298°, 360°?

A reflex angle measures 248°. What is the smaller angle on the other side of its arms, in degrees?

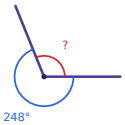

ANSWER

180

ANSWER

straight

ANSWER

185

ANSWER

162

ANSWER

right

ANSWER

right

ANSWER

112

ANSWER

360