Task card 1 Thanksgiving Math

One batch of a recipe uses $\frac{3}{8}$ cup of pumpkin puree. Zoe makes 3 batches. How many cups of pumpkin puree does Zoe use?

Task card 2 Thanksgiving Math

Mia buys a jar of cranberry sauce for $3.81 and pays with a $10 bill. How much change does Mia get?

Task card 3 Thanksgiving Math

A pie box is 10 inches long, 7 inches wide and 4 inches tall. What is its volume in cubic inches?

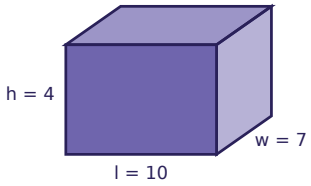

Task card 4 Thanksgiving Math

Zoe buys a jar of cranberry sauce for $3.76 and pays with a $10 bill. How much change does Zoe get?

Task card 5 Thanksgiving Math

One bag of rolls costs $2.80. Omar buys 7 bags of rolls. How much does Omar spend?

Task card 6 Thanksgiving Math

A pie box is 11 inches long, 9 inches wide and 5 inches tall. What is its volume in cubic inches?

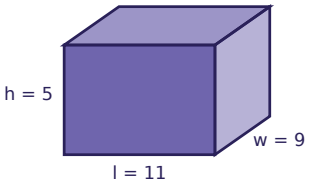

Task card 7 Thanksgiving Math

One batch of a recipe uses $\frac{5}{6}$ cup of pumpkin puree. Omar makes 2 batches. How many cups of pumpkin puree does Omar use?

Task card 8 Thanksgiving Math

One jar of cranberry sauce costs $2.65. Ben buys 5 jars of cranberry sauce. How much does Ben spend?

Task card 9 Thanksgiving Math

Noah buys a jar of cranberry sauce for $2.76 and pays with a $10 bill. How much change does Noah get?

Task card 10 Thanksgiving Math

One jar of cranberry sauce costs $1.55. Ava buys 2 jars of cranberry sauce. How much does Ava spend?

Task card 11 Thanksgiving Math

One batch of a recipe uses $\frac{3}{8}$ cup of pumpkin puree. Noah makes 5 batches. How many cups of pumpkin puree does Noah use?

Task card 12 Thanksgiving Math

A pie box is 14 inches long, 6 inches wide and 3 inches tall. What is its volume in cubic inches?

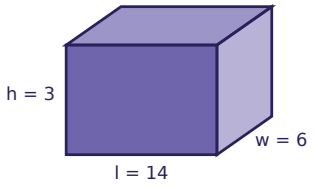

Task card 13 Thanksgiving Math

A pie box is 13 inches long, 9 inches wide and 8 inches tall. What is its volume in cubic inches?

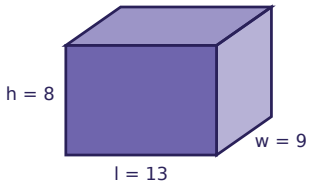

Task card 14 Thanksgiving Math

Leo buys a bag of rolls for $3.80 and pays with a $10 bill. How much change does Leo get?

Task card 15 Thanksgiving Math

One jar of cranberry sauce costs $1.45. Zoe buys 7 jars of cranberry sauce. How much does Zoe spend?

Task card 16 Thanksgiving Math

One batch of a recipe uses $\frac{5}{8}$ cup of pumpkin puree. Sam makes 4 batches. How many cups of pumpkin puree does Sam use?

Task card 17 Thanksgiving Math

A pie box is 10 inches long, 6 inches wide and 7 inches tall. What is its volume in cubic inches?

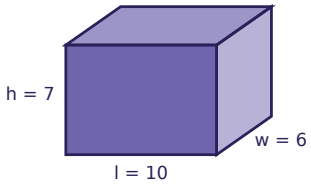

Task card 18 Thanksgiving Math

One batch of a recipe uses $\frac{3}{8}$ cup of pumpkin puree. Ella makes 6 batches. How many cups of pumpkin puree does Ella use?

Task card 19 Thanksgiving Math

One bag of rolls costs $2.55. Noah buys 6 bags of rolls. How much does Noah spend?

Task card 20 Thanksgiving Math

Noah buys a pumpkin pie for $6.87 and pays with a $10 bill. How much change does Noah get?

Task card 21 Thanksgiving Math

Noah buys a bag of rolls for $2.91 and pays with a $10 bill. How much change does Noah get?

Task card 22 Thanksgiving Math

A pie box is 5 inches long, 3 inches wide and 7 inches tall. What is its volume in cubic inches?

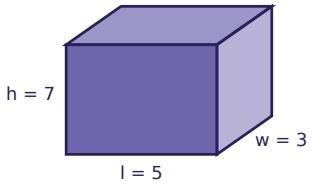

Task card 23 Thanksgiving Math

One bag of rolls costs $4.30. Ava buys 2 bags of rolls. How much does Ava spend?

Task card 24 Thanksgiving Math

One batch of a recipe uses $\frac{5}{8}$ cup of pumpkin puree. Omar makes 7 batches. How many cups of pumpkin puree does Omar use?

Thanksgiving Math Task Cards

Recording sheet · Grade 5 · Read each story and solve. Write money like $4.50 and fractions like 1 1/2.

Name: _____ Date: _____

Scan to check your answers

1	2	3	4
5	6	7	8
9	10	11	12
13	14	15	16
17	18	19	20
21	22	23	24

Thanksgiving Math Task Cards: Answer Key

Grade 5 · Hard

The answers online

1. $1\frac{1}{8}$	**2.** $6.19	**3.** 280
4. $6.24	**5.** $19.60	**6.** 495
7. $1\frac{2}{3}$	**8.** $13.25	**9.** $7.24
10. $3.10	**11.** $1\frac{7}{8}$	**12.** 252
13. 936	**14.** $6.20	**15.** $10.15
16. $2\frac{1}{2}$	**17.** 420	**18.** $2\frac{1}{4}$
19. $15.30	**20.** $3.13	**21.** $7.09
22. 105	**23.** $8.60	**24.** $4\frac{3}{8}$