Task card 1 Thanksgiving Math

A pie box is 6 inches long, 4 inches wide and 3 inches tall. What is its volume in cubic inches?

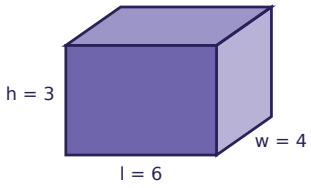

Task card 2 Thanksgiving Math

One batch of a recipe uses $\frac{1}{4}$ cup of pumpkin puree. Sam makes 2 batches. How many cups of pumpkin puree does Sam use?

Task card 3 Thanksgiving Math

Ella buys a bag of rolls for $2.50 and pays with a $10 bill. How much change does Ella get?

Task card 4 Thanksgiving Math

One pumpkin pie costs $5.10. Omar buys 4 pumpkin pies. How much does Omar spend?

Task card 5 Thanksgiving Math

One bag of rolls costs $4.90. Leo buys 4 bags of rolls. How much does Leo spend?

Task card 6 Thanksgiving Math

A pie box is 4 inches long, 5 inches wide and 3 inches tall. What is its volume in cubic inches?

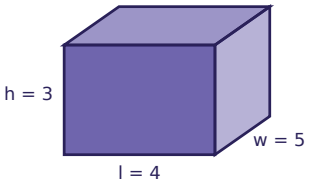

Task card 7 Thanksgiving Math

One batch of a recipe uses $\frac{1}{4}$ cup of pumpkin puree. Ella makes 3 batches. How many cups of pumpkin puree does Ella use?

Task card 8 Thanksgiving Math

Ella buys a pumpkin pie for $5.85 and pays with a $10 bill. How much change does Ella get?

Task card 9 Thanksgiving Math

One bag of rolls costs $4.10. Sam buys 3 bags of rolls. How much does Sam spend?

Task card 10 Thanksgiving Math

One jar of cranberry sauce costs $3.65. Ben buys 4 jars of cranberry sauce. How much does Ben spend?

Task card 11 Thanksgiving Math

A pie box is 4 inches long, 5 inches wide and 5 inches tall. What is its volume in cubic inches?

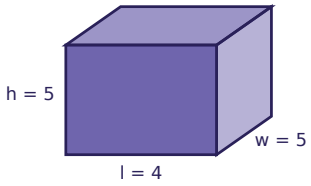

Task card 12 Thanksgiving Math

Ella buys a jar of cranberry sauce for $1.90 and pays with a $10 bill. How much change does Ella get?

Task card 13 Thanksgiving Math

One batch of a recipe uses $\frac{1}{2}$ cup of pumpkin puree. Sam makes 2 batches. How many cups of pumpkin puree does Sam use?

Task card 14 Thanksgiving Math

One batch of a recipe uses $\frac{3}{4}$ cup of pumpkin puree. Ava makes 3 batches. How many cups of pumpkin puree does Ava use?

Task card 15 Thanksgiving Math

A pie box is 4 inches long, 6 inches wide and 5 inches tall. What is its volume in cubic inches?

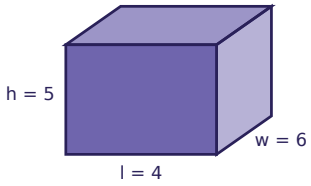

Task card 16 Thanksgiving Math

Ben buys a jar of cranberry sauce for $1.15 and pays with a $10 bill. How much change does Ben get?

Task card 17 Thanksgiving Math

Ben buys a pumpkin pie for $7.10 and pays with a $10 bill. How much change does Ben get?

Task card 18 Thanksgiving Math

One jar of cranberry sauce costs $1.60. Ella buys 2 jars of cranberry sauce. How much does Ella spend?

Task card 19 Thanksgiving Math

One batch of a recipe uses $\frac{1}{4}$ cup of pumpkin puree. Zoe makes 3 batches. How many cups of pumpkin puree does Zoe use?

Task card 20 Thanksgiving Math

One pumpkin pie costs $5.70. Lily buys 6 pumpkin pies. How much does Lily spend?

Task card 21 Thanksgiving Math

One batch of a recipe uses $\frac{1}{3}$ cup of pumpkin puree. Ella makes 4 batches. How many cups of pumpkin puree does Ella use?

Task card 22 Thanksgiving Math

A pie box is 6 inches long, 3 inches wide and 5 inches tall. What is its volume in cubic inches?

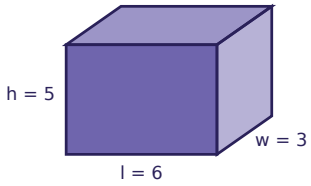

Task card 23 Thanksgiving Math

A pie box is 4 inches long, 6 inches wide and 2 inches tall. What is its volume in cubic inches?

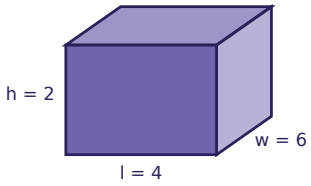

Task card 24 Thanksgiving Math

Lily buys a bag of rolls for $3.20 and pays with a $10 bill. How much change does Lily get?

Thanksgiving Math Task Cards

Recording sheet · Grade 5 · Read each story and solve. Write money like $4.50 and fractions like 1 1/2.

Name: _____ Date: _____

Scan to check your answers

1	2	3	4
5	6	7	8
9	10	11	12
13	14	15	16
17	18	19	20
21	22	23	24

Thanksgiving Math Task Cards: Answer Key

Grade 5 · Easy

The answers online

1. 72	**2.** $\frac{1}{2}$	**3.** $7.50
4. $20.40	**5.** $19.60	**6.** 60
7. $\frac{3}{4}$	**8.** $4.15	**9.** $12.30
10. $14.60	**11.** 100	**12.** $8.10
13. 1	**14.** $2\frac{1}{4}$	**15.** 120
16. $8.85	**17.** $2.90	**18.** $3.20
19. $\frac{3}{4}$	**20.** $34.20	**21.** $1\frac{1}{3}$
22. 90	**23.** 48	**24.** $6.80