Thanksgiving Math · 1

One batch of a recipe uses $\frac{3}{4}$ cup of pumpkin puree. Noah makes 5 batches. How many cups of pumpkin puree does Noah use?

Thanksgiving Math · 2

A pie box is 4 inches long, 4 inches wide and 6 inches tall. What is its volume in cubic inches?

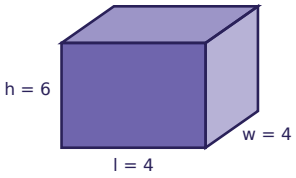

Thanksgiving Math · 3

One pumpkin pie costs $8.90. Ben buys 4 pumpkin pies. How much does Ben spend?

Thanksgiving Math · 4

One batch of a recipe uses $\frac{1}{4}$ cup of pumpkin puree. Zoe makes 5 batches. How many cups of pumpkin puree does Zoe use?

Thanksgiving Math · 5

One jar of cranberry sauce costs $4.00. Omar buys 3 jars of cranberry sauce. How much does Omar spend?

Thanksgiving Math · 6

Ava buys a bag of rolls for $2.55 and pays with a $10 bill. How much change does Ava get?

Thanksgiving Math · 7

A pie box is 5 inches long, 8 inches wide and 7 inches tall. What is its volume in cubic inches?

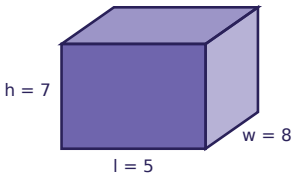

Thanksgiving Math · 8

Zoe buys a pumpkin pie for $5.20 and pays with a $10 bill. How much change does Zoe get?

Thanksgiving Math · 2

ANSWER

96

Thanksgiving Math · 1

ANSWER

$3\frac{3}{4}$

Thanksgiving Math · 4

ANSWER

$1\frac{1}{4}$

Thanksgiving Math · 3

ANSWER

$35.60

Thanksgiving Math · 6

ANSWER

$7.45

Thanksgiving Math · 5

ANSWER

$12.00

Thanksgiving Math · 8

ANSWER

$4.80

Thanksgiving Math · 7

ANSWER

280

Thanksgiving Math · 9

A pie box is 10 inches long, 3 inches wide and 6 inches tall. What is its volume in cubic inches?

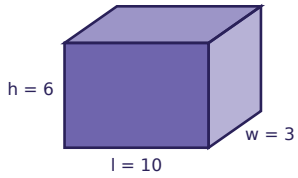

Thanksgiving Math · 10

One bag of rolls costs $5.00. Sam buys 2 bags of rolls. How much does Sam spend?

Thanksgiving Math · 11

A pie box is 7 inches long, 5 inches wide and 2 inches tall. What is its volume in cubic inches?

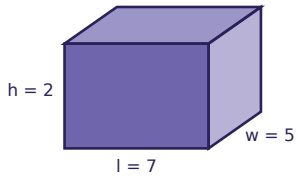

Thanksgiving Math · 12

Ella buys a pumpkin pie for $8.31 and pays with a $10 bill. How much change does Ella get?

Thanksgiving Math · 13

One bag of rolls costs $2.70. Sam buys 8 bags of rolls. How much does Sam spend?

Thanksgiving Math · 14

One batch of a recipe uses $\frac{2}{3}$ cup of pumpkin puree. Lily makes 3 batches. How many cups of pumpkin puree does Lily use?

Thanksgiving Math · 15

One batch of a recipe uses $\frac{5}{8}$ cup of pumpkin puree. Omar makes 5 batches. How many cups of pumpkin puree does Omar use?

Thanksgiving Math · 16

Zoe buys a bag of rolls for $3.45 and pays with a $10 bill. How much change does Zoe get?

Thanksgiving Math · 10

ANSWER

$10.00

Thanksgiving Math · 9

ANSWER

180

Thanksgiving Math · 12

ANSWER

$1.69

Thanksgiving Math · 11

ANSWER

70

Thanksgiving Math · 14

ANSWER

2

Thanksgiving Math · 13

ANSWER

$21.60

Thanksgiving Math · 16

ANSWER

$6.55

Thanksgiving Math · 15

ANSWER

$$3\frac{1}{8}$$

Thanksgiving Math · 17

A pie box is 12 inches long, 3 inches wide and 5 inches tall. What is its volume in cubic inches?

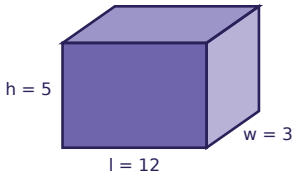

Thanksgiving Math · 18

One jar of cranberry sauce costs $2.35. Noah buys 9 jars of cranberry sauce. How much does Noah spend?

Thanksgiving Math · 19

One batch of a recipe uses $\frac{3}{8}$ cup of pumpkin puree. Sam makes 5 batches. How many cups of pumpkin puree does Sam use?

Thanksgiving Math · 20

Omar buys a pumpkin pie for $7.60 and pays with a $10 bill. How much change does Omar get?

Thanksgiving Math · 21

Omar buys a jar of cranberry sauce for $3.03 and pays with a $10 bill. How much change does Omar get?

Thanksgiving Math · 22

One jar of cranberry sauce costs $2.15. Ella buys 9 jars of cranberry sauce. How much does Ella spend?

Thanksgiving Math · 23

One batch of a recipe uses $\frac{3}{8}$ cup of pumpkin puree. Lily makes 4 batches. How many cups of pumpkin puree does Lily use?

Thanksgiving Math · 24

A pie box is 10 inches long, 3 inches wide and 7 inches tall. What is its volume in cubic inches?

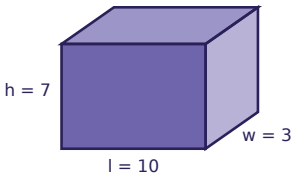

Thanksgiving Math · 18

ANSWER

$21.15

Thanksgiving Math · 17

ANSWER

180

Thanksgiving Math · 20

ANSWER

$2.40

Thanksgiving Math · 19

ANSWER

$$1\frac{7}{8}$$

Thanksgiving Math · 22

ANSWER

$19.35

Thanksgiving Math · 21

ANSWER

$6.97

Thanksgiving Math · 24

ANSWER

210

Thanksgiving Math · 23

ANSWER

$$1\frac{1}{2}$$