Thanksgiving Math · 1

One batch of a recipe uses $\frac{3}{8}$ cup of pumpkin puree. Zoe makes 3 batches. How many cups of pumpkin puree does Zoe use?

Thanksgiving Math · 2

Mia buys a jar of cranberry sauce for $3.81 and pays with a $10 bill. How much change does Mia get?

Thanksgiving Math · 3

A pie box is 10 inches long, 7 inches wide and 4 inches tall. What is its volume in cubic inches?

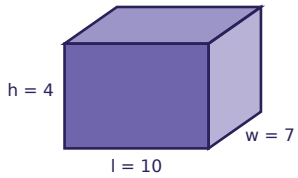

Thanksgiving Math · 4

Zoe buys a jar of cranberry sauce for $3.76 and pays with a $10 bill. How much change does Zoe get?

Thanksgiving Math · 5

One bag of rolls costs $2.80. Omar buys 7 bags of rolls. How much does Omar spend?

Thanksgiving Math · 6

A pie box is 11 inches long, 9 inches wide and 5 inches tall. What is its volume in cubic inches?

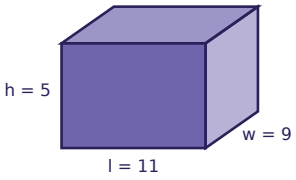

Thanksgiving Math · 7

One batch of a recipe uses $\frac{5}{6}$ cup of pumpkin puree. Omar makes 2 batches. How many cups of pumpkin puree does Omar use?

Thanksgiving Math · 8

One jar of cranberry sauce costs $2.65. Ben buys 5 jars of cranberry sauce. How much does Ben spend?

Thanksgiving Math · 2

ANSWER

$6.19

Thanksgiving Math · 1

ANSWER

$$1\frac{1}{8}$$

Thanksgiving Math · 4

ANSWER

$6.24

Thanksgiving Math · 3

ANSWER

280

Thanksgiving Math · 6

ANSWER

495

Thanksgiving Math · 5

ANSWER

$19.60

Thanksgiving Math · 8

ANSWER

$13.25

Thanksgiving Math · 7

ANSWER

$$1\frac{2}{3}$$

Thanksgiving Math · 9

Noah buys a jar of cranberry sauce for $2.76 and pays with a $10 bill. How much change does Noah get?

Thanksgiving Math · 10

One jar of cranberry sauce costs $1.55. Ava buys 2 jars of cranberry sauce. How much does Ava spend?

Thanksgiving Math · 11

One batch of a recipe uses $\frac{3}{8}$ cup of pumpkin puree. Noah makes 5 batches. How many cups of pumpkin puree does Noah use?

Thanksgiving Math · 12

A pie box is 14 inches long, 6 inches wide and 3 inches tall. What is its volume in cubic inches?

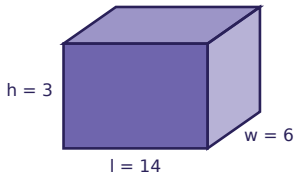

Thanksgiving Math · 13

A pie box is 13 inches long, 9 inches wide and 8 inches tall. What is its volume in cubic inches?

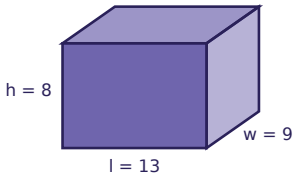

Thanksgiving Math · 14

Leo buys a bag of rolls for $3.80 and pays with a $10 bill. How much change does Leo get?

Thanksgiving Math · 15

One jar of cranberry sauce costs $1.45. Zoe buys 7 jars of cranberry sauce. How much does Zoe spend?

Thanksgiving Math · 16

One batch of a recipe uses $\frac{5}{8}$ cup of pumpkin puree. Sam makes 4 batches. How many cups of pumpkin puree does Sam use?

Thanksgiving Math · 10

ANSWER

$3.10

Thanksgiving Math · 9

ANSWER

$7.24

Thanksgiving Math · 12

ANSWER

252

Thanksgiving Math · 11

ANSWER

$1\frac{7}{8}$

Thanksgiving Math · 14

ANSWER

$6.20

Thanksgiving Math · 13

ANSWER

936

Thanksgiving Math · 16

ANSWER

$2\frac{1}{2}$

Thanksgiving Math · 15

ANSWER

$10.15

Thanksgiving Math · 17

A pie box is 10 inches long, 6 inches wide and 7 inches tall. What is its volume in cubic inches?

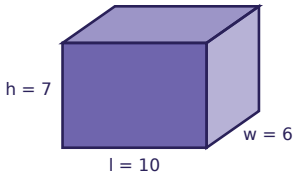

Thanksgiving Math · 18

One batch of a recipe uses $\frac{3}{8}$ cup of pumpkin puree. Ella makes 6 batches. How many cups of pumpkin puree does Ella use?

Thanksgiving Math · 19

One bag of rolls costs $2.55. Noah buys 6 bags of rolls. How much does Noah spend?

Thanksgiving Math · 20

Noah buys a pumpkin pie for $6.87 and pays with a $10 bill. How much change does Noah get?

Thanksgiving Math · 21

Noah buys a bag of rolls for $2.91 and pays with a $10 bill. How much change does Noah get?

Thanksgiving Math · 22

A pie box is 5 inches long, 3 inches wide and 7 inches tall. What is its volume in cubic inches?

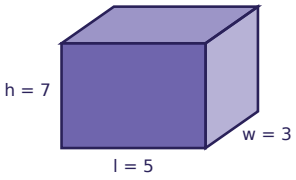

Thanksgiving Math · 23

One bag of rolls costs $4.30. Ava buys 2 bags of rolls. How much does Ava spend?

Thanksgiving Math · 24

One batch of a recipe uses $\frac{5}{8}$ cup of pumpkin puree. Omar makes 7 batches. How many cups of pumpkin puree does Omar use?

Thanksgiving Math · 18

ANSWER

$2\frac{1}{4}$

Thanksgiving Math · 17

ANSWER

420

Thanksgiving Math · 20

ANSWER

$3.13

Thanksgiving Math · 19

ANSWER

$15.30

Thanksgiving Math · 22

ANSWER

105

Thanksgiving Math · 21

ANSWER

$7.09

Thanksgiving Math · 24

ANSWER

$4\frac{3}{8}$

Thanksgiving Math · 23

ANSWER

$8.60