Thanksgiving Math · 1

A pie box is 6 inches long, 4 inches wide and 3 inches tall. What is its volume in cubic inches?

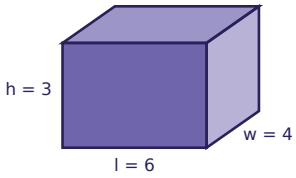

Thanksgiving Math · 2

One batch of a recipe uses $\frac{1}{4}$ cup of pumpkin puree. Sam makes 2 batches. How many cups of pumpkin puree does Sam use?

Thanksgiving Math · 3

Ella buys a bag of rolls for $2.50 and pays with a $10 bill. How much change does Ella get?

Thanksgiving Math · 4

One pumpkin pie costs $5.10. Omar buys 4 pumpkin pies. How much does Omar spend?

Thanksgiving Math · 5

One bag of rolls costs $4.90. Leo buys 4 bags of rolls. How much does Leo spend?

Thanksgiving Math · 6

A pie box is 4 inches long, 5 inches wide and 3 inches tall. What is its volume in cubic inches?

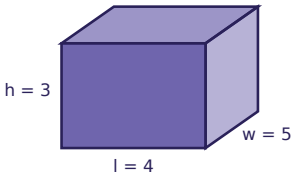

Thanksgiving Math · 7

One batch of a recipe uses $\frac{1}{4}$ cup of pumpkin puree. Ella makes 3 batches. How many cups of pumpkin puree does Ella use?

Thanksgiving Math · 8

Ella buys a pumpkin pie for $5.85 and pays with a $10 bill. How much change does Ella get?

Thanksgiving Math · 2

ANSWER

$\frac{1}{2}$

Thanksgiving Math · 1

ANSWER

72

Thanksgiving Math · 4

ANSWER

$20.40

Thanksgiving Math · 3

ANSWER

$7.50

Thanksgiving Math · 6

ANSWER

60

Thanksgiving Math · 5

ANSWER

$19.60

Thanksgiving Math · 8

ANSWER

$4.15

Thanksgiving Math · 7

ANSWER

$\frac{3}{4}$

Thanksgiving Math · 9

One bag of rolls costs $4.10. Sam buys 3 bags of rolls. How much does Sam spend?

Thanksgiving Math · 10

One jar of cranberry sauce costs $3.65. Ben buys 4 jars of cranberry sauce. How much does Ben spend?

Thanksgiving Math · 11

A pie box is 4 inches long, 5 inches wide and 5 inches tall. What is its volume in cubic inches?

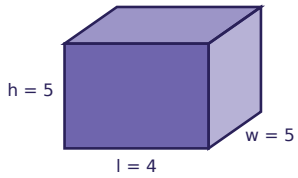

Thanksgiving Math · 12

Ella buys a jar of cranberry sauce for $1.90 and pays with a $10 bill. How much change does Ella get?

Thanksgiving Math · 13

One batch of a recipe uses $\frac{1}{2}$ cup of pumpkin puree. Sam makes 2 batches. How many cups of pumpkin puree does Sam use?

Thanksgiving Math · 14

One batch of a recipe uses $\frac{3}{4}$ cup of pumpkin puree. Ava makes 3 batches. How many cups of pumpkin puree does Ava use?

Thanksgiving Math · 15

A pie box is 4 inches long, 6 inches wide and 5 inches tall. What is its volume in cubic inches?

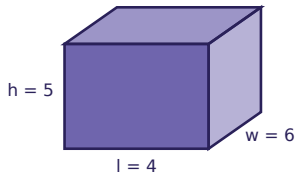

Thanksgiving Math · 16

Ben buys a jar of cranberry sauce for $1.15 and pays with a $10 bill. How much change does Ben get?

Thanksgiving Math · 10

ANSWER

$14.60

Thanksgiving Math · 9

ANSWER

$12.30

Thanksgiving Math · 12

ANSWER

$8.10

Thanksgiving Math · 11

ANSWER

100

Thanksgiving Math · 14

ANSWER

$2\frac{1}{4}$

Thanksgiving Math · 13

ANSWER

1

Thanksgiving Math · 16

ANSWER

$8.85

Thanksgiving Math · 15

ANSWER

120

Thanksgiving Math · 17

Ben buys a pumpkin pie for $7.10 and pays with a $10 bill. How much change does Ben get?

Thanksgiving Math · 18

One jar of cranberry sauce costs $1.60. Ella buys 2 jars of cranberry sauce. How much does Ella spend?

Thanksgiving Math · 19

One batch of a recipe uses $\frac{1}{4}$ cup of pumpkin puree. Zoe makes 3 batches. How many cups of pumpkin puree does Zoe use?

Thanksgiving Math · 20

One pumpkin pie costs $5.70. Lily buys 6 pumpkin pies. How much does Lily spend?

Thanksgiving Math · 21

One batch of a recipe uses $\frac{1}{3}$ cup of pumpkin puree. Ella makes 4 batches. How many cups of pumpkin puree does Ella use?

Thanksgiving Math · 22

A pie box is 6 inches long, 3 inches wide and 5 inches tall. What is its volume in cubic inches?

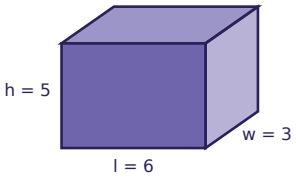

Thanksgiving Math · 23

A pie box is 4 inches long, 6 inches wide and 2 inches tall. What is its volume in cubic inches?

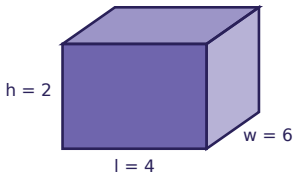

Thanksgiving Math · 24

Lily buys a bag of rolls for $3.20 and pays with a $10 bill. How much change does Lily get?

Thanksgiving Math · 18

ANSWER

$3.20

Thanksgiving Math · 17

ANSWER

$2.90

Thanksgiving Math · 20

ANSWER

$34.20

Thanksgiving Math · 19

ANSWER

$\frac{3}{4}$

Thanksgiving Math · 22

ANSWER

90

Thanksgiving Math · 21

ANSWER

$1\frac{1}{3}$

Thanksgiving Math · 24

ANSWER

$6.80

Thanksgiving Math · 23

ANSWER

48