Task card 1 Summer Math

One beach ball costs $5.60. Omar buys 2 beach balls. How much does Omar spend?

Task card 2 Summer Math

A cooler is 9 inches long, 7 inches wide and 3 inches tall. What is its volume in cubic inches?

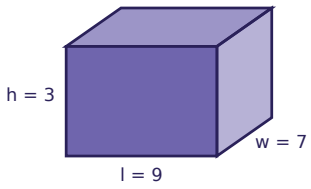

Task card 3 Summer Math

A cooler is 4 inches long, 5 inches wide and 2 inches tall. What is its volume in cubic inches?

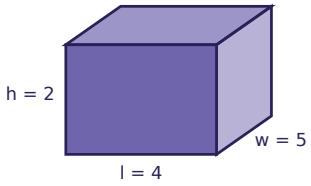

Task card 4 Summer Math

One batch of a recipe uses $\frac{3}{4}$ cup of lemon juice. Lily makes 4 batches. How many cups of lemon juice does Lily use?

Task card 5 Summer Math

One batch of a recipe uses $\frac{3}{4}$ cup of lemon juice. Ella makes 2 batches. How many cups of lemon juice does Ella use?

Task card 6 Summer Math

Noah buys a beach ball for $4.05 and pays with a $10 bill. How much change does Noah get?

Task card 7 Summer Math

One cup of lemonade costs $2.35. Leo buys 6 cups of lemonade. How much does Leo spend?

Task card 8 Summer Math

Leo buys a pair of sunglasses for $9.90 and pays with a $10 bill. How much change does Leo get?

Task card 9 Summer Math

A cooler is 5 inches long, 7 inches wide and 8 inches tall. What is its volume in cubic inches?

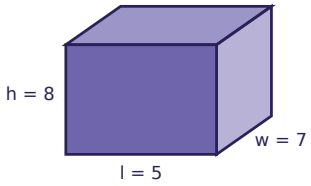

Task card 10 Summer Math

Zoe buys a beach ball for $6.00 and pays with a $10 bill. How much change does Zoe get?

Task card 11 Summer Math

One beach ball costs $7.45. Mia buys 6 beach balls. How much does Mia spend?

Task card 12 Summer Math

One batch of a recipe uses $\frac{3}{8}$ cup of lemon juice. Zoe makes 4 batches. How many cups of lemon juice does Zoe use?

Task card 13 Summer Math

Mia buys a pair of sunglasses for $10.63 and pays with a $20 bill. How much change does Mia get?

Task card 14 Summer Math

One batch of a recipe uses $\frac{3}{4}$ cup of lemon juice. Ben makes 4 batches. How many cups of lemon juice does Ben use?

Task card 15 Summer Math

A cooler is 7 inches long, 4 inches wide and 3 inches tall. What is its volume in cubic inches?

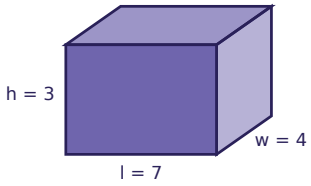

Task card 16 Summer Math

One cup of lemonade costs $1.45. Lily buys 6 cups of lemonade. How much does Lily spend?

Task card 17 Summer Math

One beach ball costs $3.50. Ben buys 4 beach balls. How much does Ben spend?

Task card 18 Summer Math

Ava buys a cup of lemonade for $1.07 and pays with a $10 bill. How much change does Ava get?

Task card 19 Summer Math

One batch of a recipe uses $\frac{5}{6}$ cup of lemon juice. Lily makes 6 batches. How many cups of lemon juice does Lily use?

Task card 20 Summer Math

Lily buys a beach ball for $5.61 and pays with a $10 bill. How much change does Lily get?

Task card 21 Summer Math

A cooler is 6 inches long, 6 inches wide and 7 inches tall. What is its volume in cubic inches?

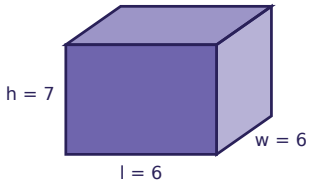

Task card 22 Summer Math

One pair of sunglasses costs $14.00. Mia buys 2 pairs of sunglasses. How much does Mia spend?

Task card 23 Summer Math

A cooler is 12 inches long, 7 inches wide and 4 inches tall. What is its volume in cubic inches?

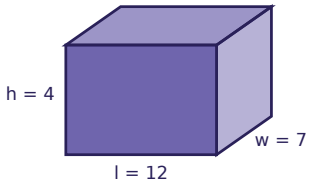

Task card 24 Summer Math

One batch of a recipe uses $\frac{2}{3}$ cup of lemon juice. Sam makes 2 batches. How many cups of lemon juice does Sam use?

Summer Math Task Cards

Recording sheet · Grade 5 · Read each story and solve. Write money like $4.50 and fractions like 1 1/2.

Name: _____ Date: _____

Scan to check your answers

1	2	3	4
5	6	7	8
9	10	11	12
13	14	15	16
17	18	19	20
21	22	23	24

Summer Math Task Cards: Answer Key

Grade 5 · Medium

The answers online

1. $11.20	**2.** 189	**3.** 40
4. 3	**5.** $1\frac{1}{2}$	**6.** $5.95
7. $14.10	**8.** $0.10	**9.** 280
10. $4.00	**11.** $44.70	**12.** $1\frac{1}{2}$
13. $9.37	**14.** 3	**15.** 84
16. $8.70	**17.** $14.00	**18.** $8.93
19. 5	**20.** $4.39	**21.** 252
22. $28.00	**23.** 336	**24.** $1\frac{1}{3}$