Task card 1 Summer Math

One batch of a recipe uses $\frac{3}{8}$ cup of lemon juice. Ella makes 3 batches. How many cups of lemon juice does Ella use?

Task card 2 Summer Math

Noah buys a cup of lemonade for $1.89 and pays with a $10 bill. How much change does Noah get?

Task card 3 Summer Math

Lily buys a cup of lemonade for $1.54 and pays with a $10 bill. How much change does Lily get?

Task card 4 Summer Math

A cooler is 10 inches long, 6 inches wide and 3 inches tall. What is its volume in cubic inches?

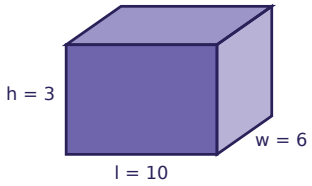

Task card 5 Summer Math

One pair of sunglasses costs $9.95. Ben buys 6 pairs of sunglasses. How much does Ben spend?

Task card 6 Summer Math

One pair of sunglasses costs $9.35. Ava buys 7 pairs of sunglasses. How much does Ava spend?

Task card 7 Summer Math

A cooler is 8 inches long, 8 inches wide and 4 inches tall. What is its volume in cubic inches?

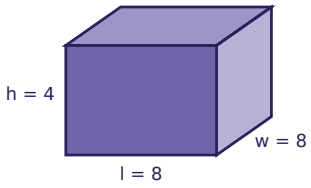

Task card 8 Summer Math

One batch of a recipe uses $\frac{3}{8}$ cup of lemon juice. Ava makes 3 batches. How many cups of lemon juice does Ava use?

Task card 9 Summer Math

One pair of sunglasses costs $8.65. Lily buys 6 pairs of sunglasses. How much does Lily spend?

Task card 10 Summer Math

A cooler is 10 inches long, 10 inches wide and 6 inches tall. What is its volume in cubic inches?

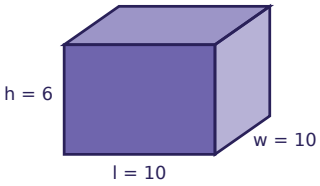

Task card 11 Summer Math

One cup of lemonade costs $2.90. Mia buys 6 cups of lemonade. How much does Mia spend?

Task card 12 Summer Math

One batch of a recipe uses $\frac{3}{8}$ cup of lemon juice. Ava makes 4 batches. How many cups of lemon juice does Ava use?

Task card 13 Summer Math

One batch of a recipe uses $\frac{2}{3}$ cup of lemon juice. Omar makes 5 batches. How many cups of lemon juice does Omar use?

Task card 14 Summer Math

A cooler is 11 inches long, 4 inches wide and 4 inches tall. What is its volume in cubic inches?

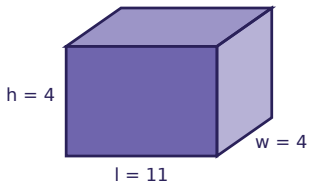

Task card 15 Summer Math

Lily buys a cup of lemonade for $2.46 and pays with a $10 bill. How much change does Lily get?

Task card 16 Summer Math

Sam buys a beach ball for $5.55 and pays with a $10 bill. How much change does Sam get?

Task card 17 Summer Math

One cup of lemonade costs $2.70. Ben buys 6 cups of lemonade. How much does Ben spend?

Task card 18 Summer Math

One beach ball costs $5.30. Ben buys 8 beach balls. How much does Ben spend?

Task card 19 Summer Math

One batch of a recipe uses $\frac{5}{6}$ cup of lemon juice. Lily makes 3 batches. How many cups of lemon juice does Lily use?

Task card 20 Summer Math

Leo buys a beach ball for $5.61 and pays with a $10 bill. How much change does Leo get?

Task card 21 Summer Math

One batch of a recipe uses $\frac{5}{8}$ cup of lemon juice. Lily makes 3 batches. How many cups of lemon juice does Lily use?

Task card 22 Summer Math

Lily buys a cup of lemonade for $2.35 and pays with a $10 bill. How much change does Lily get?

Task card 23 Summer Math

A cooler is 6 inches long, 4 inches wide and 7 inches tall. What is its volume in cubic inches?

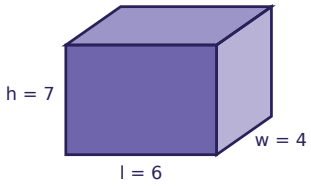

Task card 24 Summer Math

A cooler is 6 inches long, 10 inches wide and 3 inches tall. What is its volume in cubic inches?

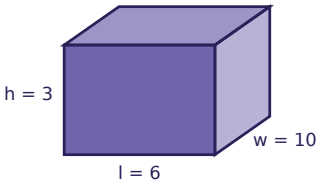

Summer Math Task Cards

Recording sheet · Grade 5 · Read each story and solve. Write money like $4.50 and fractions like 1 1/2.

Name: _____ Date: _____

Scan to check your answers

1	2	3	4
5	6	7	8
9	10	11	12
13	14	15	16
17	18	19	20
21	22	23	24

Summer Math Task Cards: Answer Key

Grade 5 · Hard

The answers online

1. $1\frac{1}{8}$	**2.** $8.11	**3.** $8.46
4. 180	**5.** $59.70	**6.** $65.45
7. 256	**8.** $1\frac{1}{8}$	**9.** $51.90
10. 600	**11.** $17.40	**12.** $1\frac{1}{2}$
13. $3\frac{1}{3}$	**14.** 176	**15.** $7.54
16. $4.45	**17.** $16.20	**18.** $42.40
19. $2\frac{1}{2}$	**20.** $4.39	**21.** $1\frac{7}{8}$
22. $7.65	**23.** 168	**24.** 180