Summer Math · 1

One batch of a recipe uses $\frac{3}{8}$ cup of lemon juice. Ella makes 3 batches. How many cups of lemon juice does Ella use?

Summer Math · 2

Noah buys a cup of lemonade for $1.89 and pays with a $10 bill. How much change does Noah get?

Summer Math · 3

Lily buys a cup of lemonade for $1.54 and pays with a $10 bill. How much change does Lily get?

Summer Math · 4

A cooler is 10 inches long, 6 inches wide and 3 inches tall. What is its volume in cubic inches?

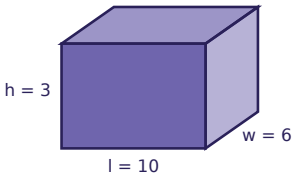

Summer Math · 5

One pair of sunglasses costs $9.95. Ben buys 6 pairs of sunglasses. How much does Ben spend?

Summer Math · 6

One pair of sunglasses costs $9.35. Ava buys 7 pairs of sunglasses. How much does Ava spend?

Summer Math · 7

A cooler is 8 inches long, 8 inches wide and 4 inches tall. What is its volume in cubic inches?

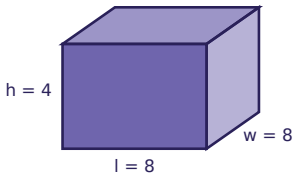

Summer Math · 8

One batch of a recipe uses $\frac{3}{8}$ cup of lemon juice. Ava makes 3 batches. How many cups of lemon juice does Ava use?

Summer Math · 2

ANSWER

$8.11

Summer Math · 1

ANSWER

$$1\frac{1}{8}$$

Summer Math · 4

ANSWER

180

Summer Math · 3

ANSWER

$8.46

Summer Math · 6

ANSWER

$65.45

Summer Math · 5

ANSWER

$59.70

Summer Math · 8

ANSWER

$$1\frac{1}{8}$$

Summer Math · 7

ANSWER

256

Summer Math · 9

One pair of sunglasses costs $8.65. Lily buys 6 pairs of sunglasses. How much does Lily spend?

Summer Math · 10

A cooler is 10 inches long, 10 inches wide and 6 inches tall. What is its volume in cubic inches?

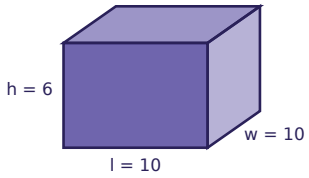

Summer Math · 11

One cup of lemonade costs $2.90. Mia buys 6 cups of lemonade. How much does Mia spend?

Summer Math · 12

One batch of a recipe uses $\frac{3}{8}$ cup of lemon juice. Ava makes 4 batches. How many cups of lemon juice does Ava use?

Summer Math · 13

One batch of a recipe uses $\frac{2}{3}$ cup of lemon juice. Omar makes 5 batches. How many cups of lemon juice does Omar use?

Summer Math · 14

A cooler is 11 inches long, 4 inches wide and 4 inches tall. What is its volume in cubic inches?

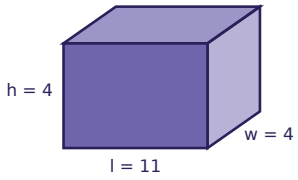

Summer Math · 15

Lily buys a cup of lemonade for $2.46 and pays with a $10 bill. How much change does Lily get?

Summer Math · 16

Sam buys a beach ball for $5.55 and pays with a $10 bill. How much change does Sam get?

Summer Math · 10

ANSWER

600

Summer Math · 9

ANSWER

$51.90

Summer Math · 12

ANSWER

$$1\frac{1}{2}$$

Summer Math · 11

ANSWER

$17.40

Summer Math · 14

ANSWER

176

Summer Math · 13

ANSWER

$$3\frac{1}{3}$$

Summer Math · 16

ANSWER

$4.45

Summer Math · 15

ANSWER

$7.54

Summer Math · 17

One cup of lemonade costs $2.70. Ben buys 6 cups of lemonade. How much does Ben spend?

Summer Math · 18

One beach ball costs $5.30. Ben buys 8 beach balls. How much does Ben spend?

Summer Math · 19

One batch of a recipe uses $\frac{5}{6}$ cup of lemon juice. Lily makes 3 batches. How many cups of lemon juice does Lily use?

Summer Math · 20

Leo buys a beach ball for $5.61 and pays with a $10 bill. How much change does Leo get?

Summer Math · 21

One batch of a recipe uses $\frac{5}{8}$ cup of lemon juice. Lily makes 3 batches. How many cups of lemon juice does Lily use?

Summer Math · 22

Lily buys a cup of lemonade for $2.35 and pays with a $10 bill. How much change does Lily get?

Summer Math · 23

A cooler is 6 inches long, 4 inches wide and 7 inches tall. What is its volume in cubic inches?

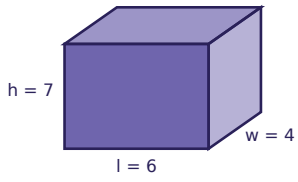

Summer Math · 24

A cooler is 6 inches long, 10 inches wide and 3 inches tall. What is its volume in cubic inches?

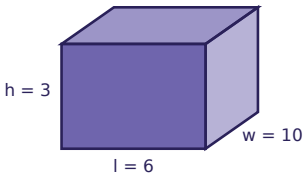

Summer Math · 18

ANSWER

$42.40

Summer Math · 17

ANSWER

$16.20

Summer Math · 20

ANSWER

$4.39

Summer Math · 19

ANSWER

$2\frac{1}{2}$

Summer Math · 22

ANSWER

$7.65

Summer Math · 21

ANSWER

$1\frac{7}{8}$

Summer Math · 24

ANSWER

180

Summer Math · 23

ANSWER

168