Summer Math · 1

Zoe buys a cup of lemonade for $2.75 and pays with a $10 bill. How much change does Zoe get?

Summer Math · 2

One cup of lemonade costs $1.35. Ben buys 3 cups of lemonade. How much does Ben spend?

Summer Math · 3

One pair of sunglasses costs $7.70. Omar buys 3 pairs of sunglasses. How much does Omar spend?

Summer Math · 4

A cooler is 7 inches long, 3 inches wide and 2 inches tall. What is its volume in cubic inches?

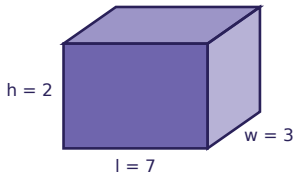

Summer Math · 5

One batch of a recipe uses $\frac{1}{3}$ cup of lemon juice. Mia makes 2 batches. How many cups of lemon juice does Mia use?

Summer Math · 6

A cooler is 7 inches long, 4 inches wide and 3 inches tall. What is its volume in cubic inches?

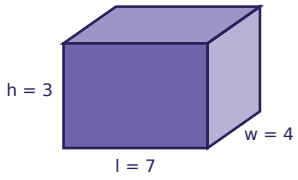

Summer Math · 7

One batch of a recipe uses $\frac{3}{4}$ cup of lemon juice. Ava makes 3 batches. How many cups of lemon juice does Ava use?

Summer Math · 8

Lily buys a beach ball for $4.65 and pays with a $10 bill. How much change does Lily get?

Summer Math · 2

ANSWER

$4.05

Summer Math · 1

ANSWER

$7.25

Summer Math · 4

ANSWER

42

Summer Math · 3

ANSWER

$23.10

Summer Math · 6

ANSWER

84

Summer Math · 5

ANSWER

$$\frac{2}{3}$$

Summer Math · 8

ANSWER

$5.35

Summer Math · 7

ANSWER

$$2\frac{1}{4}$$

Summer Math · 9

Ella buys a pair of sunglasses for $12.25 and pays with a $20 bill. How much change does Ella get?

Summer Math · 10

One beach ball costs $6.20. Mia buys 3 beach balls. How much does Mia spend?

Summer Math · 11

One batch of a recipe uses $\frac{1}{2}$ cup of lemon juice. Sam makes 2 batches. How many cups of lemon juice does Sam use?

Summer Math · 12

A cooler is 8 inches long, 3 inches wide and 2 inches tall. What is its volume in cubic inches?

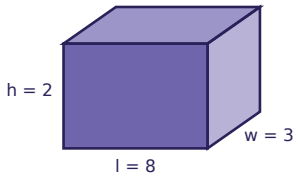

Summer Math · 13

A cooler is 7 inches long, 5 inches wide and 5 inches tall. What is its volume in cubic inches?

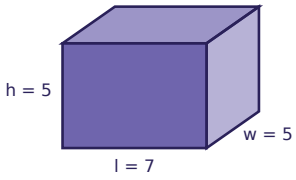

Summer Math · 14

Ava buys a beach ball for $3.85 and pays with a $10 bill. How much change does Ava get?

Summer Math · 15

One batch of a recipe uses $\frac{1}{4}$ cup of lemon juice. Omar makes 2 batches. How many cups of lemon juice does Omar use?

Summer Math · 16

One pair of sunglasses costs $5.45. Ella buys 5 pairs of sunglasses. How much does Ella spend?

Summer Math · 10

ANSWER

$18.60

Summer Math · 9

ANSWER

$7.75

Summer Math · 12

ANSWER

48

Summer Math · 11

ANSWER

1

Summer Math · 14

ANSWER

$6.15

Summer Math · 13

ANSWER

175

Summer Math · 16

ANSWER

$27.25

Summer Math · 15

ANSWER

$$\frac{1}{2}$$

Summer Math · 17

One batch of a recipe uses $\frac{1}{2}$ cup of lemon juice. Mia makes 3 batches. How many cups of lemon juice does Mia use?

Summer Math · 18

Sam buys a cup of lemonade for $1.65 and pays with a $10 bill. How much change does Sam get?

Summer Math · 19

One batch of a recipe uses $\frac{1}{4}$ cup of lemon juice. Mia makes 4 batches. How many cups of lemon juice does Mia use?

Summer Math · 20

Leo buys a cup of lemonade for $1.55 and pays with a $10 bill. How much change does Leo get?

Summer Math · 21

One pair of sunglasses costs $11.75. Noah buys 2 pairs of sunglasses. How much does Noah spend?

Summer Math · 22

A cooler is 9 inches long, 6 inches wide and 4 inches tall. What is its volume in cubic inches?

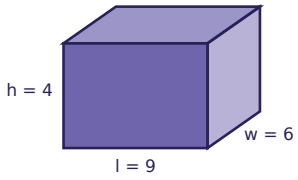

Summer Math · 23

One beach ball costs $5.60. Omar buys 3 beach balls. How much does Omar spend?

Summer Math · 24

One batch of a recipe uses $\frac{1}{2}$ cup of lemon juice. Sam makes 3 batches. How many cups of lemon juice does Sam use?

Summer Math · 18

ANSWER

$8.35

Summer Math · 17

ANSWER

$1\frac{1}{2}$

Summer Math · 20

ANSWER

$8.45

Summer Math · 19

ANSWER

1

Summer Math · 22

ANSWER

216

Summer Math · 21

ANSWER

$23.50

Summer Math · 24

ANSWER

$1\frac{1}{2}$

Summer Math · 23

ANSWER

$16.80