Task card 1 Subtracting Fractions with Unlike...

$$\frac{4}{5} - \frac{3}{4} = ___$$

Task card 2 Subtracting Fractions with Unlike...

$$\frac{1}{2} - \frac{1}{5} = ___$$

Task card 3 Subtracting Fractions with Unlike...

Each bar shows one of the fractions.

$\frac{3}{5} - \frac{1}{2} = ___$

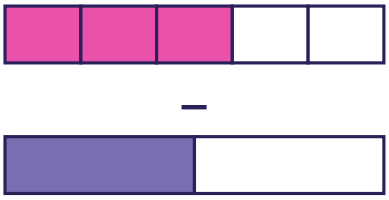

Task card 4 Subtracting Fractions with Unlike...

What is the least common denominator (LCD) of $\frac{2}{5}$ and $\frac{1}{6}$?

Task card 5 Subtracting Fractions with Unlike...

$$\frac{3}{4} - \frac{2}{3} = \frac{9}{12} - \frac{8}{12} = ___$$

Task card 6 Subtracting Fractions with Unlike...

Sam says $\frac{1}{3} - \frac{1}{4} = \frac{1}{12}$. Is Sam right? Write yes or no.

Task card 7 Subtracting Fractions with Unlike...

Mia had $\frac{3}{5}$ liter of juice and drank $\frac{1}{4}$ liter. How many liters of juice are left?

Task card 8 Subtracting Fractions with Unlike...

$$\frac{5}{6} - \underline{\quad} = \frac{1}{30}$$

Task card 9 Subtracting Fractions with Unlike...

$$\frac{5}{6} - \frac{3}{4} = \underline{\quad}$$

Task card 10 Subtracting Fractions with Unlike...

$$\frac{5}{12} - \frac{3}{8} = \underline{\quad}$$

Task card 11 Subtracting Fractions with Unlike...

Each bar shows one of the fractions.

$$\frac{7}{10} - \frac{1}{4} = \underline{\quad}$$

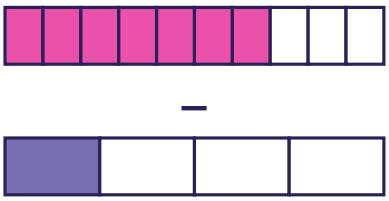

Task card 12 Subtracting Fractions with Unlike...

What is the least common denominator (LCD) of $\frac{3}{10}$ and $\frac{1}{4}$?

Task card 13 Subtracting Fractions with Unlike...

$\frac{1}{4} - \frac{1}{10} = \frac{5}{20} - \frac{2}{20} =$ ___

Task card 14 Subtracting Fractions with Unlike...

Lily says $\frac{11}{12} - \frac{5}{8} = \frac{1}{4}$. Is Lily right? Write yes or no.

Task card 15 Subtracting Fractions with Unlike...

Lily had $\frac{5}{6}$ liter of juice and drank $\frac{3}{4}$ liter. How many liters of juice are left?

Task card 16 Subtracting Fractions with Unlike...

$\frac{7}{10} - ___ = \frac{9}{20}$

Task card 17 Subtracting Fractions with Unlike...

$\frac{9}{10} - \frac{1}{2} =$ ___

Task card 18 Subtracting Fractions with Unlike...

$\frac{1}{2} - \frac{1}{6} =$ ___

Task card 19 Subtracting Fractions with Unlike...

Each bar shows one of the fractions.

$\frac{1}{2} - \frac{1}{6} = ___$

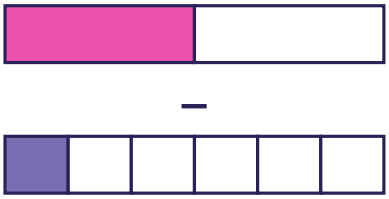

Task card 20 Subtracting Fractions with Unlike...

What is the least common denominator (LCD) of $\frac{7}{10}$ and $\frac{1}{5}$?

Task card 21 Subtracting Fractions with Unlike...

$$\frac{5}{6} - \frac{1}{3} = \frac{5}{6} - \frac{2}{6} = ___$$

Task card 22 Subtracting Fractions with Unlike...

Leo says $\frac{5}{6} - \frac{1}{2} = \frac{1}{3}$. Is Leo right? Write yes or no.

Task card 23 Subtracting Fractions with Unlike...

Max had $\frac{7}{10}$ liter of juice and drank $\frac{1}{2}$ liter. How many liters of juice are left?

Task card 24 Subtracting Fractions with Unlike...

$$\frac{2}{3} - ___ = \frac{1}{2}$$

Subtracting Fractions with Unlike Denominators Task Cards

Recording sheet · Grade 5 · Answer each question. The same kind of subtraction comes in different shapes. Write fractions in simplest form.

Scan to check your answers

Name: _____ Date: _____

1	2	3	4
5	6	7	8
9	10	11	12
13	14	15	16
17	18	19	20
21	22	23	24

Subtracting Fractions with Unlike Denominators Task Cards: Answer Key

Grade 5 · Medium

The answers online

1. $\frac{1}{20}$	**2.** $\frac{3}{10}$	**3.** $\frac{1}{10}$
4. 30	**5.** $\frac{1}{12}$	**6.** yes
7. $\frac{7}{20}$	**8.** $\frac{4}{5}$	**9.** $\frac{1}{12}$
10. $\frac{1}{24}$	**11.** $\frac{9}{20}$	**12.** 20
13. $\frac{3}{20}$	**14.** no	**15.** $\frac{1}{12}$
16. $\frac{1}{4}$	**17.** $\frac{2}{5}$	**18.** $\frac{1}{3}$
19. $\frac{1}{3}$	**20.** 10	**21.** $\frac{1}{2}$
22. yes	**23.** $\frac{1}{5}$	**24.** $\frac{1}{6}$