Task card 1 Subtracting Fractions with Unlike...

$$\frac{7}{8} - \frac{3}{4} = ___$$

Task card 2 Subtracting Fractions with Unlike...

$$\frac{3}{4} - \frac{5}{8} = ___$$

Task card 3 Subtracting Fractions with Unlike...

Each bar shows one of the fractions.

$\frac{7}{8} - \frac{3}{4} = ___$

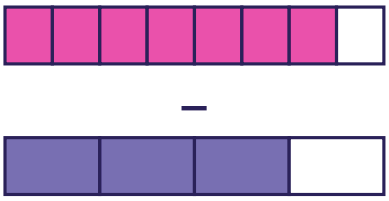

Task card 4 Subtracting Fractions with Unlike...

What is the least common denominator (LCD) of $\frac{1}{3}$ and $\frac{1}{6}$?

Task card 5 Subtracting Fractions with Unlike...

$$\frac{1}{2} - \frac{1}{4} = \frac{2}{4} - \frac{1}{4} = ___$$

Task card 6 Subtracting Fractions with Unlike...

Nora says $\frac{1}{6} - \frac{1}{12} = \frac{1}{12}$. Is Nora right? Write yes or no.

Task card 7 Subtracting Fractions with Unlike...

A ribbon is $\frac{3}{8}$ meter long. Leo cuts off $\frac{1}{4}$ meter. How many meters of ribbon are left?

Task card 8 Subtracting Fractions with Unlike...

$$\frac{5}{6} - \underline{\quad} = \frac{1}{6}$$

Task card 9 Subtracting Fractions with Unlike...

$$\frac{1}{2} - \frac{3}{8} = \underline{\quad}$$

Task card 10 Subtracting Fractions with Unlike...

$$\frac{7}{9} - \frac{1}{3} = \underline{\quad}$$

Task card 11 Subtracting Fractions with Unlike...

Each bar shows one of the fractions.

$$\frac{3}{4} - \frac{7}{12} = \underline{\quad}$$

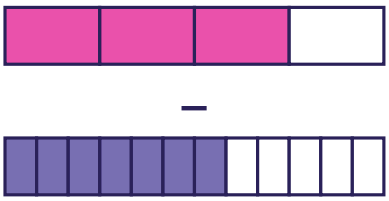

Task card 12 Subtracting Fractions with Unlike...

What is the least common denominator (LCD) of $\frac{1}{2}$ and $\frac{1}{6}$?

Task card 13 Subtracting Fractions with Unlike...

$\frac{1}{2} - \frac{1}{6} = \frac{3}{6} - \frac{1}{6} = ___$

Task card 14 Subtracting Fractions with Unlike...

Lily says $\frac{7}{12} - \frac{1}{4} = \frac{1}{3}$. Is Lily right? Write yes or no.

Task card 15 Subtracting Fractions with Unlike...

Ava hiked $\frac{7}{12}$ mile on Saturday and $\frac{1}{4}$ mile on Sunday. How many more miles did Ava hike on Saturday?

Task card 16 Subtracting Fractions with Unlike...

$\frac{5}{12} - ___ = \frac{1}{6}$

Task card 17 Subtracting Fractions with Unlike...

$\frac{4}{5} - \frac{1}{3} = ___$

Task card 18 Subtracting Fractions with Unlike...

$\frac{3}{5} - \frac{1}{3} = ___$

Task card 19 Subtracting Fractions with Unlike...

Each bar shows one of the fractions.

$\frac{1}{2} - \frac{1}{5} = ___$

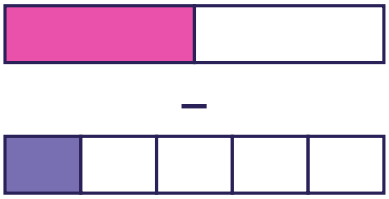

Task card 20 Subtracting Fractions with Unlike...

What is the least common denominator (LCD) of $\frac{2}{3}$ and $\frac{1}{4}$?

Task card 21 Subtracting Fractions with Unlike...

$$\frac{3}{4} - \frac{1}{5} = \frac{15}{20} - \frac{4}{20} = ___$$

Task card 22 Subtracting Fractions with Unlike...

Sam says $\frac{3}{5} - \frac{1}{4} = \frac{7}{20}$. Is Sam right? Write yes or no.

Task card 23 Subtracting Fractions with Unlike...

Mia had $\frac{4}{5}$ liter of juice and drank $\frac{1}{3}$ liter. How many liters of juice are left?

Task card 24 Subtracting Fractions with Unlike...

$$\frac{2}{3} - ___ = \frac{5}{12}$$

Subtracting Fractions with Unlike Denominators Task Cards

Recording sheet · Grade 5 · Answer each question. The same kind of subtraction comes in different shapes. Write fractions in simplest form.

Scan to check your answers

Name: _____ Date: _____

1	2	3	4
5	6	7	8
9	10	11	12
13	14	15	16
17	18	19	20
21	22	23	24

Subtracting Fractions with Unlike Denominators Task Cards: Answer Key

Grade 5 · Easy

The answers online

1. $\frac{1}{8}$	**2.** $\frac{1}{8}$	**3.** $\frac{1}{8}$
4. 6	**5.** $\frac{1}{4}$	**6.** yes
7. $\frac{1}{8}$	**8.** $\frac{2}{3}$	**9.** $\frac{1}{8}$
10. $\frac{4}{9}$	**11.** $\frac{1}{6}$	**12.** 6
13. $\frac{1}{3}$	**14.** yes	**15.** $\frac{1}{3}$
16. $\frac{1}{4}$	**17.** $\frac{7}{15}$	**18.** $\frac{4}{15}$
19. $\frac{3}{10}$	**20.** 12	**21.** $\frac{11}{20}$
22. yes	**23.** $\frac{7}{15}$	**24.** $\frac{1}{4}$