Subtracting Fractions with Unlike Denominators · 1

$$\frac{4}{5} - \frac{3}{4} = ___$$

Subtracting Fractions with Unlike Denominators · 2

$$\frac{1}{2} - \frac{1}{5} = ___$$

Subtracting Fractions with Unlike Denominators · 3

Each bar shows one of the fractions. $\frac{3}{5} - \frac{1}{2} = ___$

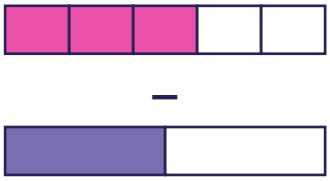

Subtracting Fractions with Unlike Denominators · 4

What is the least common denominator (LCD) of $\frac{2}{5}$ and $\frac{1}{6}$?

Subtracting Fractions with Unlike Denominators · 5

$$\frac{3}{4} - \frac{2}{3} = \frac{9}{12} - \frac{8}{12} = ___$$

Subtracting Fractions with Unlike Denominators · 6

Sam says $\frac{1}{3} - \frac{1}{4} = \frac{1}{12}$. Is Sam right?

Write yes or no.

Subtracting Fractions with Unlike Denominators · 7

Mia had $\frac{3}{5}$ liter of juice and drank $\frac{1}{4}$ liter. How many liters of juice are left?

Subtracting Fractions with Unlike Denominators · 8

$$\frac{5}{6} - ___ = \frac{1}{30}$$

Subtracting Fractions with Unlike Denominators · 2

ANSWER

$$\frac{3}{10}$$

Subtracting Fractions with Unlike Denominators · 1

ANSWER

$$\frac{1}{20}$$

Subtracting Fractions with Unlike Denominators · 4

ANSWER

30

Subtracting Fractions with Unlike Denominators · 3

ANSWER

$$\frac{1}{10}$$

Subtracting Fractions with Unlike Denominators · 6

ANSWER

yes

Subtracting Fractions with Unlike Denominators · 5

ANSWER

$$\frac{1}{12}$$

Subtracting Fractions with Unlike Denominators · 8

ANSWER

$$\frac{4}{5}$$

Subtracting Fractions with Unlike Denominators · 7

ANSWER

$$\frac{7}{20}$$

Subtracting Fractions with Unlike Denominators · 9

$$\frac{5}{6} - \frac{3}{4} = ___$$

Subtracting Fractions with Unlike Denominators · 10

$$\frac{5}{12} - \frac{3}{8} = ___$$

Subtracting Fractions with Unlike Denominators · 11

Each bar shows one of the fractions. $\frac{7}{10} - \frac{1}{4} = ___$

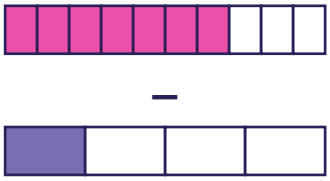

Subtracting Fractions with Unlike Denominators · 12

What is the least common denominator (LCD) of $\frac{3}{10}$ and $\frac{1}{4}$?

Subtracting Fractions with Unlike Denominators · 13

$$\frac{1}{4} - \frac{1}{10} = \frac{5}{20} - \frac{2}{20} = ___$$

Subtracting Fractions with Unlike Denominators · 14

Lily says $\frac{11}{12} - \frac{5}{8} = \frac{1}{4}$. Is Lily right?

Write yes or no.

Subtracting Fractions with Unlike Denominators · 15

Lily had $\frac{5}{6}$ liter of juice and drank $\frac{3}{4}$ liter. How many liters of juice are left?

Subtracting Fractions with Unlike Denominators · 16

$$\frac{7}{10} - ___ = \frac{9}{20}$$

Subtracting Fractions with Unlike Denominators · 10

ANSWER

$$\frac{1}{24}$$

Subtracting Fractions with Unlike Denominators · 9

ANSWER

$$\frac{1}{12}$$

Subtracting Fractions with Unlike Denominators · 12

ANSWER

20

Subtracting Fractions with Unlike Denominators · 11

ANSWER

$$\frac{9}{20}$$

Subtracting Fractions with Unlike Denominators · 14

ANSWER

no

Subtracting Fractions with Unlike Denominators · 13

ANSWER

$$\frac{3}{20}$$

Subtracting Fractions with Unlike Denominators · 16

ANSWER

$$\frac{1}{4}$$

Subtracting Fractions with Unlike Denominators · 15

ANSWER

$$\frac{1}{12}$$

Subtracting Fractions with Unlike Denominators · 17

$$\frac{9}{10} - \frac{1}{2} = ___$$

Subtracting Fractions with Unlike Denominators · 18

$$\frac{1}{2} - \frac{1}{6} = ___$$

Subtracting Fractions with Unlike Denominators · 19

Each bar shows one of the fractions. $\frac{1}{2} - \frac{1}{6} = ___$

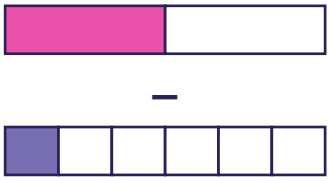

Subtracting Fractions with Unlike Denominators · 20

What is the least common denominator (LCD) of $\frac{7}{10}$ and $\frac{1}{5}$?

Subtracting Fractions with Unlike Denominators · 21

$$\frac{5}{6} - \frac{1}{3} = \frac{5}{6} - \frac{2}{6} = ___$$

Subtracting Fractions with Unlike Denominators · 22

Leo says $\frac{5}{6} - \frac{1}{2} = \frac{1}{3}$. Is Leo right?

Write yes or no.

Subtracting Fractions with Unlike Denominators · 23

Max had $\frac{7}{10}$ liter of juice and drank $\frac{1}{2}$ liter. How many liters of juice are left?

Subtracting Fractions with Unlike Denominators · 24

$$\frac{2}{3} - ___ = \frac{1}{2}$$

Subtracting Fractions with Unlike Denominators · 18

ANSWER

$\frac{1}{3}$

Subtracting Fractions with Unlike Denominators · 17

ANSWER

$\frac{2}{5}$

Subtracting Fractions with Unlike Denominators · 20

ANSWER

10

Subtracting Fractions with Unlike Denominators · 19

ANSWER

$\frac{1}{3}$

Subtracting Fractions with Unlike Denominators · 22

ANSWER

yes

Subtracting Fractions with Unlike Denominators · 21

ANSWER

$\frac{1}{2}$

Subtracting Fractions with Unlike Denominators · 24

ANSWER

$\frac{1}{6}$

Subtracting Fractions with Unlike Denominators · 23

ANSWER

$\frac{1}{5}$