Subtracting Fractions with Unlike Denominators · 1

$$\frac{1}{6} - \frac{1}{10} = ___$$

Subtracting Fractions with Unlike Denominators · 2

$$\frac{7}{8} - \frac{3}{7} = ___$$

Subtracting Fractions with Unlike Denominators · 3

Each bar shows one of the fractions. $\frac{11}{12} - \frac{1}{10} = ___$

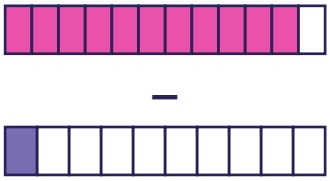

Subtracting Fractions with Unlike Denominators · 4

What is the least common denominator (LCD) of $\frac{7}{10}$ and $\frac{1}{7}$?

Subtracting Fractions with Unlike Denominators · 5

$$\frac{7}{12} - \frac{1}{10} = \frac{35}{60} - \frac{6}{60} = ___$$

Subtracting Fractions with Unlike Denominators · 6

Mia says $\frac{7}{12} - \frac{1}{4} = \frac{1}{2}$. Is Mia right? Write yes or no.

Subtracting Fractions with Unlike Denominators · 7

A bag held $\frac{1}{2}$ kilogram of flour. Nora used $\frac{1}{5}$ kilogram. How many kilograms of flour are left in the bag?

Subtracting Fractions with Unlike Denominators · 8

$$\frac{6}{7} - ___ = \frac{27}{56}$$

Subtracting Fractions with Unlike Denominators · 2

ANSWER

$$\frac{25}{56}$$

Subtracting Fractions with Unlike Denominators · 1

ANSWER

$$\frac{1}{15}$$

Subtracting Fractions with Unlike Denominators · 4

ANSWER

$$70$$

Subtracting Fractions with Unlike Denominators · 3

ANSWER

$$\frac{49}{60}$$

Subtracting Fractions with Unlike Denominators · 6

ANSWER

no

Subtracting Fractions with Unlike Denominators · 5

ANSWER

$$\frac{29}{60}$$

Subtracting Fractions with Unlike Denominators · 8

ANSWER

$$\frac{3}{8}$$

Subtracting Fractions with Unlike Denominators · 7

ANSWER

$$\frac{3}{10}$$

Subtracting Fractions with Unlike Denominators · 9

$\frac{7}{9} - \frac{1}{12} = ___$

Subtracting Fractions with Unlike Denominators · 10

$\frac{9}{10} - \frac{5}{6} = ___$

Subtracting Fractions with Unlike Denominators · 11

Each bar shows one of the fractions. $\frac{9}{10} - \frac{2}{3} = ___$

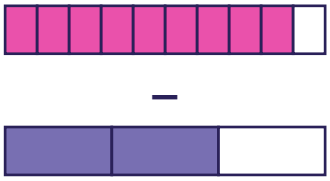

Subtracting Fractions with Unlike Denominators · 12

What is the least common denominator (LCD) of $\frac{7}{8}$ and $\frac{2}{5}$?

Subtracting Fractions with Unlike Denominators · 13

$\frac{11}{12} - \frac{8}{9} = \frac{33}{36} - \frac{32}{36} = ___$

Subtracting Fractions with Unlike Denominators · 14

Ava says $\frac{5}{12} - \frac{3}{8} = \frac{1}{24}$. Is Ava right?

Write yes or no.

Subtracting Fractions with Unlike Denominators · 15

Nora hiked $\frac{10}{11}$ mile on Saturday and $\frac{1}{3}$ mile on Sunday. How many more miles did Nora hike on Saturday?

Subtracting Fractions with Unlike Denominators · 16

$\frac{5}{6} - ___ = \frac{13}{30}$

Subtracting Fractions with Unlike Denominators · 10

ANSWER

$$\frac{1}{15}$$

Subtracting Fractions with Unlike Denominators · 9

ANSWER

$$\frac{25}{36}$$

Subtracting Fractions with Unlike Denominators · 12

ANSWER

40

Subtracting Fractions with Unlike Denominators · 11

ANSWER

$$\frac{7}{30}$$

Subtracting Fractions with Unlike Denominators · 14

ANSWER

yes

Subtracting Fractions with Unlike Denominators · 13

ANSWER

$$\frac{1}{36}$$

Subtracting Fractions with Unlike Denominators · 16

ANSWER

$$\frac{2}{5}$$

Subtracting Fractions with Unlike Denominators · 15

ANSWER

$$\frac{19}{33}$$

$$\frac{9}{10} - \frac{2}{5} = ___$$

$$\frac{3}{4} - \frac{4}{7} = ___$$

Each bar shows one of the fractions. $\frac{5}{9} - \frac{1}{11} = ___$

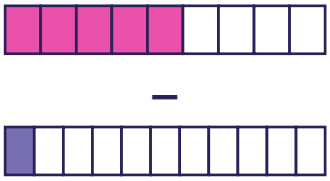

What is the least common denominator (LCD) of $\frac{1}{2}$ and $\frac{1}{5}$?

$$\frac{3}{7} - \frac{1}{4} = \frac{12}{28} - \frac{7}{28} = ___$$

Lily says $\frac{4}{9} - \frac{1}{5} = \frac{1}{15}$. Is Lily right?

Write yes or no.

Nora hiked $\frac{2}{3}$ mile on Saturday and $\frac{1}{11}$ mile on Sunday. How many more miles did Nora hike on Saturday?

$$\frac{7}{10} - ___ = \frac{9}{20}$$

Subtracting Fractions with Unlike Denominators · 18

ANSWER

$$\frac{5}{28}$$

Subtracting Fractions with Unlike Denominators · 17

ANSWER

$$\frac{1}{2}$$

Subtracting Fractions with Unlike Denominators · 20

ANSWER

10

Subtracting Fractions with Unlike Denominators · 19

ANSWER

$$\frac{46}{99}$$

Subtracting Fractions with Unlike Denominators · 22

ANSWER

no

Subtracting Fractions with Unlike Denominators · 21

ANSWER

$$\frac{5}{28}$$

Subtracting Fractions with Unlike Denominators · 24

ANSWER

$$\frac{1}{4}$$

Subtracting Fractions with Unlike Denominators · 23

ANSWER

$$\frac{19}{33}$$