Subtracting Fractions with Unlike Denominators · 1

$$\frac{7}{8} - \frac{3}{4} = ___$$

Subtracting Fractions with Unlike Denominators · 2

$$\frac{3}{4} - \frac{5}{8} = ___$$

Subtracting Fractions with Unlike Denominators · 3

Each bar shows one of the fractions. $\frac{7}{8} - \frac{3}{4} = ___$

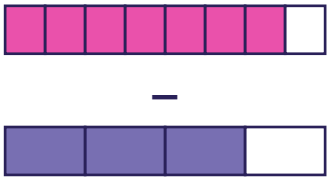

Subtracting Fractions with Unlike Denominators · 4

What is the least common denominator (LCD) of $\frac{1}{3}$ and $\frac{1}{6}$?

Subtracting Fractions with Unlike Denominators · 5

$$\frac{1}{2} - \frac{1}{4} = \frac{2}{4} - \frac{1}{4} = ___$$

Subtracting Fractions with Unlike Denominators · 6

Nora says $\frac{1}{6} - \frac{1}{12} = \frac{1}{12}$. Is Nora right? Write yes or no.

Subtracting Fractions with Unlike Denominators · 7

A ribbon is $\frac{3}{8}$ meter long. Leo cuts off $\frac{1}{4}$ meter. How many meters of ribbon are left?

Subtracting Fractions with Unlike Denominators · 8

$$\frac{5}{6} - ___ = \frac{1}{6}$$

Subtracting Fractions with Unlike Denominators · 2

ANSWER

$\frac{1}{8}$

Subtracting Fractions with Unlike Denominators · 1

ANSWER

$\frac{1}{8}$

Subtracting Fractions with Unlike Denominators · 4

ANSWER

6

Subtracting Fractions with Unlike Denominators · 3

ANSWER

$\frac{1}{8}$

Subtracting Fractions with Unlike Denominators · 6

ANSWER

yes

Subtracting Fractions with Unlike Denominators · 5

ANSWER

$\frac{1}{4}$

Subtracting Fractions with Unlike Denominators · 8

ANSWER

$\frac{2}{3}$

Subtracting Fractions with Unlike Denominators · 7

ANSWER

$\frac{1}{8}$

Subtracting Fractions with Unlike Denominators · 9

$\frac{1}{2} - \frac{3}{8} = ___$

Subtracting Fractions with Unlike Denominators · 10

$\frac{7}{9} - \frac{1}{3} = ___$

Subtracting Fractions with Unlike Denominators · 11

Each bar shows one of the fractions. $\frac{3}{4} - \frac{7}{12} = ___$

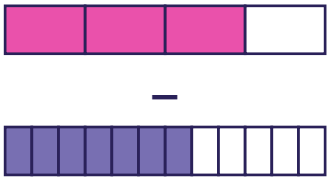

Subtracting Fractions with Unlike Denominators · 12

What is the least common denominator (LCD) of $\frac{1}{2}$ and $\frac{1}{6}$?

Subtracting Fractions with Unlike Denominators · 13

$\frac{1}{2} - \frac{1}{6} = \frac{3}{6} - \frac{1}{6} = ___$

Subtracting Fractions with Unlike Denominators · 14

Lily says $\frac{7}{12} - \frac{1}{4} = \frac{1}{3}$. Is Lily right?

Write yes or no.

Subtracting Fractions with Unlike Denominators · 15

Ava hiked $\frac{7}{12}$ mile on Saturday and $\frac{1}{4}$ mile on Sunday. How many more miles did Ava hike on Saturday?

Subtracting Fractions with Unlike Denominators · 16

$\frac{5}{12} - ___ = \frac{1}{6}$

Subtracting Fractions with Unlike Denominators · 10

ANSWER

$\frac{4}{9}$

Subtracting Fractions with Unlike Denominators · 9

ANSWER

$\frac{1}{8}$

Subtracting Fractions with Unlike Denominators · 12

ANSWER

6

Subtracting Fractions with Unlike Denominators · 11

ANSWER

$\frac{1}{6}$

Subtracting Fractions with Unlike Denominators · 14

ANSWER

yes

Subtracting Fractions with Unlike Denominators · 13

ANSWER

$\frac{1}{3}$

Subtracting Fractions with Unlike Denominators · 16

ANSWER

$\frac{1}{4}$

Subtracting Fractions with Unlike Denominators · 15

ANSWER

$\frac{1}{3}$

$$\frac{4}{5} - \frac{1}{3} = ___$$

$$\frac{3}{5} - \frac{1}{3} = ___$$

Each bar shows one of the fractions. $\frac{1}{2} - \frac{1}{5} = ___$

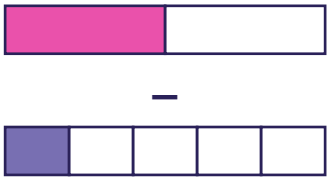

What is the least common denominator (LCD) of $\frac{2}{3}$ and $\frac{1}{4}$?

$$\frac{3}{4} - \frac{1}{5} = \frac{15}{20} - \frac{4}{20} = ___$$

Sam says $\frac{3}{5} - \frac{1}{4} = \frac{7}{20}$. Is Sam right?

Write yes or no.

Mia had $\frac{4}{5}$ liter of juice and drank $\frac{1}{3}$ liter. How many liters of juice are left?

$$\frac{2}{3} - ___ = \frac{5}{12}$$

Subtracting Fractions with Unlike Denominators · 18

ANSWER

$$\frac{4}{15}$$

Subtracting Fractions with Unlike Denominators · 17

ANSWER

$$\frac{7}{15}$$

Subtracting Fractions with Unlike Denominators · 20

ANSWER

$$12$$

Subtracting Fractions with Unlike Denominators · 19

ANSWER

$$\frac{3}{10}$$

Subtracting Fractions with Unlike Denominators · 22

ANSWER

yes

Subtracting Fractions with Unlike Denominators · 21

ANSWER

$$\frac{11}{20}$$

Subtracting Fractions with Unlike Denominators · 24

ANSWER

$$\frac{1}{4}$$

Subtracting Fractions with Unlike Denominators · 23

ANSWER

$$\frac{7}{15}$$