Task card 1 Subtracting Decimals with Hundredt...

The grids show 0.29 shaded, and 0.06 of it is crossed out. Count the shaded squares with no cross: 0.29 − 0.06 = ___

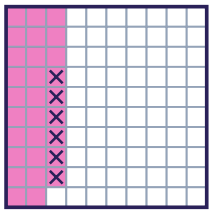

Task card 2 Subtracting Decimals with Hundredt...

The grids show 0.43 shaded. Some squares are crossed out and 0.21 is left. How much is crossed out? 0.43 − ___ = 0.21

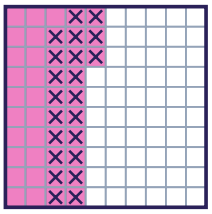

Task card 3 Subtracting Decimals with Hundredt...

The grids show 0.88 shaded, and 0.13 of it is crossed out. Count the shaded squares with no cross: 0.88 − 0.13 = ___

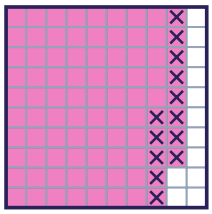

Task card 4 Subtracting Decimals with Hundredt...

The grids show 0.26 shaded. Some squares are crossed out and 0.16 is left. How much is crossed out? 0.26 − ___ = 0.16

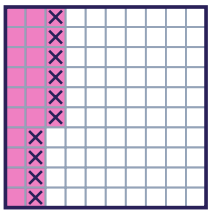

Task card 5 Subtracting Decimals with Hundredt...

The grids show 1.96 shaded, and 0.77 of it is crossed out. Count the shaded squares with no cross: 1.96 − 0.77 = ___

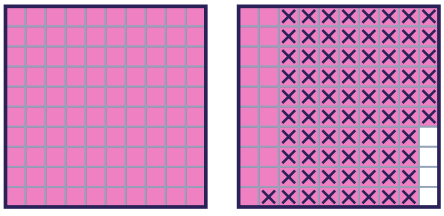

Task card 6 Subtracting Decimals with Hundredt...

The grids show 1.84 shaded. Some squares are crossed out and 1.59 is left. How much is crossed out? 1.84 − ___ = 1.59

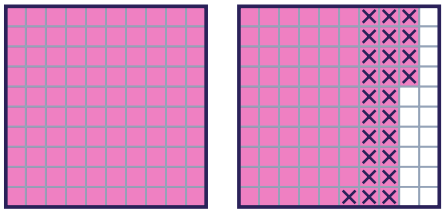

Task card 7 Subtracting Decimals with Hundredt...

The grids show 0.37 shaded, and 0.24 of it is crossed out. Count the shaded squares with no cross: 0.37 − 0.24 = ___



Task card 8 Subtracting Decimals with Hundredt...

The grids show 0.81 shaded. Some squares are crossed out and 0.20 is left. How much is crossed out? 0.81 − ___ = 0.20

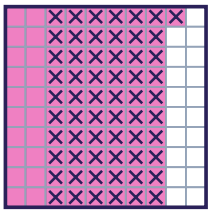

Task card 9 Subtracting Decimals with Hundredt...

The grids show 0.78 shaded, and 0.47 of it is crossed out. Count the shaded squares with no cross: 0.78 − 0.47 = ___



Task card 10 Subtracting Decimals with Hundredt...

The grids show 0.65 shaded. Some squares are crossed out and 0.60 is left. How much is crossed out? 0.65 − ___ = 0.60

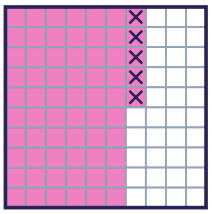

Task card 11 Subtracting Decimals with Hundredt...

The grids show 1.99 shaded, and 0.84 of it is crossed out. Count the shaded squares with no cross: 1.99 − 0.84 = ___

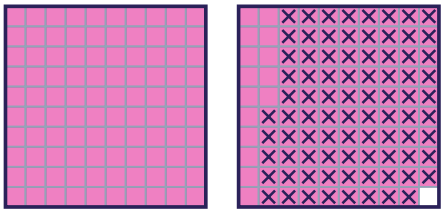

Task card 12 Subtracting Decimals with Hundredt...

The grids show 1.86 shaded. Some squares are crossed out and 1.40 is left. How much is crossed out? 1.86 − ___ = 1.40

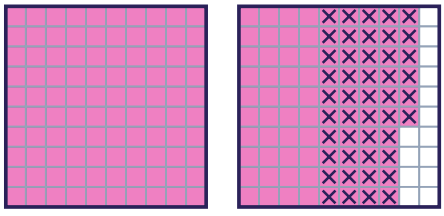

Task card 13 Subtracting Decimals with Hundredt...

The grids show 0.63 shaded, and 0.57 of it is crossed out. Count the shaded squares with no cross: 0.63 − 0.57 = ___



Task card 14 Subtracting Decimals with Hundredt...

The grids show 0.57 shaded. Some squares are crossed out and 0.32 is left. How much is crossed out? 0.57 − ___ = 0.32



Task card 15 Subtracting Decimals with Hundredt...

The grids show 0.47 shaded, and 0.24 of it is crossed out. Count the shaded squares with no cross: 0.47 − 0.24 = ___



Task card 16 Subtracting Decimals with Hundredt...

The grids show 0.39 shaded. Some squares are crossed out and 0.22 is left. How much is crossed out? 0.39 − ___ = 0.22

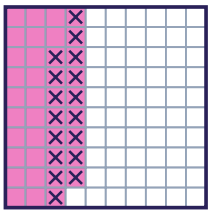

Task card 17 Subtracting Decimals with Hundredt...

The grids show 1.53 shaded, and 0.88 of it is crossed out. Count the shaded squares with no cross: 1.53 − 0.88 = ___

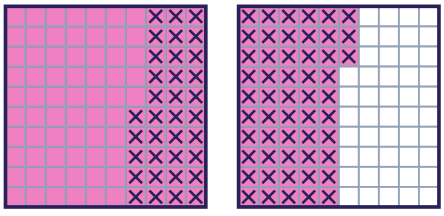

Task card 18 Subtracting Decimals with Hundredt...

The grids show 1.19 shaded. Some squares are crossed out and 0.06 is left. How much is crossed out? 1.19 − ___ = 0.06

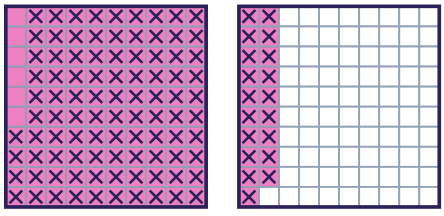

Task card 19 Subtracting Decimals with Hundredt...

The grids show 0.87 shaded, and 0.54 of it is crossed out. Count the shaded squares with no cross: 0.87 − 0.54 = ___

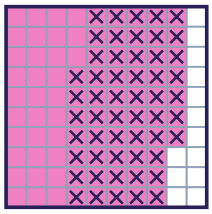

Task card 20 Subtracting Decimals with Hundredt...

The grids show 0.45 shaded. Some squares are crossed out and 0.14 is left. How much is crossed out? 0.45 − ___ = 0.14

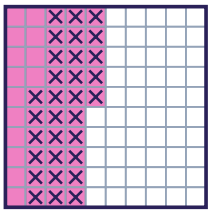

Task card 21 Subtracting Decimals with Hundredt...

The grids show 0.35 shaded, and 0.11 of it is crossed out. Count the shaded squares with no cross: 0.35 − 0.11 = ___



Task card 22 Subtracting Decimals with Hundredt...

The grids show 0.39 shaded. Some squares are crossed out and 0.17 is left. How much is crossed out? 0.39 − ___ = 0.17

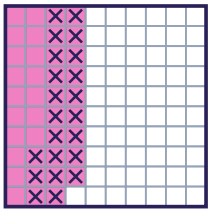

Task card 23 Subtracting Decimals with Hundredt...

The grids show 1.54 shaded, and 1.02 of it is crossed out. Count the shaded squares with no cross: 1.54 − 1.02 = ___



Task card 24 Subtracting Decimals with Hundredt...

The grids show 1.47 shaded. Some squares are crossed out and 1.13 is left. How much is crossed out? 1.47 − ___ = 1.13

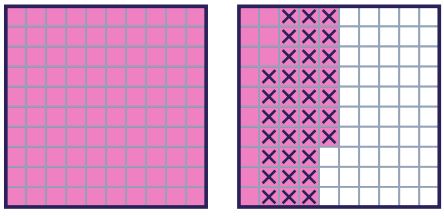

Subtracting Decimals with Hundredths Grids Task Cards

Recording sheet · Grade 5 · On blank grids, shade the first number and cross out the number you take away, then count what is left. When the grids are already shaded, read the numbers from the picture. Check your work with the standard algorithm.

Scan to check your answers

Name: _____ Date: _____

1	2	3	4
5	6	7	8
9	10	11	12
13	14	15	16
17	18	19	20
21	22	23	24

Subtracting Decimals with Hundredths Grids Task Cards: Answer Key

Grade 5 · Easy

The answers online

1. 0.23	**2.** 0.22	**3.** 0.75
4. 0.1	**5.** 1.19	**6.** 0.25
7. 0.13	**8.** 0.61	**9.** 0.31
10. 0.05	**11.** 1.15	**12.** 0.46
13. 0.06	**14.** 0.25	**15.** 0.23
16. 0.17	**17.** 0.65	**18.** 1.13
19. 0.33	**20.** 0.31	**21.** 0.24
22. 0.22	**23.** 0.52	**24.** 0.34