Subtracting Decimals with Hundredths Grids · 1

The grids show 2.53 shaded, and 2.16 of it is crossed out. Count the shaded squares with no cross: 2.53 − 2.16 = ___



Subtracting Decimals with Hundredths Grids · 2

The grids show 2.49 shaded. Some squares are crossed out and 1.90 is left. How much is crossed out? 2.49 − ___ = 1.90



Subtracting Decimals with Hundredths Grids · 3

The grids show 2.52 shaded, and 0.85 of it is crossed out. Count the shaded squares with no cross: 2.52 − 0.85 = ___



Subtracting Decimals with Hundredths Grids · 4

The grids show 2.19 shaded. Some squares are crossed out and 0.33 is left. How much is crossed out? 2.19 − ___ = 0.33



Subtracting Decimals with Hundredths Grids · 5

The grids show 2.58 shaded, and 2.49 of it is crossed out. Count the shaded squares with no cross: 2.58 − 2.49 = ___



Subtracting Decimals with Hundredths Grids · 6

The grids show 2.11 shaded. Some squares are crossed out and 1.44 is left. How much is crossed out? 2.11 − ___ = 1.44



Subtracting Decimals with Hundredths Grids · 7

The grids show 2.40 shaded, and 1.40 of it is crossed out. Count the shaded squares with no cross: 2.40 − 1.40 = ___



Subtracting Decimals with Hundredths Grids · 8

The grids show 2.86 shaded. Some squares are crossed out and 0.83 is left. How much is crossed out? 2.86 − ___ = 0.83



Subtracting Decimals with Hundredths Grids · 2

ANSWER

0.59

Subtracting Decimals with Hundredths Grids · 1

ANSWER

0.37

Subtracting Decimals with Hundredths Grids · 4

ANSWER

1.86

Subtracting Decimals with Hundredths Grids · 3

ANSWER

1.67

Subtracting Decimals with Hundredths Grids · 6

ANSWER

0.67

Subtracting Decimals with Hundredths Grids · 5

ANSWER

0.09

Subtracting Decimals with Hundredths Grids · 8

ANSWER

2.03

Subtracting Decimals with Hundredths Grids · 7

ANSWER

1

Subtracting Decimals with Hundredths Grids · 9

The grids show 2.49 shaded, and 2.37 of it is crossed out. Count the shaded squares with no cross: 2.49 − 2.37 = ___



Subtracting Decimals with Hundredths Grids · 10

The grids show 2.58 shaded. Some squares are crossed out and 1.73 is left. How much is crossed out? 2.58 − ___ = 1.73



Subtracting Decimals with Hundredths Grids · 11

The grids show 2.48 shaded, and 0.36 of it is crossed out. Count the shaded squares with no cross: 2.48 − 0.36 = ___



Subtracting Decimals with Hundredths Grids · 12

The grids show 2.45 shaded. Some squares are crossed out and 0.23 is left. How much is crossed out? 2.45 − ___ = 0.23



Subtracting Decimals with Hundredths Grids · 13

The grids show 2.74 shaded, and 1.92 of it is crossed out. Count the shaded squares with no cross: 2.74 − 1.92 = ___



Subtracting Decimals with Hundredths Grids · 14

The grids show 2.26 shaded. Some squares are crossed out and 1.00 is left. How much is crossed out? 2.26 − ___ = 1.00



Subtracting Decimals with Hundredths Grids · 15

The grids show 2.86 shaded, and 2.81 of it is crossed out. Count the shaded squares with no cross: 2.86 − 2.81 = ___



Subtracting Decimals with Hundredths Grids · 16

The grids show 2.31 shaded. Some squares are crossed out and 0.24 is left. How much is crossed out? 2.31 − ___ = 0.24



Subtracting Decimals with Hundredths Grids · 10

ANSWER

0.85

Subtracting Decimals with Hundredths Grids · 9

ANSWER

0.12

Subtracting Decimals with Hundredths Grids · 12

ANSWER

2.22

Subtracting Decimals with Hundredths Grids · 11

ANSWER

2.12

Subtracting Decimals with Hundredths Grids · 14

ANSWER

1.26

Subtracting Decimals with Hundredths Grids · 13

ANSWER

0.82

Subtracting Decimals with Hundredths Grids · 16

ANSWER

2.07

Subtracting Decimals with Hundredths Grids · 15

ANSWER

0.05

Subtracting Decimals with Hundredths Grids · 17

The grids show 2.40 shaded, and 1.09 of it is crossed out. Count the shaded squares with no cross: 2.40 − 1.09 = ___



Subtracting Decimals with Hundredths Grids · 18

The grids show 2.70 shaded. Some squares are crossed out and 2.42 is left. How much is crossed out? 2.70 − ___ = 2.42



Subtracting Decimals with Hundredths Grids · 19

The grids show 2.53 shaded, and 2.34 of it is crossed out. Count the shaded squares with no cross: 2.53 − 2.34 = ___



Subtracting Decimals with Hundredths Grids · 20

The grids show 2.69 shaded. Some squares are crossed out and 2.47 is left. How much is crossed out? 2.69 − ___ = 2.47



Subtracting Decimals with Hundredths Grids · 21

The grids show 2.57 shaded, and 0.99 of it is crossed out. Count the shaded squares with no cross: 2.57 − 0.99 = ___



Subtracting Decimals with Hundredths Grids · 22

The grids show 2.23 shaded. Some squares are crossed out and 1.03 is left. How much is crossed out? 2.23 − ___ = 1.03



Subtracting Decimals with Hundredths Grids · 23

The grids show 2.14 shaded, and 1.47 of it is crossed out. Count the shaded squares with no cross: 2.14 − 1.47 = ___



Subtracting Decimals with Hundredths Grids · 24

The grids show 2.51 shaded. Some squares are crossed out and 0.60 is left. How much is crossed out? 2.51 − ___ = 0.60



Subtracting Decimals with Hundredths Grids · 18

ANSWER

0.28

Subtracting Decimals with Hundredths Grids · 17

ANSWER

1.31

Subtracting Decimals with Hundredths Grids · 20

ANSWER

0.22

Subtracting Decimals with Hundredths Grids · 19

ANSWER

0.19

Subtracting Decimals with Hundredths Grids · 22

ANSWER

1.2

Subtracting Decimals with Hundredths Grids · 21

ANSWER

1.58

Subtracting Decimals with Hundredths Grids · 24

ANSWER

1.91

Subtracting Decimals with Hundredths Grids · 23

ANSWER

0.67