Task card 1 St. Patrick's Day Math

Ella buys a shamrock plant for $10.00 and pays with a $20 bill. How much change does Ella get?

Task card 2 St. Patrick's Day Math

Sam buys a bag of gold coins for $3.10 and pays with a $10 bill. How much change does Sam get?

Task card 3 St. Patrick's Day Math

One shamrock plant costs $9.60. Ella buys 2 shamrock plants. How much does Ella spend?

Task card 4 St. Patrick's Day Math

One batch of a recipe uses $\frac{1}{2}$ cup of green sprinkles. Omar makes 5 batches. How many cups of green sprinkles does Omar use?

Task card 5 St. Patrick's Day Math

One batch of a recipe uses $\frac{1}{4}$ cup of green sprinkles. Mia makes 5 batches. How many cups of green sprinkles does Mia use?

Task card 6 St. Patrick's Day Math

A treasure box is 6 inches long, 6 inches wide and 4 inches tall. What is its volume in cubic inches?

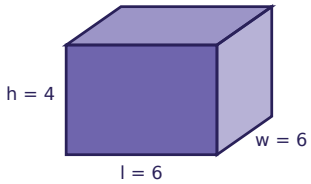

Task card 7 St. Patrick's Day Math

One shamrock plant costs $8.10. Ella buys 5 shamrock plants. How much does Ella spend?

Task card 8 St. Patrick's Day Math

A treasure box is 10 inches long, 7 inches wide and 3 inches tall. What is its volume in cubic inches?

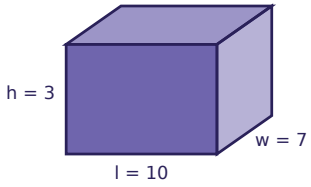

Task card 9 St. Patrick's Day Math

A treasure box is 10 inches long, 6 inches wide and 7 inches tall. What is its volume in cubic inches?

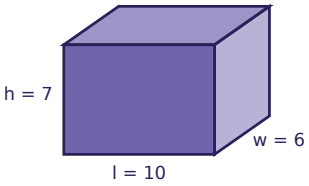

Task card 10 St. Patrick's Day Math

A treasure box is 10 inches long, 8 inches wide and 5 inches tall. What is its volume in cubic inches?

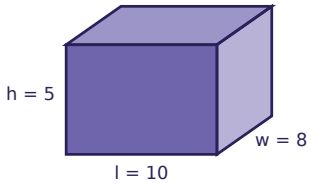

Task card 11 St. Patrick's Day Math

Sam buys a shamrock plant for $8.47 and pays with a $10 bill. How much change does Sam get?

Task card 12 St. Patrick's Day Math

Ava buys a green hat for $11.10 and pays with a $20 bill. How much change does Ava get?

Task card 13 St. Patrick's Day Math

One bag of gold coins costs $4.60. Sam buys 3 bags of gold coins. How much does Sam spend?

Task card 14 St. Patrick's Day Math

One shamrock plant costs $9.55. Sam buys 5 shamrock plants. How much does Sam spend?

Task card 15 St. Patrick's Day Math

One batch of a recipe uses $\frac{5}{6}$ cup of green sprinkles. Ben makes 3 batches. How many cups of green sprinkles does Ben use?

Task card 16 St. Patrick's Day Math

One batch of a recipe uses $\frac{2}{3}$ cup of green sprinkles. Ella makes 5 batches. How many cups of green sprinkles does Ella use?

Task card 17 St. Patrick's Day Math

One bag of gold coins costs $3.05. Omar buys 9 bags of gold coins. How much does Omar spend?

Task card 18 St. Patrick's Day Math

A treasure box is 4 inches long, 9 inches wide and 5 inches tall. What is its volume in cubic inches?

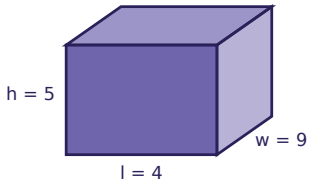

Task card 19 St. Patrick's Day Math

Zoe buys a shamrock plant for $6.41 and pays with a $10 bill. How much change does Zoe get?

Task card 20 St. Patrick's Day Math

One bag of gold coins costs $2.80. Ava buys 4 bags of gold coins. How much does Ava spend?

Task card 21 St. Patrick's Day Math

Noah buys a shamrock plant for $5.11 and pays with a $10 bill. How much change does Noah get?

Task card 22 St. Patrick's Day Math

A treasure box is 8 inches long, 9 inches wide and 7 inches tall. What is its volume in cubic inches?

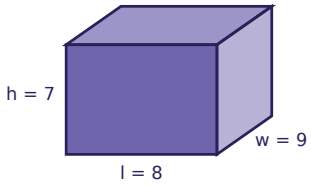

Task card 23 St. Patrick's Day Math

One batch of a recipe uses $\frac{2}{3}$ cup of green sprinkles. Sam makes 3 batches. How many cups of green sprinkles does Sam use?

Task card 24 St. Patrick's Day Math

One batch of a recipe uses $\frac{3}{8}$ cup of green sprinkles. Ben makes 4 batches. How many cups of green sprinkles does Ben use?

St. Patrick's Day Math Task Cards

Recording sheet · Grade 5 · Read each story and solve. Write money like $4.50 and fractions like 1 1/2.

Name: _____ Date: _____

Scan to check your answers

1	2	3	4
5	6	7	8
9	10	11	12
13	14	15	16
17	18	19	20
21	22	23	24

St. Patrick's Day Math Task Cards: Answer Key

Grade 5 · Medium

The answers online

1. $10.00	**2.** $6.90	**3.** $19.20
4. $2\frac{1}{2}$	**5.** $1\frac{1}{4}$	**6.** 144
7. $40.50	**8.** 210	**9.** 420
10. 400	**11.** $1.53	**12.** $8.90
13. $13.80	**14.** $47.75	**15.** $2\frac{1}{2}$
16. $3\frac{1}{3}$	**17.** $27.45	**18.** 180
19. $3.59	**20.** $11.20	**21.** $4.89
22. 504	**23.** 2	**24.** $1\frac{1}{2}$