Task card 1 St. Patrick's Day Math

One shamrock plant costs $6.95. Ava buys 5 shamrock plants. How much does Ava spend?

Task card 2 St. Patrick's Day Math

A treasure box is 6 inches long, 9 inches wide and 5 inches tall. What is its volume in cubic inches?

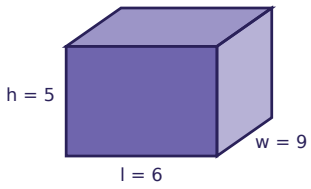

Task card 3 St. Patrick's Day Math

A treasure box is 4 inches long, 8 inches wide and 5 inches tall. What is its volume in cubic inches?

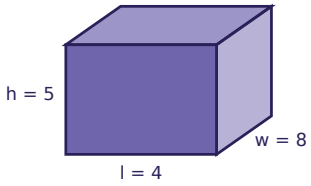

Task card 4 St. Patrick's Day Math

One shamrock plant costs $6.30. Mia buys 3 shamrock plants. How much does Mia spend?

Task card 5 St. Patrick's Day Math

Mia buys a shamrock plant for $4.75 and pays with a $10 bill. How much change does Mia get?

Task card 6 St. Patrick's Day Math

One batch of a recipe uses $\frac{2}{3}$ cup of green sprinkles. Ava makes 4 batches. How many cups of green sprinkles does Ava use?

Task card 7 St. Patrick's Day Math

Ben buys a bag of gold coins for $3.23 and pays with a $10 bill. How much change does Ben get?

Task card 8 St. Patrick's Day Math

One batch of a recipe uses $\frac{5}{8}$ cup of green sprinkles. Ben makes 3 batches. How many cups of green sprinkles does Ben use?

Task card 9 St. Patrick's Day Math

One bag of gold coins costs $4.55. Lily buys 4 bags of gold coins. How much does Lily spend?

Task card 10 St. Patrick's Day Math

A treasure box is 13 inches long, 3 inches wide and 8 inches tall. What is its volume in cubic inches?

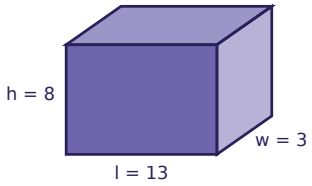

Task card 11 St. Patrick's Day Math

Lily buys a shamrock plant for $9.22 and pays with a $10 bill. How much change does Lily get?

Task card 12 St. Patrick's Day Math

One shamrock plant costs $7.10. Leo buys 2 shamrock plants. How much does Leo spend?

Task card 13 St. Patrick's Day Math

Ava buys a shamrock plant for $9.64 and pays with a $10 bill. How much change does Ava get?

Task card 14 St. Patrick's Day Math

One batch of a recipe uses $\frac{3}{4}$ cup of green sprinkles. Lily makes 7 batches. How many cups of green sprinkles does Lily use?

Task card 15 St. Patrick's Day Math

A treasure box is 7 inches long, 9 inches wide and 4 inches tall. What is its volume in cubic inches?

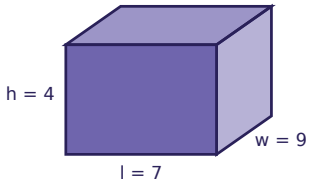

Task card 16 St. Patrick's Day Math

One batch of a recipe uses $\frac{3}{4}$ cup of green sprinkles. Ava makes 6 batches. How many cups of green sprinkles does Ava use?

Task card 17 St. Patrick's Day Math

One batch of a recipe uses $\frac{2}{3}$ cup of green sprinkles. Zoe makes 6 batches. How many cups of green sprinkles does Zoe use?

Task card 18 St. Patrick's Day Math

A treasure box is 9 inches long, 5 inches wide and 4 inches tall. What is its volume in cubic inches?

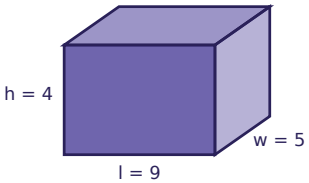

Task card 19 St. Patrick's Day Math

One shamrock plant costs $8.70. Sam buys 7 shamrock plants. How much does Sam spend?

Task card 20 St. Patrick's Day Math

Ella buys a shamrock plant for $4.96 and pays with a $10 bill. How much change does Ella get?

Task card 21 St. Patrick's Day Math

One batch of a recipe uses $\frac{2}{3}$ cup of green sprinkles. Leo makes 3 batches. How many cups of green sprinkles does Leo use?

Task card 22 St. Patrick's Day Math

One bag of gold coins costs $3.45. Leo buys 6 bags of gold coins. How much does Leo spend?

Task card 23 St. Patrick's Day Math

Leo buys a green hat for $10.27 and pays with a $20 bill. How much change does Leo get?

Task card 24 St. Patrick's Day Math

A treasure box is 11 inches long, 7 inches wide and 6 inches tall. What is its volume in cubic inches?

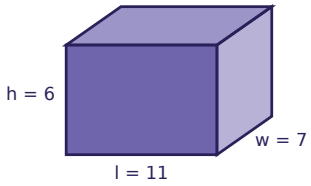

St. Patrick's Day Math Task Cards

Recording sheet · Grade 5 · Read each story and solve. Write money like $4.50 and fractions like 1 1/2.

Name: _____ Date: _____

Scan to check your answers

1	2	3	4
5	6	7	8
9	10	11	12
13	14	15	16
17	18	19	20
21	22	23	24

St. Patrick's Day Math Task Cards: Answer Key

Grade 5 · Hard

The answers online

1. $34.75	**2.** 270	**3.** 160
4. $18.90	**5.** $5.25	**6.** $2\frac{2}{3}$
7. $6.77	**8.** $1\frac{7}{8}$	**9.** $18.20
10. 312	**11.** $0.78	**12.** $14.20
13. $0.36	**14.** $5\frac{1}{4}$	**15.** 252
16. $4\frac{1}{2}$	**17.** 4	**18.** 180
19. $60.90	**20.** $5.04	**21.** 2
22. $20.70	**23.** $9.73	**24.** 462