Task card 1 St. Patrick's Day Math

One batch of a recipe uses $\frac{1}{4}$ cup of green sprinkles. Sam makes 2 batches. How many cups of green sprinkles does Sam use?

Task card 2 St. Patrick's Day Math

Leo buys a shamrock plant for $4.30 and pays with a $10 bill. How much change does Leo get?

Task card 3 St. Patrick's Day Math

One shamrock plant costs $8.85. Ben buys 4 shamrock plants. How much does Ben spend?

Task card 4 St. Patrick's Day Math

Ben buys a green hat for $7.95 and pays with a $10 bill. How much change does Ben get?

Task card 5 St. Patrick's Day Math

A treasure box is 7 inches long, 3 inches wide and 2 inches tall. What is its volume in cubic inches?

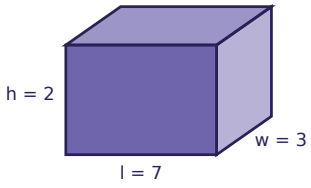

Task card 6 St. Patrick's Day Math

One bag of gold coins costs $2.50. Sam buys 4 bags of gold coins. How much does Sam spend?

Task card 7 St. Patrick's Day Math

One batch of a recipe uses $\frac{1}{2}$ cup of green sprinkles. Ben makes 3 batches. How many cups of green sprinkles does Ben use?

Task card 8 St. Patrick's Day Math

A treasure box is 7 inches long, 4 inches wide and 4 inches tall. What is its volume in cubic inches?

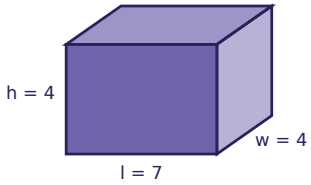

Task card 9 St. Patrick's Day Math

One shamrock plant costs $7.40. Leo buys 4 shamrock plants. How much does Leo spend?

Task card 10 St. Patrick's Day Math

One green hat costs $7.65. Ava buys 5 green hats. How much does Ava spend?

Task card 11 St. Patrick's Day Math

A treasure box is 4 inches long, 6 inches wide and 3 inches tall. What is its volume in cubic inches?

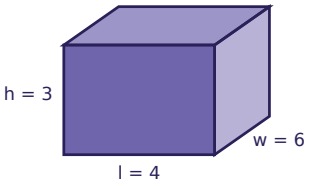

Task card 12 St. Patrick's Day Math

One batch of a recipe uses $\frac{3}{4}$ cup of green sprinkles. Lily makes 2 batches. How many cups of green sprinkles does Lily use?

Task card 13 St. Patrick's Day Math

Lily buys a green hat for $9.50 and pays with a $10 bill. How much change does Lily get?

Task card 14 St. Patrick's Day Math

One batch of a recipe uses $\frac{1}{2}$ cup of green sprinkles. Ella makes 2 batches. How many cups of green sprinkles does Ella use?

Task card 15 St. Patrick's Day Math

Ella buys a bag of gold coins for $2.95 and pays with a $10 bill. How much change does Ella get?

Task card 16 St. Patrick's Day Math

A treasure box is 6 inches long, 3 inches wide and 5 inches tall. What is its volume in cubic inches?

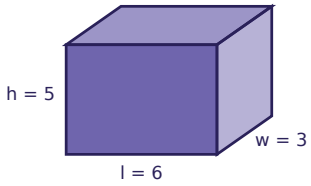

Task card 17 St. Patrick's Day Math

Ava buys a bag of gold coins for $3.00 and pays with a $10 bill. How much change does Ava get?

Task card 18 St. Patrick's Day Math

One bag of gold coins costs $3.60. Noah buys 5 bags of gold coins. How much does Noah spend?

Task card 19 St. Patrick's Day Math

One bag of gold coins costs $2.60. Noah buys 4 bags of gold coins. How much does Noah spend?

Task card 20 St. Patrick's Day Math

A treasure box is 5 inches long, 3 inches wide and 2 inches tall. What is its volume in cubic inches?

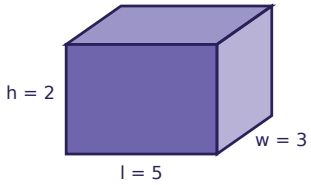

Task card 21 St. Patrick's Day Math

Lily buys a shamrock plant for $9.30 and pays with a $10 bill. How much change does Lily get?

Task card 22 St. Patrick's Day Math

One batch of a recipe uses $\frac{3}{4}$ cup of green sprinkles. Sam makes 2 batches. How many cups of green sprinkles does Sam use?

Task card 23 St. Patrick's Day Math

One batch of a recipe uses $\frac{1}{4}$ cup of green sprinkles. Omar makes 3 batches. How many cups of green sprinkles does Omar use?

Task card 24 St. Patrick's Day Math

A treasure box is 6 inches long, 5 inches wide and 4 inches tall. What is its volume in cubic inches?

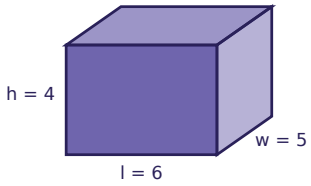

St. Patrick's Day Math Task Cards

Recording sheet · Grade 5 · Read each story and solve. Write money like $4.50 and fractions like 1 1/2.

Name: _____ Date: _____

Scan to check your answers

1	2	3	4
5	6	7	8
9	10	11	12
13	14	15	16
17	18	19	20
21	22	23	24

St. Patrick's Day Math Task Cards: Answer Key

Grade 5 · Easy

The answers online

1. $\frac{1}{2}$	**2.** $5.70	**3.** $35.40
4. $2.05	**5.** 42	**6.** $10.00
7. $1\frac{1}{2}$	**8.** 112	**9.** $29.60
10. $38.25	**11.** 72	**12.** $1\frac{1}{2}$
13. $0.50	**14.** 1	**15.** $7.05
16. 90	**17.** $7.00	**18.** $18.00
19. $10.40	**20.** 30	**21.** $0.70
22. $1\frac{1}{2}$	**23.** $\frac{3}{4}$	**24.** 120