St. Patrick's Day Math · 1

Ella buys a shamrock plant for $10.00 and pays with a $20 bill. How much change does Ella get?

St. Patrick's Day Math · 2

Sam buys a bag of gold coins for $3.10 and pays with a $10 bill. How much change does Sam get?

St. Patrick's Day Math · 3

One shamrock plant costs $9.60. Ella buys 2 shamrock plants. How much does Ella spend?

St. Patrick's Day Math · 4

One batch of a recipe uses $\frac{1}{2}$ cup of green sprinkles. Omar makes 5 batches. How many cups of green sprinkles does Omar use?

St. Patrick's Day Math · 5

One batch of a recipe uses $\frac{1}{4}$ cup of green sprinkles. Mia makes 5 batches. How many cups of green sprinkles does Mia use?

St. Patrick's Day Math · 6

A treasure box is 6 inches long, 6 inches wide and 4 inches tall. What is its volume in cubic inches?

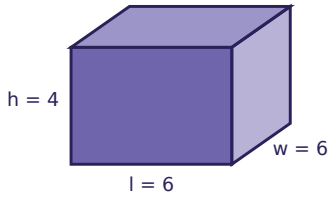

St. Patrick's Day Math · 7

One shamrock plant costs $8.10. Ella buys 5 shamrock plants. How much does Ella spend?

St. Patrick's Day Math · 8

A treasure box is 10 inches long, 7 inches wide and 3 inches tall. What is its volume in cubic inches?

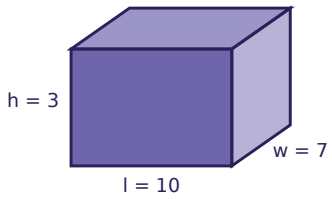

St. Patrick's Day Math · 2

ANSWER

$6.90

St. Patrick's Day Math · 1

ANSWER

$10.00

St. Patrick's Day Math · 4

ANSWER

$2\frac{1}{2}$

St. Patrick's Day Math · 3

ANSWER

$19.20

St. Patrick's Day Math · 6

ANSWER

144

St. Patrick's Day Math · 5

ANSWER

$1\frac{1}{4}$

St. Patrick's Day Math · 8

ANSWER

210

St. Patrick's Day Math · 7

ANSWER

$40.50

St. Patrick's Day Math · 9

A treasure box is 10 inches long, 6 inches wide and 7 inches tall. What is its volume in cubic inches?

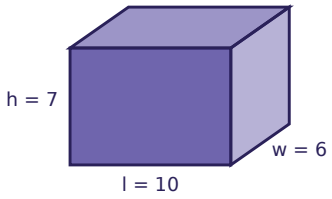

St. Patrick's Day Math · 10

A treasure box is 10 inches long, 8 inches wide and 5 inches tall. What is its volume in cubic inches?

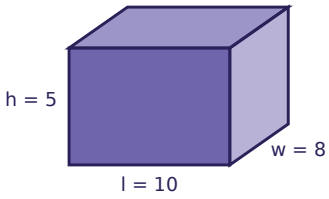

St. Patrick's Day Math · 11

Sam buys a shamrock plant for $8.47 and pays with a $10 bill. How much change does Sam get?

St. Patrick's Day Math · 12

Ava buys a green hat for $11.10 and pays with a $20 bill. How much change does Ava get?

St. Patrick's Day Math · 13

One bag of gold coins costs $4.60. Sam buys 3 bags of gold coins. How much does Sam spend?

St. Patrick's Day Math · 14

One shamrock plant costs $9.55. Sam buys 5 shamrock plants. How much does Sam spend?

St. Patrick's Day Math · 15

One batch of a recipe uses $\frac{5}{6}$ cup of green sprinkles. Ben makes 3 batches. How many cups of green sprinkles does Ben use?

St. Patrick's Day Math · 16

One batch of a recipe uses $\frac{2}{3}$ cup of green sprinkles. Ella makes 5 batches. How many cups of green sprinkles does Ella use?

St. Patrick's Day Math · 10

ANSWER

400

St. Patrick's Day Math · 9

ANSWER

420

St. Patrick's Day Math · 12

ANSWER

$8.90

St. Patrick's Day Math · 11

ANSWER

$1.53

St. Patrick's Day Math · 14

ANSWER

$47.75

St. Patrick's Day Math · 13

ANSWER

$13.80

St. Patrick's Day Math · 16

ANSWER

$3\frac{1}{3}$

St. Patrick's Day Math · 15

ANSWER

$2\frac{1}{2}$

St. Patrick's Day Math · 17

One bag of gold coins costs $3.05. Omar buys 9 bags of gold coins. How much does Omar spend?

St. Patrick's Day Math · 18

A treasure box is 4 inches long, 9 inches wide and 5 inches tall. What is its volume in cubic inches?

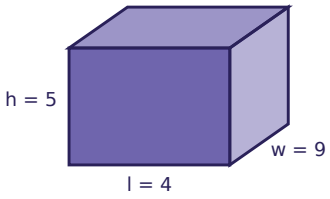

St. Patrick's Day Math · 19

Zoe buys a shamrock plant for $6.41 and pays with a $10 bill. How much change does Zoe get?

St. Patrick's Day Math · 20

One bag of gold coins costs $2.80. Ava buys 4 bags of gold coins. How much does Ava spend?

St. Patrick's Day Math · 21

Noah buys a shamrock plant for $5.11 and pays with a $10 bill. How much change does Noah get?

St. Patrick's Day Math · 22

A treasure box is 8 inches long, 9 inches wide and 7 inches tall. What is its volume in cubic inches?

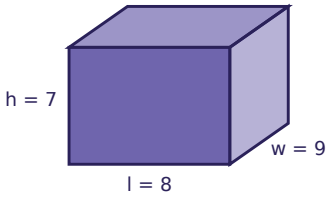

St. Patrick's Day Math · 23

One batch of a recipe uses $\frac{2}{3}$ cup of green sprinkles. Sam makes 3 batches. How many cups of green sprinkles does Sam use?

St. Patrick's Day Math · 24

One batch of a recipe uses $\frac{3}{8}$ cup of green sprinkles. Ben makes 4 batches. How many cups of green sprinkles does Ben use?

St. Patrick's Day Math · 18

ANSWER

180

St. Patrick's Day Math · 17

ANSWER

$27.45

St. Patrick's Day Math · 20

ANSWER

$11.20

St. Patrick's Day Math · 19

ANSWER

$3.59

St. Patrick's Day Math · 22

ANSWER

504

St. Patrick's Day Math · 21

ANSWER

$4.89

St. Patrick's Day Math · 24

ANSWER

$$1\frac{1}{2}$$

St. Patrick's Day Math · 23

ANSWER

2