St. Patrick's Day Math · 1

One shamrock plant costs $6.95. Ava buys 5 shamrock plants. How much does Ava spend?

St. Patrick's Day Math · 2

A treasure box is 6 inches long, 9 inches wide and 5 inches tall. What is its volume in cubic inches?

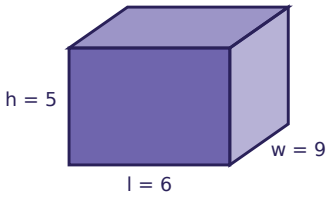

St. Patrick's Day Math · 3

A treasure box is 4 inches long, 8 inches wide and 5 inches tall. What is its volume in cubic inches?

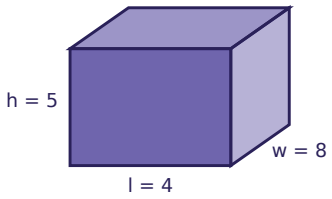

St. Patrick's Day Math · 4

One shamrock plant costs $6.30. Mia buys 3 shamrock plants. How much does Mia spend?

St. Patrick's Day Math · 5

Mia buys a shamrock plant for $4.75 and pays with a $10 bill. How much change does Mia get?

St. Patrick's Day Math · 6

One batch of a recipe uses $\frac{2}{3}$ cup of green sprinkles. Ava makes 4 batches. How many cups of green sprinkles does Ava use?

St. Patrick's Day Math · 7

Ben buys a bag of gold coins for $3.23 and pays with a $10 bill. How much change does Ben get?

St. Patrick's Day Math · 8

One batch of a recipe uses $\frac{5}{8}$ cup of green sprinkles. Ben makes 3 batches. How many cups of green sprinkles does Ben use?

St. Patrick's Day Math · 2

ANSWER

270

St. Patrick's Day Math · 1

ANSWER

$34.75

St. Patrick's Day Math · 4

ANSWER

$18.90

St. Patrick's Day Math · 3

ANSWER

160

St. Patrick's Day Math · 6

ANSWER

$$2\frac{2}{3}$$

St. Patrick's Day Math · 5

ANSWER

$5.25

St. Patrick's Day Math · 8

ANSWER

$$1\frac{7}{8}$$

St. Patrick's Day Math · 7

ANSWER

$6.77

St. Patrick's Day Math · 9

One bag of gold coins costs $4.55. Lily buys 4 bags of gold coins. How much does Lily spend?

St. Patrick's Day Math · 10

A treasure box is 13 inches long, 3 inches wide and 8 inches tall. What is its volume in cubic inches?

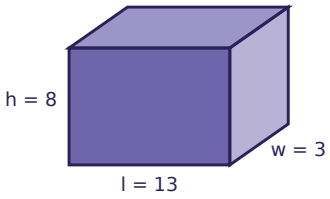

St. Patrick's Day Math · 11

Lily buys a shamrock plant for $9.22 and pays with a $10 bill. How much change does Lily get?

St. Patrick's Day Math · 12

One shamrock plant costs $7.10. Leo buys 2 shamrock plants. How much does Leo spend?

St. Patrick's Day Math · 13

Ava buys a shamrock plant for $9.64 and pays with a $10 bill. How much change does Ava get?

St. Patrick's Day Math · 14

One batch of a recipe uses $\frac{3}{4}$ cup of green sprinkles. Lily makes 7 batches. How many cups of green sprinkles does Lily use?

St. Patrick's Day Math · 15

A treasure box is 7 inches long, 9 inches wide and 4 inches tall. What is its volume in cubic inches?

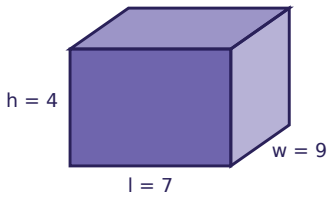

St. Patrick's Day Math · 16

One batch of a recipe uses $\frac{3}{4}$ cup of green sprinkles. Ava makes 6 batches. How many cups of green sprinkles does Ava use?

St. Patrick's Day Math · 10

ANSWER

312

St. Patrick's Day Math · 9

ANSWER

$18.20

St. Patrick's Day Math · 12

ANSWER

$14.20

St. Patrick's Day Math · 11

ANSWER

$0.78

St. Patrick's Day Math · 14

ANSWER

$5\frac{1}{4}$

St. Patrick's Day Math · 13

ANSWER

$0.36

St. Patrick's Day Math · 16

ANSWER

$4\frac{1}{2}$

St. Patrick's Day Math · 15

ANSWER

252

St. Patrick's Day Math · 17

One batch of a recipe uses $\frac{2}{3}$ cup of green sprinkles. Zoe makes 6 batches. How many cups of green sprinkles does Zoe use?

St. Patrick's Day Math · 18

A treasure box is 9 inches long, 5 inches wide and 4 inches tall. What is its volume in cubic inches?

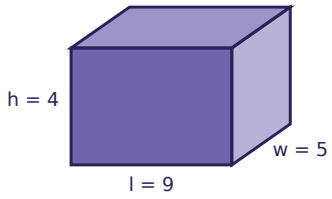

St. Patrick's Day Math · 19

One shamrock plant costs $8.70. Sam buys 7 shamrock plants. How much does Sam spend?

St. Patrick's Day Math · 20

Ella buys a shamrock plant for $4.96 and pays with a $10 bill. How much change does Ella get?

St. Patrick's Day Math · 21

One batch of a recipe uses $\frac{2}{3}$ cup of green sprinkles. Leo makes 3 batches. How many cups of green sprinkles does Leo use?

St. Patrick's Day Math · 22

One bag of gold coins costs $3.45. Leo buys 6 bags of gold coins. How much does Leo spend?

St. Patrick's Day Math · 23

Leo buys a green hat for $10.27 and pays with a $20 bill. How much change does Leo get?

St. Patrick's Day Math · 24

A treasure box is 11 inches long, 7 inches wide and 6 inches tall. What is its volume in cubic inches?

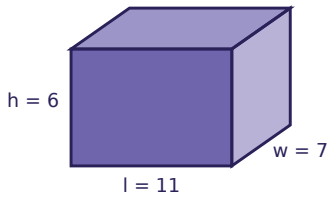

St. Patrick's Day Math · 18

ANSWER

180

St. Patrick's Day Math · 17

ANSWER

4

St. Patrick's Day Math · 20

ANSWER

$5.04

St. Patrick's Day Math · 19

ANSWER

$60.90

St. Patrick's Day Math · 22

ANSWER

$20.70

St. Patrick's Day Math · 21

ANSWER

2

St. Patrick's Day Math · 24

ANSWER

462

St. Patrick's Day Math · 23

ANSWER

$9.73