St. Patrick's Day Math · 1

One batch of a recipe uses $\frac{1}{4}$ cup of green sprinkles. Sam makes 2 batches. How many cups of green sprinkles does Sam use?

St. Patrick's Day Math · 2

Leo buys a shamrock plant for $4.30 and pays with a $10 bill. How much change does Leo get?

St. Patrick's Day Math · 3

One shamrock plant costs $8.85. Ben buys 4 shamrock plants. How much does Ben spend?

St. Patrick's Day Math · 4

Ben buys a green hat for $7.95 and pays with a $10 bill. How much change does Ben get?

St. Patrick's Day Math · 5

A treasure box is 7 inches long, 3 inches wide and 2 inches tall. What is its volume in cubic inches?

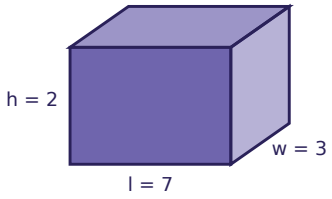

St. Patrick's Day Math · 6

One bag of gold coins costs $2.50. Sam buys 4 bags of gold coins. How much does Sam spend?

St. Patrick's Day Math · 7

One batch of a recipe uses $\frac{1}{2}$ cup of green sprinkles. Ben makes 3 batches. How many cups of green sprinkles does Ben use?

St. Patrick's Day Math · 8

A treasure box is 7 inches long, 4 inches wide and 4 inches tall. What is its volume in cubic inches?

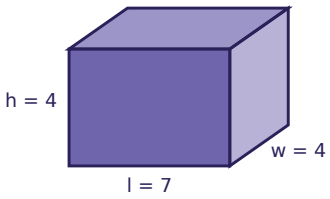

St. Patrick's Day Math · 2

ANSWER

$5.70

St. Patrick's Day Math · 1

ANSWER

$$\frac{1}{2}$$

St. Patrick's Day Math · 4

ANSWER

$2.05

St. Patrick's Day Math · 3

ANSWER

$35.40

St. Patrick's Day Math · 6

ANSWER

$10.00

St. Patrick's Day Math · 5

ANSWER

42

St. Patrick's Day Math · 8

ANSWER

112

St. Patrick's Day Math · 7

ANSWER

$$1\frac{1}{2}$$

St. Patrick's Day Math · 9

One shamrock plant costs $7.40. Leo buys 4 shamrock plants. How much does Leo spend?

St. Patrick's Day Math · 10

One green hat costs $7.65. Ava buys 5 green hats. How much does Ava spend?

St. Patrick's Day Math · 11

A treasure box is 4 inches long, 6 inches wide and 3 inches tall. What is its volume in cubic inches?

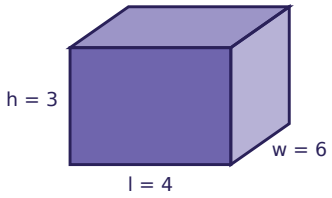

St. Patrick's Day Math · 12

One batch of a recipe uses $\frac{3}{4}$ cup of green sprinkles. Lily makes 2 batches. How many cups of green sprinkles does Lily use?

St. Patrick's Day Math · 13

Lily buys a green hat for $9.50 and pays with a $10 bill. How much change does Lily get?

St. Patrick's Day Math · 14

One batch of a recipe uses $\frac{1}{2}$ cup of green sprinkles. Ella makes 2 batches. How many cups of green sprinkles does Ella use?

St. Patrick's Day Math · 15

Ella buys a bag of gold coins for $2.95 and pays with a $10 bill. How much change does Ella get?

St. Patrick's Day Math · 16

A treasure box is 6 inches long, 3 inches wide and 5 inches tall. What is its volume in cubic inches?

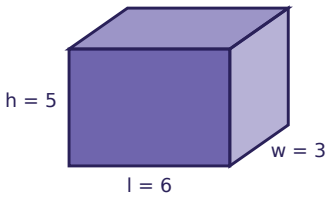

St. Patrick's Day Math · 10

ANSWER

$38.25

St. Patrick's Day Math · 9

ANSWER

$29.60

St. Patrick's Day Math · 12

ANSWER

$$1\frac{1}{2}$$

St. Patrick's Day Math · 11

ANSWER

72

St. Patrick's Day Math · 14

ANSWER

1

St. Patrick's Day Math · 13

ANSWER

$0.50

St. Patrick's Day Math · 16

ANSWER

90

St. Patrick's Day Math · 15

ANSWER

$7.05

St. Patrick's Day Math · 17

Ava buys a bag of gold coins for $3.00 and pays with a $10 bill. How much change does Ava get?

St. Patrick's Day Math · 18

One bag of gold coins costs $3.60. Noah buys 5 bags of gold coins. How much does Noah spend?

St. Patrick's Day Math · 19

One bag of gold coins costs $2.60. Noah buys 4 bags of gold coins. How much does Noah spend?

St. Patrick's Day Math · 20

A treasure box is 5 inches long, 3 inches wide and 2 inches tall. What is its volume in cubic inches?

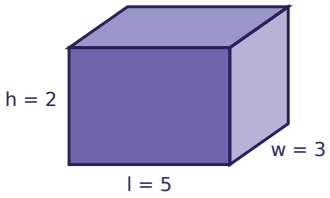

St. Patrick's Day Math · 21

Lily buys a shamrock plant for $9.30 and pays with a $10 bill. How much change does Lily get?

St. Patrick's Day Math · 22

One batch of a recipe uses $\frac{3}{4}$ cup of green sprinkles. Sam makes 2 batches. How many cups of green sprinkles does Sam use?

St. Patrick's Day Math · 23

One batch of a recipe uses $\frac{1}{4}$ cup of green sprinkles. Omar makes 3 batches. How many cups of green sprinkles does Omar use?

St. Patrick's Day Math · 24

A treasure box is 6 inches long, 5 inches wide and 4 inches tall. What is its volume in cubic inches?

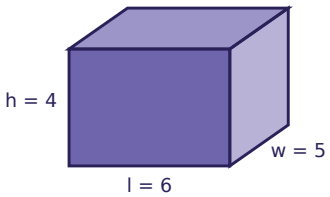

St. Patrick's Day Math · 18

ANSWER

$18.00

St. Patrick's Day Math · 17

ANSWER

$7.00

St. Patrick's Day Math · 20

ANSWER

30

St. Patrick's Day Math · 19

ANSWER

$10.40

St. Patrick's Day Math · 22

ANSWER

$$1\frac{1}{2}$$

St. Patrick's Day Math · 21

ANSWER

$0.70

St. Patrick's Day Math · 24

ANSWER

120

St. Patrick's Day Math · 23

ANSWER

$$\frac{3}{4}$$