Task card 1 Classifying Quadrilaterals & Trian...

Complete the sentence with always, sometimes, or never: A parallelogram is ___ a quadrilateral.

Task card 2 Classifying Quadrilaterals & Trian...

A quadrilateral has opposite sides that are parallel and equal, with 4 right angles and a length different from its width. What is its most specific name: square, rectangle, rhombus, parallelogram, or trapezoid?

Task card 3 Classifying Quadrilaterals & Trian...

Two angles of a triangle measure 43° and 112°. Classify the triangle by its angles: acute, right, or obtuse.

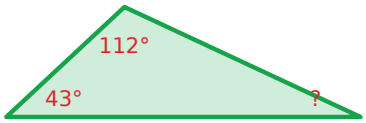

Task card 4 Classifying Quadrilaterals & Trian...

Complete the sentence with always, sometimes, or never: A pentagon is ___ a parallelogram.

Task card 5 Classifying Quadrilaterals & Trian...

A quadrilateral has 2 pairs of parallel sides, no right angles, and sides that are not all the same length. What is its most specific name: square, rectangle, rhombus, parallelogram, or trapezoid?

Task card 6 Classifying Quadrilaterals & Trian...

Two angles of a triangle measure 25° and 77°. What is the measure of the third angle, in degrees?



Task card 7 Classifying Quadrilaterals & Trian...

Complete the sentence with always, sometimes, or never: A trapezoid is ___ a triangle.

Task card 8 Classifying Quadrilaterals & Trian...

Two angles of a triangle measure 48° and 90°. Classify the triangle by its angles: acute, right, or obtuse.

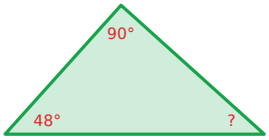

Task card 9 Classifying Quadrilaterals & Trian...

Complete the sentence with always, sometimes, or never: A parallelogram is ___ a rhombus.

Task card 10 Classifying Quadrilaterals & Trian...

Two angles of a triangle measure 45° and 35°. What is the measure of the third angle, in degrees?

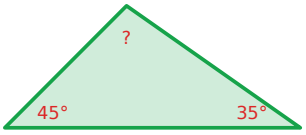

Task card 11 Classifying Quadrilaterals & Trian...

Complete the sentence with always, sometimes, or never: A square is ___ a parallelogram.

Task card 12 Classifying Quadrilaterals & Trian...

A quadrilateral has exactly 1 pair of parallel sides. What is its most specific name: square, rectangle, rhombus, parallelogram, or trapezoid?

Task card 13 Classifying Quadrilaterals & Trian...

Two angles of a triangle measure 24° and 58°. Classify the triangle by its angles: acute, right, or obtuse.



Task card 14 Classifying Quadrilaterals & Trian...

Complete the sentence with always, sometimes, or never: A rhombus is ___ a rectangle.

Task card 15 Classifying Quadrilaterals & Trian...

Two angles of a triangle measure 61° and 66°. Classify the triangle by its angles: acute, right, or obtuse.

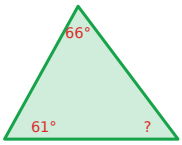

Task card 16 Classifying Quadrilaterals & Trian...

Complete the sentence with always, sometimes, or never: A parallelogram is ___ a rectangle.

Task card 17 Classifying Quadrilaterals & Trian...

A quadrilateral has 4 sides of equal length but no right angles. What is its most specific name: square, rectangle, rhombus, parallelogram, or trapezoid?

Task card 18 Classifying Quadrilaterals & Trian...

Two angles of a triangle measure 27° and 77°. Classify the triangle by its angles: acute, right, or obtuse.



Task card 19 Classifying Quadrilaterals & Trian...

Complete the sentence with always, sometimes, or never: A square is ___ a rhombus.

Task card 20 Classifying Quadrilaterals & Trian...

A quadrilateral has 4 sides of equal length and 4 right angles. What is its most specific name: square, rectangle, rhombus, parallelogram, or trapezoid?

Task card 21 Classifying Quadrilaterals & Trian...

Two angles of a triangle measure 23° and 118°. Classify the triangle by its angles: acute, right, or obtuse.

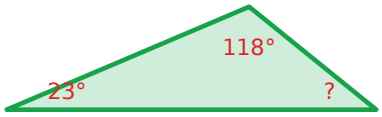

Task card 22 Classifying Quadrilaterals & Trian...

Complete the sentence with always, sometimes, or never: A rectangle is ___ a quadrilateral.

Task card 23 Classifying Quadrilaterals & Trian...

Two angles of a triangle measure 49° and 90°. Classify the triangle by its angles: acute, right, or obtuse.

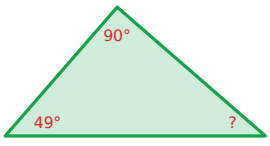

Task card 24 Classifying Quadrilaterals & Trian...

Two angles of a triangle measure 20° and 32°. Classify the triangle by its angles: acute, right, or obtuse.



Classifying Quadrilaterals & Triangles Task Cards

Recording sheet · Grade 5 · Answer each question with one of the words given.

Scan to check your answers

Name: _____ Date: _____

1	2	3	4
5	6	7	8
9	10	11	12
13	14	15	16
17	18	19	20
21	22	23	24

Classifying Quadrilaterals & Triangles Task Cards: Answer Key

Grade 5 · Medium

The answers online

1. always	**2.** rectangle	**3.** obtuse
4. never	**5.** parallelogram	**6.** 78
7. never	**8.** right	**9.** sometimes
10. 100	**11.** always	**12.** trapezoid
13. obtuse	**14.** sometimes	**15.** acute
16. sometimes	**17.** rhombus	**18.** acute
19. always	**20.** square	**21.** obtuse
22. always	**23.** right	**24.** obtuse