Task card 1 Classifying Quadrilaterals & Trian...

Complete the sentence with always, sometimes, or never: A parallelogram is ___ a quadrilateral.

Task card 2 Classifying Quadrilaterals & Trian...

A quadrilateral has exactly 1 pair of parallel sides. What is its most specific name: square, rectangle, rhombus, parallelogram, or trapezoid?

Task card 3 Classifying Quadrilaterals & Trian...

Two angles of a triangle measure 47° and 90°. What is the measure of the third angle, in degrees?

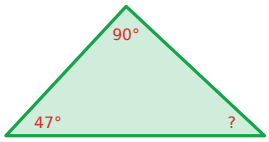

Task card 4 Classifying Quadrilaterals & Trian...

Complete the sentence with always, sometimes, or never: A pentagon is ___ a parallelogram.

Task card 5 Classifying Quadrilaterals & Trian...

A quadrilateral has opposite sides that are parallel and equal, with 4 right angles and a length different from its width. What is its most specific name: square, rectangle, rhombus, parallelogram, or trapezoid?

Task card 6 Classifying Quadrilaterals & Trian...

Two angles of a triangle measure 49° and 41°. Classify the triangle by its angles: acute, right, or obtuse.

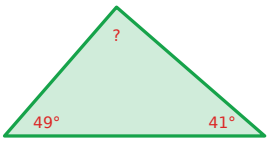

Task card 7 Classifying Quadrilaterals & Trian...

Complete the sentence with always, sometimes, or never: A rhombus is ___ a square.

Task card 8 Classifying Quadrilaterals & Trian...

Two angles of a triangle measure 23° and 90°. Classify the triangle by its angles: acute, right, or obtuse.



Task card 9 Classifying Quadrilaterals & Trian...

Complete the sentence with always, sometimes, or never: A square is ___ a parallelogram.

Task card 10 Classifying Quadrilaterals & Trian...

Two angles of a triangle measure 51° and 73°. Classify the triangle by its angles: acute, right, or obtuse.

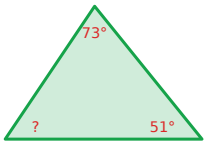

Task card 11 Classifying Quadrilaterals & Trian...

Complete the sentence with always, sometimes, or never: A rectangle is ___ a square.

Task card 12 Classifying Quadrilaterals & Trian...

A quadrilateral has 4 right angles, and its sides are not all the same length. What is its most specific name: square, rectangle, rhombus, parallelogram, or trapezoid?

Task card 13 Classifying Quadrilaterals & Trian...

Two angles of a triangle measure 28° and 90°. Classify the triangle by its angles: acute, right, or obtuse.



Task card 14 Classifying Quadrilaterals & Trian...

Two angles of a triangle measure 52° and 56°. Classify the triangle by its angles: acute, right, or obtuse.

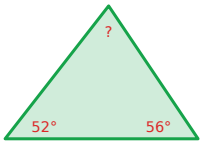

Task card 15 Classifying Quadrilaterals & Trian...

Complete the sentence with always, sometimes, or never: A rectangle is ___ a parallelogram.

Task card 16 Classifying Quadrilaterals & Trian...

Two angles of a triangle measure 59° and 58°. What is the measure of the third angle, in degrees?

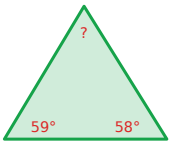

Task card 17 Classifying Quadrilaterals & Trian...

Complete the sentence with always, sometimes, or never: A trapezoid is ___ a triangle.

Task card 18 Classifying Quadrilaterals & Trian...

A quadrilateral has 4 sides of equal length but no right angles. What is its most specific name: square, rectangle, rhombus, parallelogram, or trapezoid?

Task card 19 Classifying Quadrilaterals & Trian...

Two angles of a triangle measure 17° and 73°. What is the measure of the third angle, in degrees?



Task card 20 Classifying Quadrilaterals & Trian...

Complete the sentence with always, sometimes, or never: A quadrilateral is ___ a parallelogram.

Task card 21 Classifying Quadrilaterals & Trian...

Two angles of a triangle measure 62° and 40°. What is the measure of the third angle, in degrees?

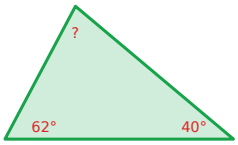

Task card 22 Classifying Quadrilaterals & Trian...

Complete the sentence with always, sometimes, or never: A rectangle is ___ a quadrilateral.

Task card 23 Classifying Quadrilaterals & Trian...

A quadrilateral has 2 pairs of parallel sides and 4 equal sides, and all of its angles are 90°. What is its most specific name: square, rectangle, rhombus, parallelogram, or trapezoid?

Task card 24 Classifying Quadrilaterals & Trian...

Two angles of a triangle measure 29° and 130°. Classify the triangle by its angles: acute, right, or obtuse.



Classifying Quadrilaterals & Triangles Task Cards

Recording sheet · Grade 5 · Answer each question with one of the words given.

Scan to check your answers

Name: _____ Date: _____

1	2	3	4
5	6	7	8
9	10	11	12
13	14	15	16
17	18	19	20
21	22	23	24

Classifying Quadrilaterals & Triangles Task Cards: Answer Key

Grade 5 · Hard

The answers online

1. always	**2.** trapezoid	**3.** 43
4. never	**5.** rectangle	**6.** right
7. sometimes	**8.** right	**9.** always
10. acute	**11.** sometimes	**12.** rectangle
13. right	**14.** acute	**15.** always
16. 63	**17.** never	**18.** rhombus
19. 90	**20.** sometimes	**21.** 78
22. always	**23.** square	**24.** obtuse