Task card 1 Classifying Quadrilaterals & Trian...

Complete the sentence with always, sometimes, or never: A parallelogram is ___ a rectangle.

Task card 2 Classifying Quadrilaterals & Trian...

A quadrilateral has 2 pairs of parallel sides and 4 equal sides, and all of its angles are 90°. What is its most specific name: square, rectangle, rhombus, parallelogram, or trapezoid?

Task card 3 Classifying Quadrilaterals & Trian...

Two angles of a triangle measure 25° and 121°. Classify the triangle by its angles: acute, right, or obtuse.



Task card 4 Classifying Quadrilaterals & Trian...

Complete the sentence with always, sometimes, or never: A parallelogram is ___ a quadrilateral.

Task card 5 Classifying Quadrilaterals & Trian...

A quadrilateral has exactly 1 pair of parallel sides. What is its most specific name: square, rectangle, rhombus, parallelogram, or trapezoid?

Task card 6 Classifying Quadrilaterals & Trian...

Two angles of a triangle measure 15° and 90°. Classify the triangle by its angles: acute, right, or obtuse.



Task card 7 Classifying Quadrilaterals & Trian...

Complete the sentence with always, sometimes, or never: A square is ___ a rectangle.

Task card 8 Classifying Quadrilaterals & Trian...

Two angles of a triangle measure 18° and 127°. Classify the triangle by its angles: acute, right, or obtuse.



Task card 9 Classifying Quadrilaterals & Trian...

Complete the sentence with always, sometimes, or never: A triangle is ___ a quadrilateral.

Task card 10 Classifying Quadrilaterals & Trian...

Two angles of a triangle measure 35° and 107°. Classify the triangle by its angles: acute, right, or obtuse.

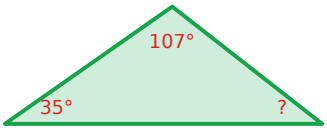

Task card 11 Classifying Quadrilaterals & Trian...

Complete the sentence with always, sometimes, or never: A parallelogram is ___ a rhombus.

Task card 12 Classifying Quadrilaterals & Trian...

A quadrilateral has 2 pairs of parallel sides, no right angles, and sides that are not all the same length. What is its most specific name: square, rectangle, rhombus, parallelogram, or trapezoid?

Task card 13 Classifying Quadrilaterals & Trian...

Two angles of a triangle measure 26° and 23°. Classify the triangle by its angles: acute, right, or obtuse.



Task card 14 Classifying Quadrilaterals & Trian...

Complete the sentence with always, sometimes, or never: A quadrilateral is ___ a parallelogram.

Task card 15 Classifying Quadrilaterals & Trian...

Two angles of a triangle measure 44° and 60°. Classify the triangle by its angles: acute, right, or obtuse.

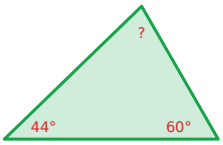

Task card 16 Classifying Quadrilaterals & Trian...

Complete the sentence with always, sometimes, or never: A square is ___ a parallelogram.

Task card 17 Classifying Quadrilaterals & Trian...

Two angles of a triangle measure 35° and 22°. Classify the triangle by its angles: acute, right, or obtuse.



Task card 18 Classifying Quadrilaterals & Trian...

Complete the sentence with always, sometimes, or never: A square is ___ a rhombus.

Task card 19 Classifying Quadrilaterals & Trian...

A quadrilateral has opposite sides that are parallel and equal, with 4 right angles and a length different from its width. What is its most specific name: square, rectangle, rhombus, parallelogram, or trapezoid?

Task card 20 Classifying Quadrilaterals & Trian...

Two angles of a triangle measure 15° and 118°. Classify the triangle by its angles: acute, right, or obtuse.



Task card 21 Classifying Quadrilaterals & Trian...

Two angles of a triangle measure 41° and 49°. Classify the triangle by its angles: acute, right, or obtuse.

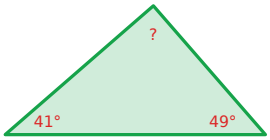

Task card 22 Classifying Quadrilaterals & Trian...

A quadrilateral has 4 sides of equal length and 4 right angles. What is its most specific name: square, rectangle, rhombus, parallelogram, or trapezoid?

Task card 23 Classifying Quadrilaterals & Trian...

Two angles of a triangle measure 25° and 90°. Classify the triangle by its angles: acute, right, or obtuse.



Task card 24 Classifying Quadrilaterals & Trian...

A quadrilateral is a parallelogram with 4 equal sides and angles of 70° and 110°. What is its most specific name: square, rectangle, rhombus, parallelogram, or trapezoid?

Classifying Quadrilaterals & Triangles Task Cards

Recording sheet · Grade 5 · Answer each question with one of the words given.

Scan to check your answers

Name: _____ Date: _____

1	2	3	4
5	6	7	8
9	10	11	12
13	14	15	16
17	18	19	20
21	22	23	24

Classifying Quadrilaterals & Triangles Task Cards: Answer Key

Grade 5 · Easy

The answers online

1. sometimes	**2.** square	**3.** obtuse
4. always	**5.** trapezoid	**6.** right
7. always	**8.** obtuse	**9.** never
10. obtuse	**11.** sometimes	**12.** parallelogram
13. obtuse	**14.** sometimes	**15.** acute
16. always	**17.** obtuse	**18.** always
19. rectangle	**20.** obtuse	**21.** right
22. square	**23.** right	**24.** rhombus