Classifying Quadrilaterals & Triangles · 1

Complete the sentence with always, sometimes, or never: A parallelogram is ___ a quadrilateral.

Classifying Quadrilaterals & Triangles · 2

A quadrilateral has exactly 1 pair of parallel sides. What is its most specific name: square, rectangle, rhombus, parallelogram, or trapezoid?

Classifying Quadrilaterals & Triangles · 3

Two angles of a triangle measure 47° and 90°. What is the measure of the third angle, in degrees?

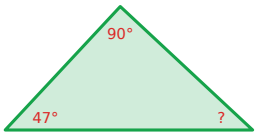

Classifying Quadrilaterals & Triangles · 4

Complete the sentence with always, sometimes, or never: A pentagon is ___ a parallelogram.

Classifying Quadrilaterals & Triangles · 5

A quadrilateral has opposite sides that are parallel and equal, with 4 right angles and a length different from its width. What is its most specific name: square, rectangle, rhombus, parallelogram, or trapezoid?

Classifying Quadrilaterals & Triangles · 6

Two angles of a triangle measure 49° and 41°. Classify the triangle by its angles: acute, right, or obtuse.

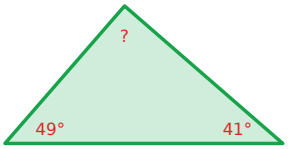

Classifying Quadrilaterals & Triangles · 7

Complete the sentence with always, sometimes, or never: A rhombus is ___ a square.

Classifying Quadrilaterals & Triangles · 8

Two angles of a triangle measure 23° and 90°. Classify the triangle by its angles: acute, right, or obtuse.



Classifying Quadrilaterals & Triangles · 2

ANSWER

trapezoid

Classifying Quadrilaterals & Triangles · 1

ANSWER

always

Classifying Quadrilaterals & Triangles · 4

ANSWER

never

Classifying Quadrilaterals & Triangles · 3

ANSWER

43

Classifying Quadrilaterals & Triangles · 6

ANSWER

right

Classifying Quadrilaterals & Triangles · 5

ANSWER

rectangle

Classifying Quadrilaterals & Triangles · 8

ANSWER

right

Classifying Quadrilaterals & Triangles · 7

ANSWER

sometimes

Classifying Quadrilaterals & Triangles · 9

Complete the sentence with always, sometimes, or never: A square is ___ a parallelogram.

Classifying Quadrilaterals & Triangles · 10

Two angles of a triangle measure 51° and 73°. Classify the triangle by its angles: acute, right, or obtuse.

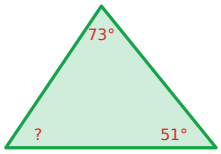

Classifying Quadrilaterals & Triangles · 11

Complete the sentence with always, sometimes, or never: A rectangle is ___ a square.

Classifying Quadrilaterals & Triangles · 12

A quadrilateral has 4 right angles, and its sides are not all the same length. What is its most specific name: square, rectangle, rhombus, parallelogram, or trapezoid?

Classifying Quadrilaterals & Triangles · 13

Two angles of a triangle measure 28° and 90°. Classify the triangle by its angles: acute, right, or obtuse.

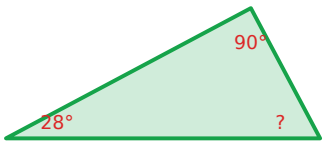

Classifying Quadrilaterals & Triangles · 14

Two angles of a triangle measure 52° and 56°. Classify the triangle by its angles: acute, right, or obtuse.

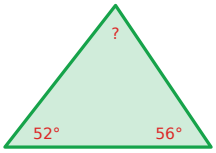

Classifying Quadrilaterals & Triangles · 15

Complete the sentence with always, sometimes, or never: A rectangle is ___ a parallelogram.

Classifying Quadrilaterals & Triangles · 16

Two angles of a triangle measure 59° and 58°. What is the measure of the third angle, in degrees?

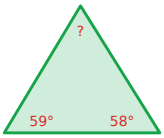

Classifying Quadrilaterals & Triangles · 10

ANSWER

acute

Classifying Quadrilaterals & Triangles · 9

ANSWER

always

Classifying Quadrilaterals & Triangles · 12

ANSWER

rectangle

Classifying Quadrilaterals & Triangles · 11

ANSWER

sometimes

Classifying Quadrilaterals & Triangles · 14

ANSWER

acute

Classifying Quadrilaterals & Triangles · 13

ANSWER

right

Classifying Quadrilaterals & Triangles · 16

ANSWER

63

Classifying Quadrilaterals & Triangles · 15

ANSWER

always

Complete the sentence with always, sometimes, or never: A trapezoid is ___ a triangle.

A quadrilateral has 4 sides of equal length but no right angles. What is its most specific name: square, rectangle, rhombus, parallelogram, or trapezoid?

Two angles of a triangle measure 17° and 73°. What is the measure of the third angle, in degrees?



Complete the sentence with always, sometimes, or never: A quadrilateral is ___ a parallelogram.

Two angles of a triangle measure 62° and 40°. What is the measure of the third angle, in degrees?

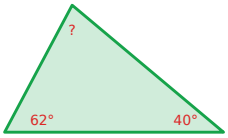

Complete the sentence with always, sometimes, or never: A rectangle is ___ a quadrilateral.

A quadrilateral has 2 pairs of parallel sides and 4 equal sides, and all of its angles are 90°. What is its most specific name: square, rectangle, rhombus, parallelogram, or trapezoid?

Two angles of a triangle measure 29° and 130°. Classify the triangle by its angles: acute, right, or obtuse.

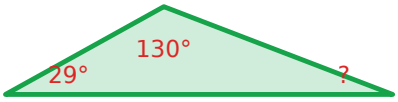

Classifying Quadrilaterals & Triangles · 18

ANSWER

rhombus

Classifying Quadrilaterals & Triangles · 17

ANSWER

never

Classifying Quadrilaterals & Triangles · 20

ANSWER

sometimes

Classifying Quadrilaterals & Triangles · 19

ANSWER

90

Classifying Quadrilaterals & Triangles · 22

ANSWER

always

Classifying Quadrilaterals & Triangles · 21

ANSWER

78

Classifying Quadrilaterals & Triangles · 24

ANSWER

obtuse

Classifying Quadrilaterals & Triangles · 23

ANSWER

square