Classifying Quadrilaterals & Triangles · 1

Complete the sentence with always, sometimes, or never: A parallelogram is ___ a rectangle.

Classifying Quadrilaterals & Triangles · 2

A quadrilateral has 2 pairs of parallel sides and 4 equal sides, and all of its angles are 90°. What is its most specific name: square, rectangle, rhombus, parallelogram, or trapezoid?

Classifying Quadrilaterals & Triangles · 3

Two angles of a triangle measure 25° and 121°. Classify the triangle by its angles: acute, right, or obtuse.

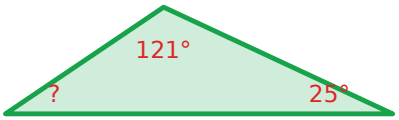


Classifying Quadrilaterals & Triangles · 4

Complete the sentence with always, sometimes, or never: A parallelogram is ___ a quadrilateral.

Classifying Quadrilaterals & Triangles · 5

A quadrilateral has exactly 1 pair of parallel sides. What is its most specific name: square, rectangle, rhombus, parallelogram, or trapezoid?

Classifying Quadrilaterals & Triangles · 6

Two angles of a triangle measure 15° and 90°. Classify the triangle by its angles: acute, right, or obtuse.




Classifying Quadrilaterals & Triangles · 7

Complete the sentence with always, sometimes, or never: A square is ___ a rectangle.

Classifying Quadrilaterals & Triangles · 8

Two angles of a triangle measure 18° and 127°. Classify the triangle by its angles: acute, right, or obtuse.



Classifying Quadrilaterals & Triangles · 2

**ANSWER**

# square

Classifying Quadrilaterals & Triangles · 1

**ANSWER**

# sometimes

Classifying Quadrilaterals & Triangles · 4

**ANSWER**

# always

Classifying Quadrilaterals & Triangles · 3

**ANSWER**

# obtuse

Classifying Quadrilaterals & Triangles · 6

**ANSWER**

# right

Classifying Quadrilaterals & Triangles · 5

**ANSWER**

# trapezoid

Classifying Quadrilaterals & Triangles · 8

**ANSWER**

# obtuse

Classifying Quadrilaterals & Triangles · 7

**ANSWER**

# always

Classifying Quadrilaterals & Triangles · 9

Complete the sentence with always, sometimes, or never: A triangle is ___ a quadrilateral.

Classifying Quadrilaterals & Triangles · 10

Two angles of a triangle measure 35° and 107°. Classify the triangle by its angles: acute, right, or obtuse.

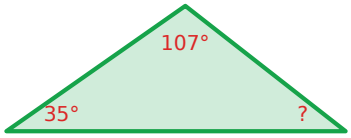


Classifying Quadrilaterals & Triangles · 11

Complete the sentence with always, sometimes, or never: A parallelogram is ___ a rhombus.

Classifying Quadrilaterals & Triangles · 12

A quadrilateral has 2 pairs of parallel sides, no right angles, and sides that are not all the same length. What is its most specific name: square, rectangle, rhombus, parallelogram, or trapezoid?

Classifying Quadrilaterals & Triangles · 13

Two angles of a triangle measure 26° and 23°. Classify the triangle by its angles: acute, right, or obtuse.




Classifying Quadrilaterals & Triangles · 14

Complete the sentence with always, sometimes, or never: A quadrilateral is ___ a parallelogram.

Classifying Quadrilaterals & Triangles · 15

Two angles of a triangle measure 44° and 60°. Classify the triangle by its angles: acute, right, or obtuse.

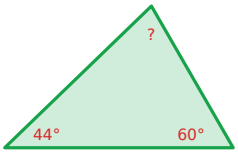


Classifying Quadrilaterals & Triangles · 16

Complete the sentence with always, sometimes, or never: A square is ___ a parallelogram.

Classifying Quadrilaterals & Triangles · 10

**ANSWER**

# obtuse

Classifying Quadrilaterals & Triangles · 9

**ANSWER**

# never

Classifying Quadrilaterals & Triangles · 12

**ANSWER**

# parallelogram

Classifying Quadrilaterals & Triangles · 11

**ANSWER**

# sometimes

Classifying Quadrilaterals & Triangles · 14

**ANSWER**

# sometimes

Classifying Quadrilaterals & Triangles · 13

**ANSWER**

# obtuse

Classifying Quadrilaterals & Triangles · 16

**ANSWER**

# always

Classifying Quadrilaterals & Triangles · 15

**ANSWER**

# acute

Classifying Quadrilaterals & Triangles · 17

Two angles of a triangle measure 35° and 22°. Classify the triangle by its angles: acute, right, or obtuse.




Classifying Quadrilaterals & Triangles · 18

Complete the sentence with always, sometimes, or never: A square is ___ a rhombus.

Classifying Quadrilaterals & Triangles · 19

A quadrilateral has opposite sides that are parallel and equal, with 4 right angles and a length different from its width. What is its most specific name: square, rectangle, rhombus, parallelogram, or trapezoid?

Classifying Quadrilaterals & Triangles · 20

Two angles of a triangle measure 15° and 118°. Classify the triangle by its angles: acute, right, or obtuse.




Classifying Quadrilaterals & Triangles · 21

Two angles of a triangle measure 41° and 49°. Classify the triangle by its angles: acute, right, or obtuse.

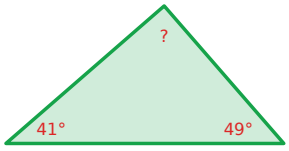


Classifying Quadrilaterals & Triangles · 22

A quadrilateral has 4 sides of equal length and 4 right angles. What is its most specific name: square, rectangle, rhombus, parallelogram, or trapezoid?

Classifying Quadrilaterals & Triangles · 23

Two angles of a triangle measure 25° and 90°. Classify the triangle by its angles: acute, right, or obtuse.

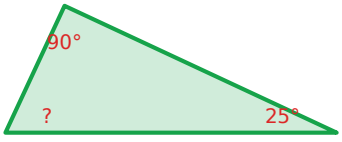


Classifying Quadrilaterals & Triangles · 24

A quadrilateral is a parallelogram with 4 equal sides and angles of 70° and 110°. What is its most specific name: square, rectangle, rhombus, parallelogram, or trapezoid?

Classifying Quadrilaterals & Triangles · 18

**ANSWER**

# always

Classifying Quadrilaterals & Triangles · 17

**ANSWER**

# obtuse

Classifying Quadrilaterals & Triangles · 20

**ANSWER**

# obtuse

Classifying Quadrilaterals & Triangles · 19

**ANSWER**

# rectangle

Classifying Quadrilaterals & Triangles · 22

**ANSWER**

# square

Classifying Quadrilaterals & Triangles · 21

**ANSWER**

# right

Classifying Quadrilaterals & Triangles · 24

**ANSWER**

# rhombus

Classifying Quadrilaterals & Triangles · 23

**ANSWER**

# right