Task card 1 Multiplying Decimals with Hundredt...

The pink columns show 1.2 and the blue rows show 0.6. Count the dark squares, which are shaded twice: 1.2 × 0.6 = ___

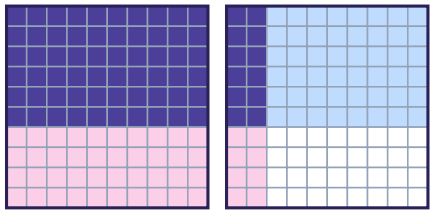

Task card 2 Multiplying Decimals with Hundredt...

The pink columns show 1.4 and the blue rows show 0.3. Count the dark squares, which are shaded twice: 1.4 × 0.3 = ___

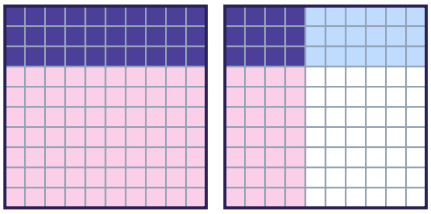

Task card 3 Multiplying Decimals with Hundredt...

The pink columns show 1.5 and the blue rows show 0.4. Count the dark squares, which are shaded twice: 1.5 × 0.4 = ___

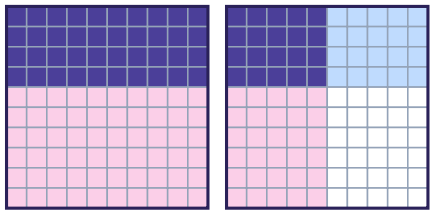

Task card 4 Multiplying Decimals with Hundredt...

The pink columns show 1.2 and the blue rows show 0.9. Count the dark squares, which are shaded twice: 1.2 × 0.9 = ___

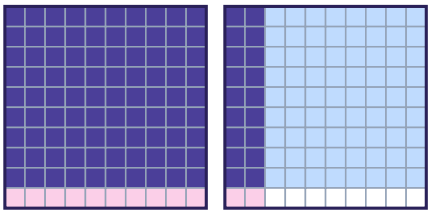

Task card 5 Multiplying Decimals with Hundredt...

The pink columns show 1.9 and the blue rows show 0.5. Count the dark squares, which are shaded twice: 1.9 × 0.5 = ___

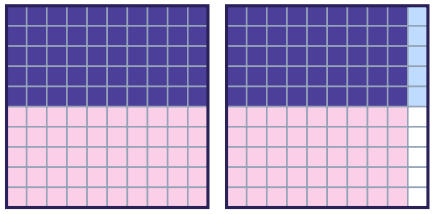

Task card 6 Multiplying Decimals with Hundredt...

The pink columns show 1.6 and the blue rows show 0.2. Count the dark squares, which are shaded twice: 1.6 × 0.2 = ___

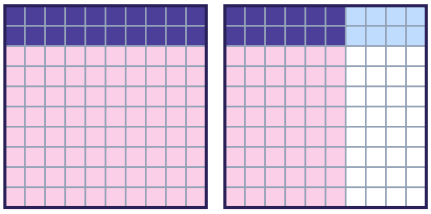

Task card 7 Multiplying Decimals with Hundredt...

The pink columns show 1.9 and the blue rows show 0.7. Count the dark squares, which are shaded twice: 1.9 × 0.7 = ___

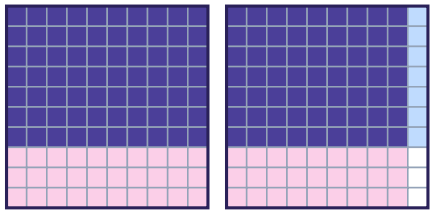

Task card 8 Multiplying Decimals with Hundredt...

The pink columns show 1.1 and the blue rows show 0.5. Count the dark squares, which are shaded twice: 1.1 × 0.5 = ___

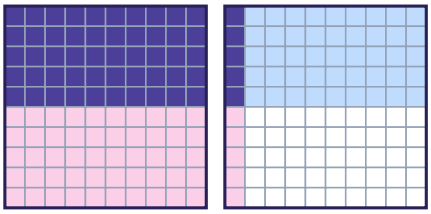

Task card 9 Multiplying Decimals with Hundredt...

The pink columns show 1.7 and the blue rows show 0.5. Count the dark squares, which are shaded twice: 1.7 × 0.5 = ___

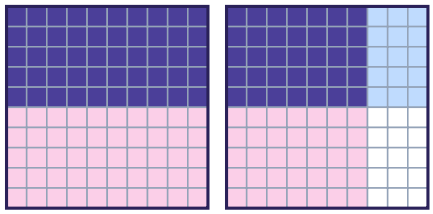

Task card 10 Multiplying Decimals with Hundredt...

The pink columns show 1.4 and the blue rows show 0.2. Count the dark squares, which are shaded twice: 1.4 × 0.2 = ___

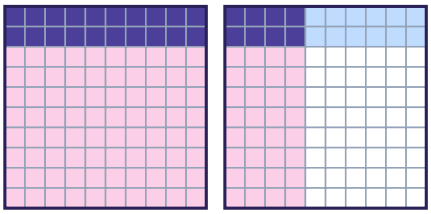

Task card 11 Multiplying Decimals with Hundredt...

The pink columns show 1.8 and the blue rows show 0.4. Count the dark squares, which are shaded twice: 1.8 × 0.4 = ___

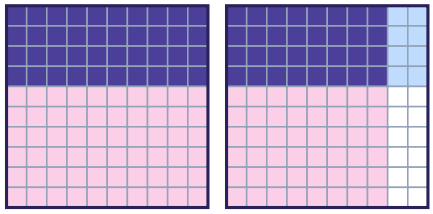

Multiplying Decimals with Hundredths Grids Task Cards

Recording sheet · Grade 5 · On blank grids, shade columns for the first number and rows for the second number in another color. The squares shaded twice show the product. When the grids are already shaded, read the numbers from the picture.

Scan to check your answers

Name: _____ Date: _____

1	2	3	4
5	6	7	8
9	10	11	

Multiplying Decimals with Hundredths Grids Task Cards: Answer Key

Grade 5 · Hard

The answers online

1. 0.72	**2.** 0.42	**3.** 0.6
4. 1.08	**5.** 0.95	**6.** 0.32
7. 1.33	**8.** 0.55	**9.** 0.85
10. 0.28	**11.** 0.72	