Task card 1 Multiplying Decimals with Hundredt...

The pink columns show 0.4 and the blue rows show 0.2. Count the dark squares, which are shaded twice: 0.4 × 0.2 = ___

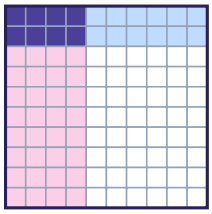

Task card 2 Multiplying Decimals with Hundredt...

The blue rows show 0.2 and the dark squares show 0.1. What number do the pink columns show? ___ × 0.2 = 0.1

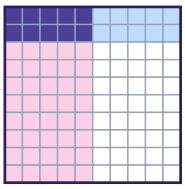

Task card 3 Multiplying Decimals with Hundredt...

The blue rows show 0.7 and the dark squares show 0.21. What number do the pink columns show? ___ × 0.7 = 0.21



Task card 4 Multiplying Decimals with Hundredt...

The pink columns show 0.4 and the blue rows show 0.3. Count the dark squares, which are shaded twice: 0.4 × 0.3 = ___



Task card 5 Multiplying Decimals with Hundredt...

The blue rows show 0.2 and the dark squares show 0.06. What number do the pink columns show? ___ × 0.2 = 0.06

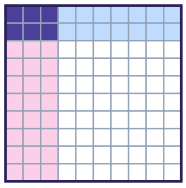

Task card 6 Multiplying Decimals with Hundredt...

The pink columns show 0.1 and the blue rows show 0.2. Count the dark squares, which are shaded twice: 0.1 × 0.2 = ___

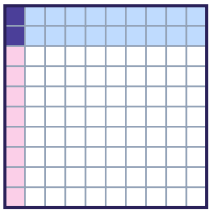

Task card 7 Multiplying Decimals with Hundredt...

The blue rows show 0.1 and the dark squares show 0.04. What number do the pink columns show? ___ × 0.1 = 0.04

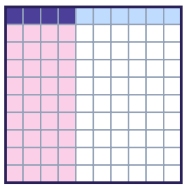

Task card 8 Multiplying Decimals with Hundredt...

The pink columns show 0.2 and the blue rows show 0.1. Count the dark squares, which are shaded twice: 0.2 × 0.1 = ___

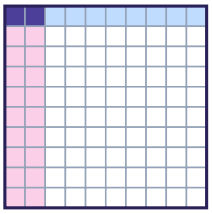

Task card 9 Multiplying Decimals with Hundredt...

The blue rows show 0.4 and the dark squares show 0.12. What number do the pink columns show? ___ × 0.4 = 0.12



Task card 10 Multiplying Decimals with Hundredt...

The pink columns show 0.8 and the blue rows show 0.5. Count the dark squares, which are shaded twice: 0.8 × 0.5 = ___

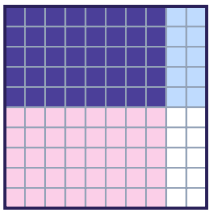

Task card 11 Multiplying Decimals with Hundredt...

The blue rows show 0.7 and the dark squares show 0.28. What number do the pink columns show? ___ × 0.7 = 0.28



Task card 12 Multiplying Decimals with Hundredt...

The pink columns show 0.5 and the blue rows show 0.2. Count the dark squares, which are shaded twice: 0.5 × 0.2 = ___

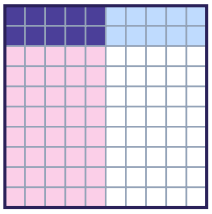

Task card 13 Multiplying Decimals with Hundredt...

The blue rows show 0.1 and the dark squares show 0.05. What number do the pink columns show? ___ × 0.1 = 0.05

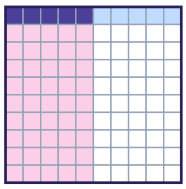

Task card 14 Multiplying Decimals with Hundredt...

The pink columns show 0.5 and the blue rows show 0.3. Count the dark squares, which are shaded twice: 0.5 × 0.3 = ___



Task card 15 Multiplying Decimals with Hundredt...

The blue rows show 0.4 and the dark squares show 0.16. What number do the pink columns show? ___ × 0.4 = 0.16



Task card 16 Multiplying Decimals with Hundredt...

The pink columns show 0.2 and the blue rows show 0.4. Count the dark squares, which are shaded twice: 0.2 × 0.4 = ___



Task card 17 Multiplying Decimals with Hundredt...

The blue rows show 0.5 and the dark squares show 0.25. What number do the pink columns show? ___ × 0.5 = 0.25



Task card 18 Multiplying Decimals with Hundredt...

The pink columns show 0.4 and the blue rows show 0.4. Count the dark squares, which are shaded twice: 0.4 × 0.4 = ___



Task card 19 Multiplying Decimals with Hundredt...

The pink columns show 0.4 and the blue rows show 0.5. Count the dark squares, which are shaded twice: 0.4 × 0.5 = ___



Task card 20 Multiplying Decimals with Hundredt...

The pink columns show 0.7 and the blue rows show 0.7. Count the dark squares, which are shaded twice: 0.7 × 0.7 = ___



Task card 21 Multiplying Decimals with Hundredt...

The blue rows show 0.8 and the dark squares show 0.72. What number do the pink columns show? ___ × 0.8 = 0.72

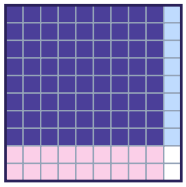

Multiplying Decimals with Hundredths Grids Task Cards

Recording sheet · Grade 5 · On blank grids, shade columns for the first number and rows for the second number in another color. The squares shaded twice show the product. When the grids are already shaded, read the numbers from the picture.

Scan to check your answers

Name: _____ Date: _____

1	2	3	4
5	6	7	8
9	10	11	12
13	14	15	16
17	18	19	20
21			

Multiplying Decimals with Hundredths Grids Task Cards: Answer Key

Grade 5 · Easy

The answers online

1. 0.08	**2.** 0.5	**3.** 0.3
4. 0.12	**5.** 0.3	**6.** 0.02
7. 0.4	**8.** 0.02	**9.** 0.3
10. 0.4	**11.** 0.4	**12.** 0.1
13. 0.5	**14.** 0.15	**15.** 0.4
16. 0.08	**17.** 0.5	**18.** 0.16
19. 0.2	**20.** 0.49	**21.** 0.9