Multiplying Decimals with Hundredths Grids · 1

The pink columns show 0.9 and the blue rows show 0.6. Count the dark squares, which are shaded twice: 0.9 × 0.6 = ___

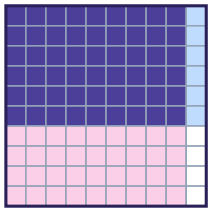

Multiplying Decimals with Hundredths Grids · 2

The blue rows show 0.4 and the dark squares show 0.56. What number do the pink columns show? ___ × 0.4 = 0.56

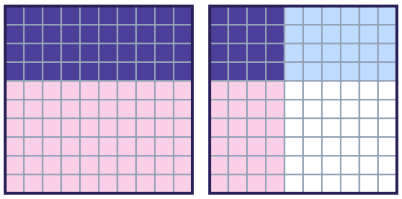

Multiplying Decimals with Hundredths Grids · 3

The pink columns show 0.2 and the blue rows show 0.9. Count the dark squares, which are shaded twice: 0.2 × 0.9 = ___

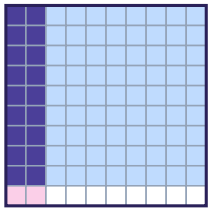

Multiplying Decimals with Hundredths Grids · 4

The blue rows show 0.6 and the dark squares show 0.78. What number do the pink columns show? ___ × 0.6 = 0.78

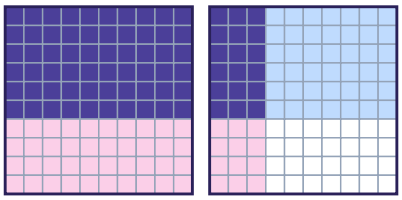

Multiplying Decimals with Hundredths Grids · 5

The pink columns show 1.3 and the blue rows show 0.6. Count the dark squares, which are shaded twice: 1.3 × 0.6 = ___

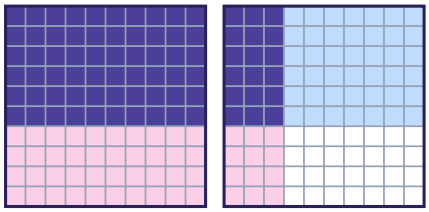

Multiplying Decimals with Hundredths Grids · 6

The blue rows show 0.2 and the dark squares show 0.3. What number do the pink columns show? ___ × 0.2 = 0.3

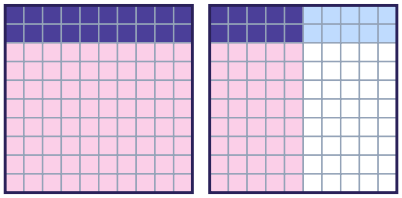

Multiplying Decimals with Hundredths Grids · 7

The pink columns show 0.3 and the blue rows show 0.3. Count the dark squares, which are shaded twice: 0.3 × 0.3 = ___

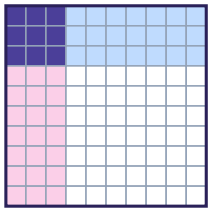

Multiplying Decimals with Hundredths Grids · 8

The pink columns show 0.8 and the blue rows show 0.8. Count the dark squares, which are shaded twice: 0.8 × 0.8 = ___

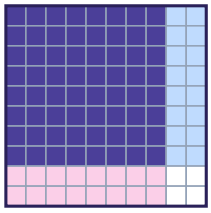

Multiplying Decimals with Hundredths Grids · 2

ANSWER

1.4

Multiplying Decimals with Hundredths Grids · 1

ANSWER

0.54

Multiplying Decimals with Hundredths Grids · 4

ANSWER

1.3

Multiplying Decimals with Hundredths Grids · 3

ANSWER

0.18

Multiplying Decimals with Hundredths Grids · 6

ANSWER

1.5

Multiplying Decimals with Hundredths Grids · 5

ANSWER

0.78

Multiplying Decimals with Hundredths Grids · 8

ANSWER

0.64

Multiplying Decimals with Hundredths Grids · 7

ANSWER

0.09

Multiplying Decimals with Hundredths Grids · 9

The blue rows show 0.7 and the dark squares show 1.19. What number do the pink columns show? ___ × 0.7 = 1.19

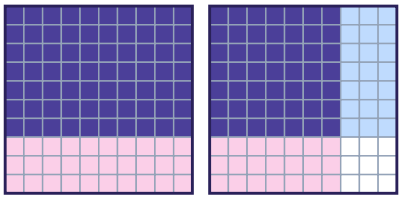

Multiplying Decimals with Hundredths Grids · 10

The pink columns show 1.8 and the blue rows show 0.3. Count the dark squares, which are shaded twice: 1.8 × 0.3 = ___

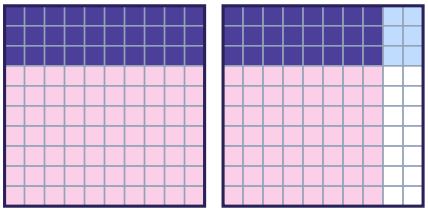

Multiplying Decimals with Hundredths Grids · 11

The blue rows show 0.3 and the dark squares show 0.51. What number do the pink columns show? ___ × 0.3 = 0.51

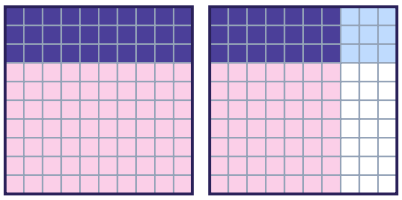

Multiplying Decimals with Hundredths Grids · 12

The pink columns show 0.5 and the blue rows show 0.4. Count the dark squares, which are shaded twice: 0.5 × 0.4 = ___



Multiplying Decimals with Hundredths Grids · 13

The blue rows show 0.3 and the dark squares show 0.39. What number do the pink columns show? ___ × 0.3 = 0.39

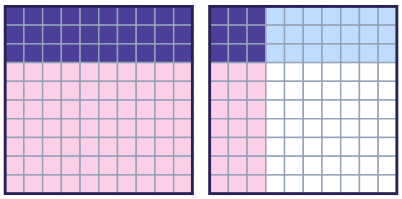

Multiplying Decimals with Hundredths Grids · 14

The pink columns show 0.4 and the blue rows show 0.6. Count the dark squares, which are shaded twice: 0.4 × 0.6 = ___



Multiplying Decimals with Hundredths Grids · 15

The blue rows show 0.9 and the dark squares show 1.44. What number do the pink columns show? ___ × 0.9 = 1.44

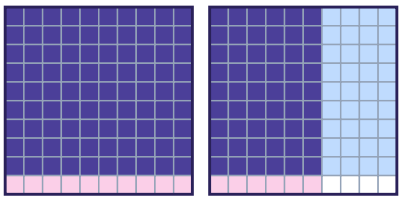

Multiplying Decimals with Hundredths Grids · 16

The pink columns show 1.1 and the blue rows show 0.2. Count the dark squares, which are shaded twice: 1.1 × 0.2 = ___

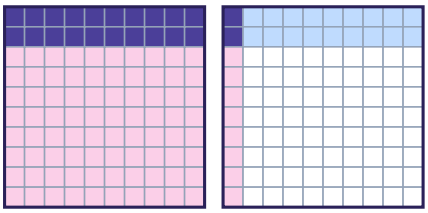

Multiplying Decimals with Hundredths Grids · 10

ANSWER

0.54

Multiplying Decimals with Hundredths Grids · 9

ANSWER

1.7

Multiplying Decimals with Hundredths Grids · 12

ANSWER

0.2

Multiplying Decimals with Hundredths Grids · 11

ANSWER

1.7

Multiplying Decimals with Hundredths Grids · 14

ANSWER

0.24

Multiplying Decimals with Hundredths Grids · 13

ANSWER

1.3

Multiplying Decimals with Hundredths Grids · 16

ANSWER

0.22

Multiplying Decimals with Hundredths Grids · 15

ANSWER

1.6

Multiplying Decimals with Hundredths Grids · 17

The blue rows show 0.4 and the dark squares show 0.64. What number do the pink columns show? ___ × 0.4 = 0.64

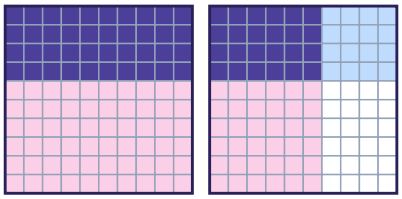

Multiplying Decimals with Hundredths Grids · 18

The pink columns show 0.2 and the blue rows show 0.6. Count the dark squares, which are shaded twice: 0.2 × 0.6 = ___

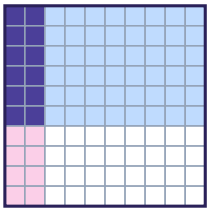

Multiplying Decimals with Hundredths Grids · 19

The blue rows show 0.8 and the dark squares show 1.12. What number do the pink columns show? ___ × 0.8 = 1.12

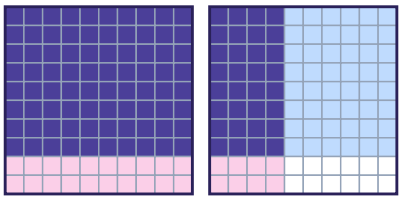

Multiplying Decimals with Hundredths Grids · 20

The pink columns show 0.3 and the blue rows show 0.6. Count the dark squares, which are shaded twice: 0.3 × 0.6 = ___



Multiplying Decimals with Hundredths Grids · 21

The blue rows show 0.6 and the dark squares show 0.96. What number do the pink columns show? ___ × 0.6 = 0.96

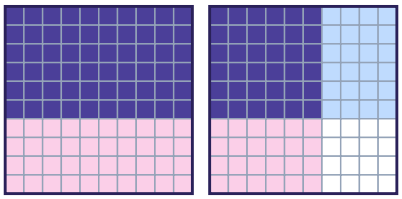

Multiplying Decimals with Hundredths Grids · 22

The pink columns show 1.2 and the blue rows show 0.4. Count the dark squares, which are shaded twice: 1.2 × 0.4 = ___

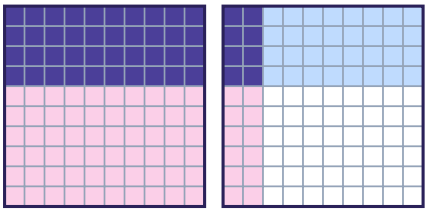

Multiplying Decimals with Hundredths Grids · 23

The blue rows show 0.6 and the dark squares show 0.72. What number do the pink columns show? ___ × 0.6 = 0.72

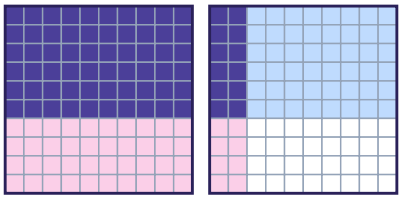

Multiplying Decimals with Hundredths Grids · 18

ANSWER

0.12

Multiplying Decimals with Hundredths Grids · 17

ANSWER

1.6

Multiplying Decimals with Hundredths Grids · 20

ANSWER

0.18

Multiplying Decimals with Hundredths Grids · 19

ANSWER

1.4

Multiplying Decimals with Hundredths Grids · 22

ANSWER

0.48

Multiplying Decimals with Hundredths Grids · 21

ANSWER

1.6

Multiplying Decimals with Hundredths Grids · 23

ANSWER

1.2