Multiplying Decimals with Hundredths Grids · 1

The pink columns show 1.2 and the blue rows show 0.6. Count the dark squares, which are shaded twice: 1.2 × 0.6 = ___

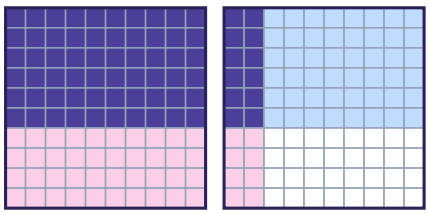

Multiplying Decimals with Hundredths Grids · 2

The pink columns show 1.4 and the blue rows show 0.3. Count the dark squares, which are shaded twice: 1.4 × 0.3 = ___

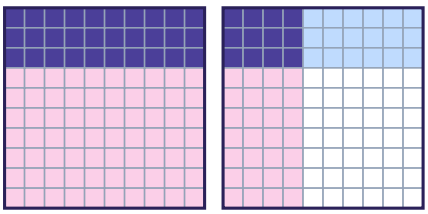

Multiplying Decimals with Hundredths Grids · 3

The pink columns show 1.5 and the blue rows show 0.4. Count the dark squares, which are shaded twice: 1.5 × 0.4 = ___

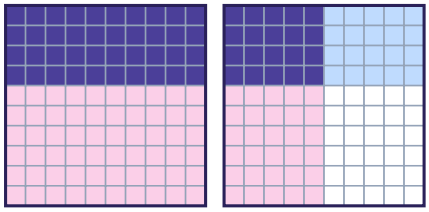

Multiplying Decimals with Hundredths Grids · 4

The pink columns show 1.2 and the blue rows show 0.9. Count the dark squares, which are shaded twice: 1.2 × 0.9 = ___

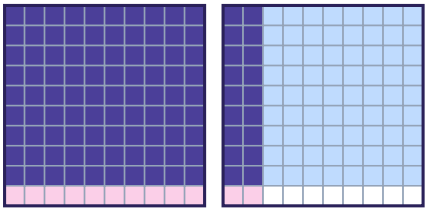

Multiplying Decimals with Hundredths Grids · 5

The pink columns show 1.9 and the blue rows show 0.5. Count the dark squares, which are shaded twice: 1.9 × 0.5 = ___

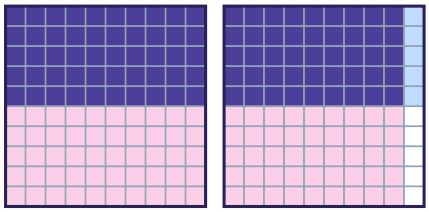

Multiplying Decimals with Hundredths Grids · 6

The pink columns show 1.6 and the blue rows show 0.2. Count the dark squares, which are shaded twice: 1.6 × 0.2 = ___

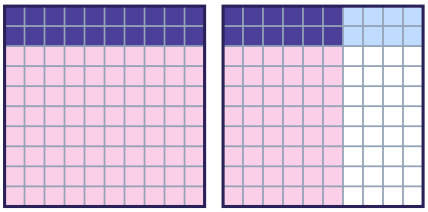

Multiplying Decimals with Hundredths Grids · 7

The pink columns show 1.9 and the blue rows show 0.7. Count the dark squares, which are shaded twice: 1.9 × 0.7 = ___

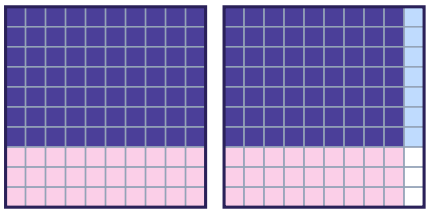

Multiplying Decimals with Hundredths Grids · 8

The pink columns show 1.1 and the blue rows show 0.5. Count the dark squares, which are shaded twice: 1.1 × 0.5 = ___

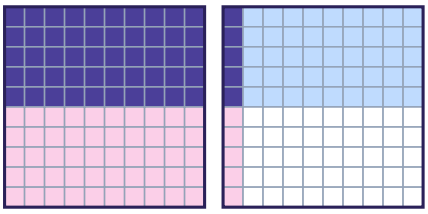

Multiplying Decimals with Hundredths Grids · 2

ANSWER

0.42

Multiplying Decimals with Hundredths Grids · 1

ANSWER

0.72

Multiplying Decimals with Hundredths Grids · 4

ANSWER

1.08

Multiplying Decimals with Hundredths Grids · 3

ANSWER

0.6

Multiplying Decimals with Hundredths Grids · 6

ANSWER

0.32

Multiplying Decimals with Hundredths Grids · 5

ANSWER

0.95

Multiplying Decimals with Hundredths Grids · 8

ANSWER

0.55

Multiplying Decimals with Hundredths Grids · 7

ANSWER

1.33

Multiplying Decimals with Hundredths Grids · 9

The pink columns show 1.7 and the blue rows show 0.5. Count the dark squares, which are shaded twice: 1.7 × 0.5 = ___

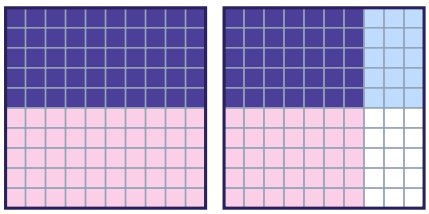

Multiplying Decimals with Hundredths Grids · 10

The pink columns show 1.4 and the blue rows show 0.2. Count the dark squares, which are shaded twice: 1.4 × 0.2 = ___

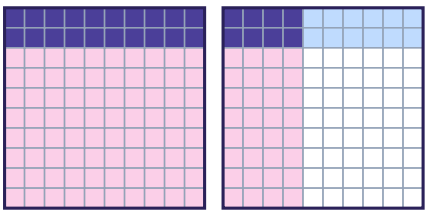

Multiplying Decimals with Hundredths Grids · 11

The pink columns show 1.8 and the blue rows show 0.4. Count the dark squares, which are shaded twice: 1.8 × 0.4 = ___

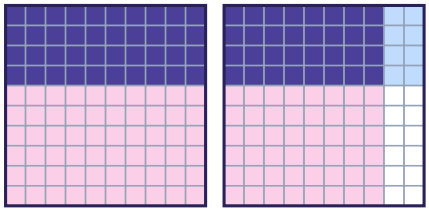

Multiplying Decimals with Hundredths Grids · 10

ANSWER

0.28

Multiplying Decimals with Hundredths Grids · 9

ANSWER

0.85

Multiplying Decimals with Hundredths Grids · 11

ANSWER

0.72