Multiplying Decimals with Hundredths Grids · 1

The pink columns show 0.4 and the blue rows show 0.2. Count the dark squares, which are shaded twice: 0.4 × 0.2 = ___

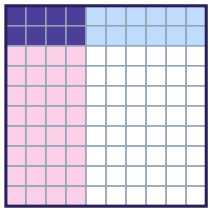

Multiplying Decimals with Hundredths Grids · 2

The blue rows show 0.2 and the dark squares show 0.1. What number do the pink columns show? ___ × 0.2 = 0.1

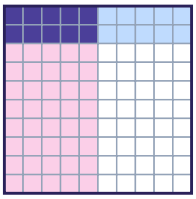

Multiplying Decimals with Hundredths Grids · 3

The blue rows show 0.7 and the dark squares show 0.21. What number do the pink columns show? ___ × 0.7 = 0.21



Multiplying Decimals with Hundredths Grids · 4

The pink columns show 0.4 and the blue rows show 0.3. Count the dark squares, which are shaded twice: 0.4 × 0.3 = ___



Multiplying Decimals with Hundredths Grids · 5

The blue rows show 0.2 and the dark squares show 0.06. What number do the pink columns show? ___ × 0.2 = 0.06



Multiplying Decimals with Hundredths Grids · 6

The pink columns show 0.1 and the blue rows show 0.2. Count the dark squares, which are shaded twice: 0.1 × 0.2 = ___

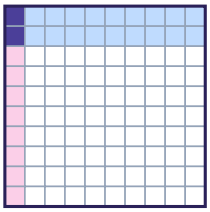

Multiplying Decimals with Hundredths Grids · 7

The blue rows show 0.1 and the dark squares show 0.04. What number do the pink columns show? ___ × 0.1 = 0.04



Multiplying Decimals with Hundredths Grids · 8

The pink columns show 0.2 and the blue rows show 0.1. Count the dark squares, which are shaded twice: 0.2 × 0.1 = ___

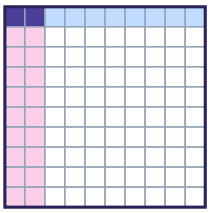

Multiplying Decimals with Hundredths Grids · 2

ANSWER

0.5

Multiplying Decimals with Hundredths Grids · 1

ANSWER

0.08

Multiplying Decimals with Hundredths Grids · 4

ANSWER

0.12

Multiplying Decimals with Hundredths Grids · 3

ANSWER

0.3

Multiplying Decimals with Hundredths Grids · 6

ANSWER

0.02

Multiplying Decimals with Hundredths Grids · 5

ANSWER

0.3

Multiplying Decimals with Hundredths Grids · 8

ANSWER

0.02

Multiplying Decimals with Hundredths Grids · 7

ANSWER

0.4

Multiplying Decimals with Hundredths Grids · 9

The blue rows show 0.4 and the dark squares show 0.12. What number do the pink columns show? ___ × 0.4 = 0.12



Multiplying Decimals with Hundredths Grids · 10

The pink columns show 0.8 and the blue rows show 0.5. Count the dark squares, which are shaded twice: 0.8 × 0.5 = ___

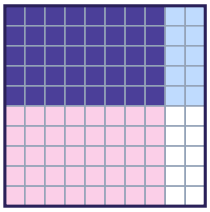

Multiplying Decimals with Hundredths Grids · 11

The blue rows show 0.7 and the dark squares show 0.28. What number do the pink columns show? ___ × 0.7 = 0.28



Multiplying Decimals with Hundredths Grids · 12

The pink columns show 0.5 and the blue rows show 0.2. Count the dark squares, which are shaded twice: 0.5 × 0.2 = ___

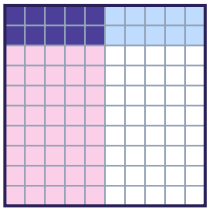

Multiplying Decimals with Hundredths Grids · 13

The blue rows show 0.1 and the dark squares show 0.05. What number do the pink columns show? ___ × 0.1 = 0.05

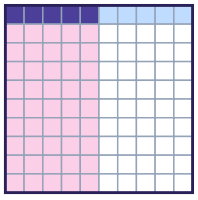

Multiplying Decimals with Hundredths Grids · 14

The pink columns show 0.5 and the blue rows show 0.3. Count the dark squares, which are shaded twice: 0.5 × 0.3 = ___

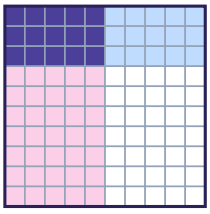

Multiplying Decimals with Hundredths Grids · 15

The blue rows show 0.4 and the dark squares show 0.16. What number do the pink columns show? ___ × 0.4 = 0.16



Multiplying Decimals with Hundredths Grids · 16

The pink columns show 0.2 and the blue rows show 0.4. Count the dark squares, which are shaded twice: 0.2 × 0.4 = ___

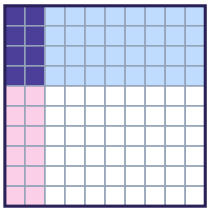

Multiplying Decimals with Hundredths Grids · 10

ANSWER

0.4

Multiplying Decimals with Hundredths Grids · 9

ANSWER

0.3

Multiplying Decimals with Hundredths Grids · 12

ANSWER

0.1

Multiplying Decimals with Hundredths Grids · 11

ANSWER

0.4

Multiplying Decimals with Hundredths Grids · 14

ANSWER

0.15

Multiplying Decimals with Hundredths Grids · 13

ANSWER

0.5

Multiplying Decimals with Hundredths Grids · 16

ANSWER

0.08

Multiplying Decimals with Hundredths Grids · 15

ANSWER

0.4

Multiplying Decimals with Hundredths Grids · 17

The blue rows show 0.5 and the dark squares show 0.25. What number do the pink columns show? ___ × 0.5 = 0.25



Multiplying Decimals with Hundredths Grids · 18

The pink columns show 0.4 and the blue rows show 0.4. Count the dark squares, which are shaded twice: 0.4 × 0.4 = ___



Multiplying Decimals with Hundredths Grids · 19

The pink columns show 0.4 and the blue rows show 0.5. Count the dark squares, which are shaded twice: 0.4 × 0.5 = ___



Multiplying Decimals with Hundredths Grids · 20

The pink columns show 0.7 and the blue rows show 0.7. Count the dark squares, which are shaded twice: 0.7 × 0.7 = ___



Multiplying Decimals with Hundredths Grids · 21

The blue rows show 0.8 and the dark squares show 0.72. What number do the pink columns show? ___ × 0.8 = 0.72

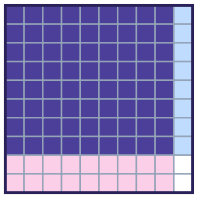

Multiplying Decimals with Hundredths Grids · 18

ANSWER

0.16

Multiplying Decimals with Hundredths Grids · 17

ANSWER

0.5

Multiplying Decimals with Hundredths Grids · 20

ANSWER

0.49

Multiplying Decimals with Hundredths Grids · 19

ANSWER

0.2

Multiplying Decimals with Hundredths Grids · 21

ANSWER

0.9