Multiplying Decimals by Whole Numbers with Hundredths Grids · 1

Each color shows one group of 0.13. Count all the shaded squares: 2 × 0.13 = ___

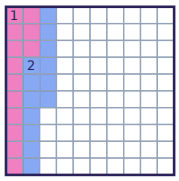

Multiplying Decimals by Whole Numbers with Hundredths Grids · 2

The grids show 3 equal groups in different colors, 1.92 in all. How much is one group? 3 × ___ = 1.92

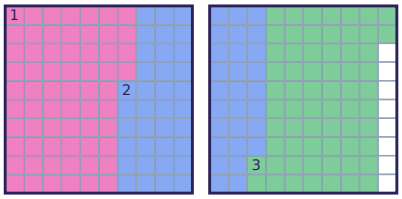

Multiplying Decimals by Whole Numbers with Hundredths Grids · 3

Each color shows one group of 0.58. Count all the shaded squares: 3 × 0.58 = ___

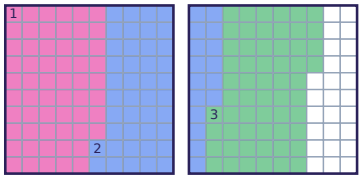

Multiplying Decimals by Whole Numbers with Hundredths Grids · 4

The grids show 2 equal groups in different colors, 1.46 in all. How much is one group? 2 × ___ = 1.46

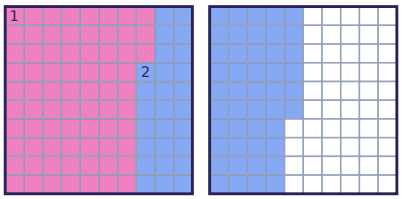

Multiplying Decimals by Whole Numbers with Hundredths Grids · 5

Each color shows one group of 0.76. Count all the shaded squares: 2 × 0.76 = ___

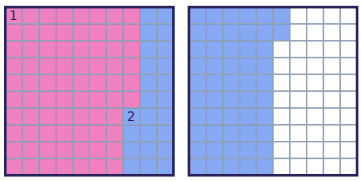

Multiplying Decimals by Whole Numbers with Hundredths Grids · 6

The grids show 4 equal groups in different colors, 2.08 in all. How much is one group? 4 × ___ = 2.08

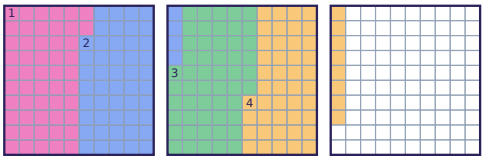

Multiplying Decimals by Whole Numbers with Hundredths Grids · 7

Each color shows one group of 0.35. Count all the shaded squares: 2 × 0.35 = ___

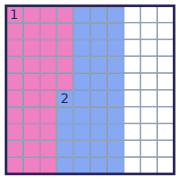

Multiplying Decimals by Whole Numbers with Hundredths Grids · 8

The grids show 2 equal groups in different colors, 1.7 in all. How much is one group? 2 × ___ = 1.7

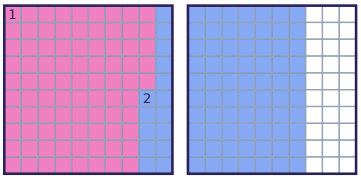

Multiplying Decimals by Whole Numbers with Hundredths Grids · 2

ANSWER

0.64

Multiplying Decimals by Whole Numbers with Hundredths Grids · 1

ANSWER

0.26

Multiplying Decimals by Whole Numbers with Hundredths Grids · 4

ANSWER

0.73

Multiplying Decimals by Whole Numbers with Hundredths Grids · 3

ANSWER

1.74

Multiplying Decimals by Whole Numbers with Hundredths Grids · 6

ANSWER

0.52

Multiplying Decimals by Whole Numbers with Hundredths Grids · 5

ANSWER

1.52

Multiplying Decimals by Whole Numbers with Hundredths Grids · 8

ANSWER

0.85

Multiplying Decimals by Whole Numbers with Hundredths Grids · 7

ANSWER

0.7

Each color shows one group of 0.35. Count all the shaded squares: 3 × 0.35 = ___

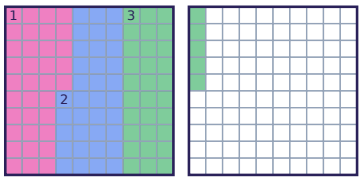

The grids show 2 equal groups in different colors, 1.94 in all. How much is one group? 2 × ___ = 1.94

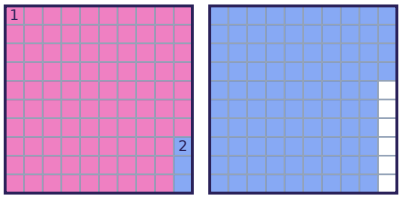

Each color shows one group of 0.41. Count all the shaded squares: 3 × 0.41 = ___

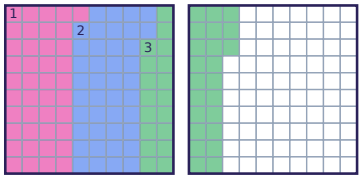

The grids show 3 equal groups in different colors, 2.52 in all. How much is one group? 3 × ___ = 2.52

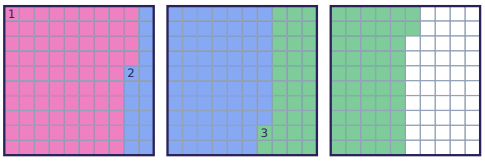

Each color shows one group of 0.14. Count all the shaded squares: 5 × 0.14 = ___

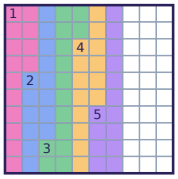

The grids show 5 equal groups in different colors, 1.45 in all. How much is one group? 5 × ___ = 1.45

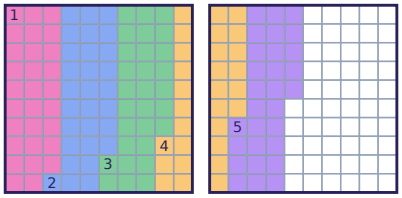

Each color shows one group of 0.34. Count all the shaded squares: 5 × 0.34 = ___

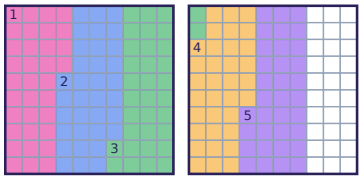

The grids show 2 equal groups in different colors, 1.34 in all. How much is one group? 2 × ___ = 1.34

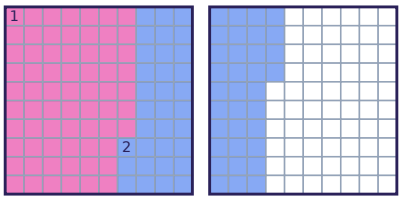

Multiplying Decimals by Whole Numbers with Hundredths Grids · 10

ANSWER

0.97

Multiplying Decimals by Whole Numbers with Hundredths Grids · 9

ANSWER

1.05

Multiplying Decimals by Whole Numbers with Hundredths Grids · 12

ANSWER

0.84

Multiplying Decimals by Whole Numbers with Hundredths Grids · 11

ANSWER

1.23

Multiplying Decimals by Whole Numbers with Hundredths Grids · 14

ANSWER

0.29

Multiplying Decimals by Whole Numbers with Hundredths Grids · 13

ANSWER

0.7

Multiplying Decimals by Whole Numbers with Hundredths Grids · 16

ANSWER

0.67

Multiplying Decimals by Whole Numbers with Hundredths Grids · 15

ANSWER

1.7

Each color shows one group of 0.34. Count all the shaded squares: 3 × 0.34 = ___

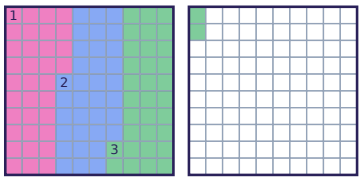

The grids show 5 equal groups in different colors, 2.75 in all. How much is one group? 5 × ___ = 2.75

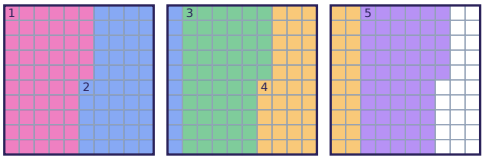

Each color shows one group of 0.42. Count all the shaded squares: 2 × 0.42 = ___

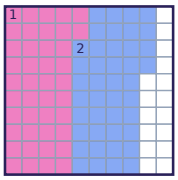

The grids show 3 equal groups in different colors, 1.74 in all. How much is one group? 3 × ___ = 1.74

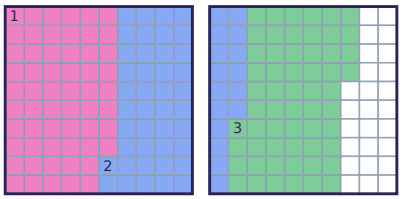

Each color shows one group of 0.53. Count all the shaded squares: 2 × 0.53 = ___

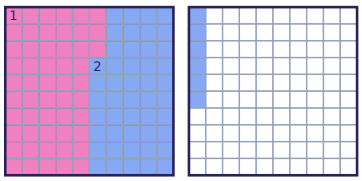

The grids show 4 equal groups in different colors, 1.8 in all. How much is one group? 4 × ___ = 1.8

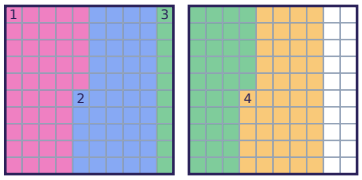

Each color shows one group of 0.25. Count all the shaded squares: 5 × 0.25 = ___

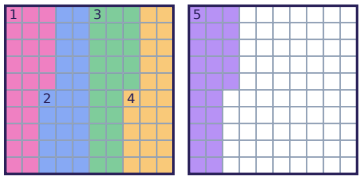

The grids show 5 equal groups in different colors, 2.25 in all. How much is one group? 5 × ___ = 2.25

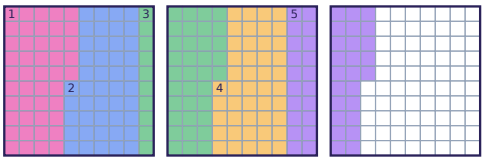

Multiplying Decimals by Whole Numbers with Hundredths Grids · 18

ANSWER

0.55

Multiplying Decimals by Whole Numbers with Hundredths Grids · 17

ANSWER

1.02

Multiplying Decimals by Whole Numbers with Hundredths Grids · 20

ANSWER

0.58

Multiplying Decimals by Whole Numbers with Hundredths Grids · 19

ANSWER

0.84

Multiplying Decimals by Whole Numbers with Hundredths Grids · 22

ANSWER

0.45

Multiplying Decimals by Whole Numbers with Hundredths Grids · 21

ANSWER

1.06

Multiplying Decimals by Whole Numbers with Hundredths Grids · 24

ANSWER

0.45

Multiplying Decimals by Whole Numbers with Hundredths Grids · 23

ANSWER

1.25