Multiplying Decimals by Whole Numbers with Hundredths Grids · 1

Each color shows one group of 0.2. Count all the shaded squares: 5 × 0.2 = ___

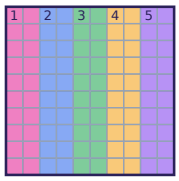

Multiplying Decimals by Whole Numbers with Hundredths Grids · 2

The grids show 3 equal groups in different colors, 0.6 in all. How much is one group? 3 × ___ = 0.6

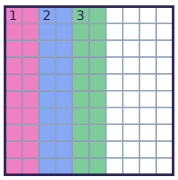

Multiplying Decimals by Whole Numbers with Hundredths Grids · 3

The grids show 3 equal groups in different colors, 1.2 in all. How much is one group? 3 × ___ = 1.2

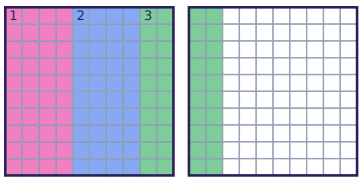

Multiplying Decimals by Whole Numbers with Hundredths Grids · 4

Each color shows one group of 0.27. Count all the shaded squares: 2 × 0.27 = ___

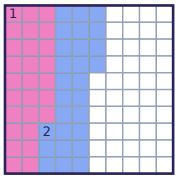

Multiplying Decimals by Whole Numbers with Hundredths Grids · 5

The grids show 3 equal groups in different colors, 0.78 in all. How much is one group? 3 × ___ = 0.78

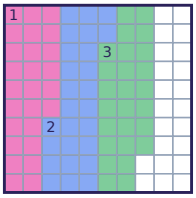

Multiplying Decimals by Whole Numbers with Hundredths Grids · 6

Each color shows one group of 0.3. Count all the shaded squares: 2 × 0.3 = ___

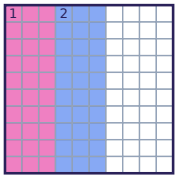

Multiplying Decimals by Whole Numbers with Hundredths Grids · 7

The grids show 3 equal groups in different colors, 0.3 in all. How much is one group? 3 × ___ = 0.3

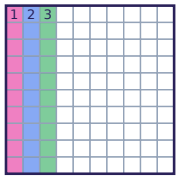

Multiplying Decimals by Whole Numbers with Hundredths Grids · 8

The grids show 2 equal groups in different colors, 1.4 in all. How much is one group? 2 × ___ = 1.4

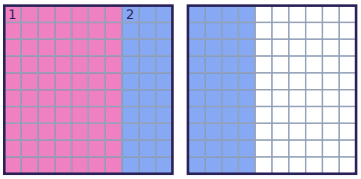

Multiplying Decimals by Whole Numbers with Hundredths Grids · 2

ANSWER

0.2

Multiplying Decimals by Whole Numbers with Hundredths Grids · 1

ANSWER

1

Multiplying Decimals by Whole Numbers with Hundredths Grids · 4

ANSWER

0.54

Multiplying Decimals by Whole Numbers with Hundredths Grids · 3

ANSWER

0.4

Multiplying Decimals by Whole Numbers with Hundredths Grids · 6

ANSWER

0.6

Multiplying Decimals by Whole Numbers with Hundredths Grids · 5

ANSWER

0.26

Multiplying Decimals by Whole Numbers with Hundredths Grids · 8

ANSWER

0.7

Multiplying Decimals by Whole Numbers with Hundredths Grids · 7

ANSWER

0.1

Multiplying Decimals by Whole Numbers with Hundredths Grids · 9

Each color shows one group of 0.13. Count all the shaded squares: 3 × 0.13 = ___

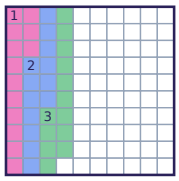

Multiplying Decimals by Whole Numbers with Hundredths Grids · 10

The grids show 2 equal groups in different colors, 0.86 in all. How much is one group? 2 × ___ = 0.86

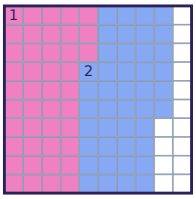

Multiplying Decimals by Whole Numbers with Hundredths Grids · 11

Each color shows one group of 0.1. Count all the shaded squares: 4 × 0.1 = ___

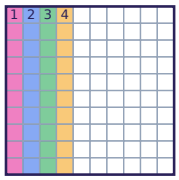

Multiplying Decimals by Whole Numbers with Hundredths Grids · 12

The grids show 2 equal groups in different colors, 0.6 in all. How much is one group? 2 × ___ = 0.6

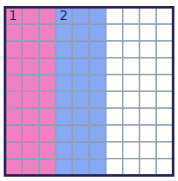

Multiplying Decimals by Whole Numbers with Hundredths Grids · 13

Each color shows one group of 0.2. Count all the shaded squares: 3 × 0.2 = ___

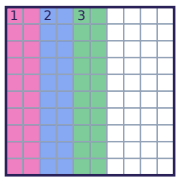

Multiplying Decimals by Whole Numbers with Hundredths Grids · 14

The grids show 4 equal groups in different colors, 2 in all. How much is one group? 4 × ___ = 2

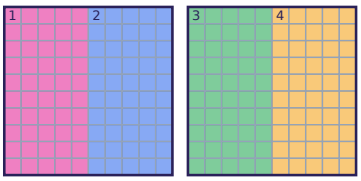

Multiplying Decimals by Whole Numbers with Hundredths Grids · 15

Each color shows one group of 0.23. Count all the shaded squares: 3 × 0.23 = ___

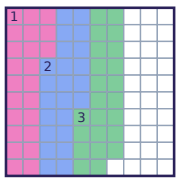

Multiplying Decimals by Whole Numbers with Hundredths Grids · 16

The grids show 2 equal groups in different colors, 0.32 in all. How much is one group? 2 × ___ = 0.32

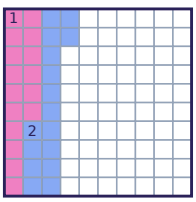

Multiplying Decimals by Whole Numbers with Hundredths Grids · 10

ANSWER

0.43

Multiplying Decimals by Whole Numbers with Hundredths Grids · 9

ANSWER

0.39

Multiplying Decimals by Whole Numbers with Hundredths Grids · 12

ANSWER

0.3

Multiplying Decimals by Whole Numbers with Hundredths Grids · 11

ANSWER

0.4

Multiplying Decimals by Whole Numbers with Hundredths Grids · 14

ANSWER

0.5

Multiplying Decimals by Whole Numbers with Hundredths Grids · 13

ANSWER

0.6

Multiplying Decimals by Whole Numbers with Hundredths Grids · 16

ANSWER

0.16

Multiplying Decimals by Whole Numbers with Hundredths Grids · 15

ANSWER

0.69

Multiplying Decimals by Whole Numbers with Hundredths Grids · 17

Each color shows one group of 0.3. Count all the shaded squares: 3 × 0.3 = ___

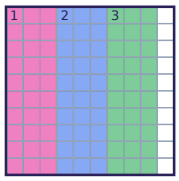

Multiplying Decimals by Whole Numbers with Hundredths Grids · 18

The grids show 4 equal groups in different colors, 0.8 in all. How much is one group? 4 × ___ = 0.8

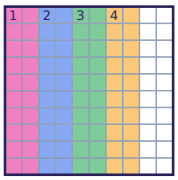

Multiplying Decimals by Whole Numbers with Hundredths Grids · 19

Each color shows one group of 0.1. Count all the shaded squares: 5 × 0.1 = ___

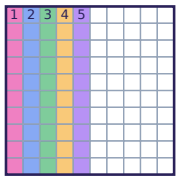

Multiplying Decimals by Whole Numbers with Hundredths Grids · 20

The grids show 2 equal groups in different colors, 1.6 in all. How much is one group? 2 × ___ = 1.6

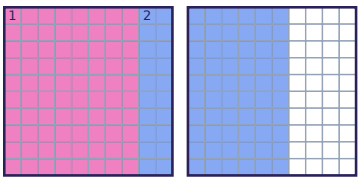

Multiplying Decimals by Whole Numbers with Hundredths Grids · 21

Each color shows one group of 0.14. Count all the shaded squares: 3 × 0.14 = ___

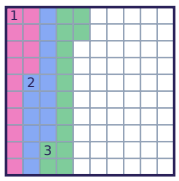

Multiplying Decimals by Whole Numbers with Hundredths Grids · 22

The grids show 2 equal groups in different colors, 0.98 in all. How much is one group? 2 × ___ = 0.98

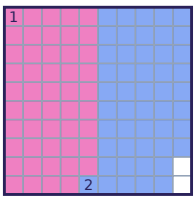

Multiplying Decimals by Whole Numbers with Hundredths Grids · 18

ANSWER

0.2

Multiplying Decimals by Whole Numbers with Hundredths Grids · 17

ANSWER

0.9

Multiplying Decimals by Whole Numbers with Hundredths Grids · 20

ANSWER

0.8

Multiplying Decimals by Whole Numbers with Hundredths Grids · 19

ANSWER

0.5

Multiplying Decimals by Whole Numbers with Hundredths Grids · 22

ANSWER

0.49

Multiplying Decimals by Whole Numbers with Hundredths Grids · 21

ANSWER

0.42