Task card 1 Halloween Math

Sam buys a pumpkin for $5.10 and pays with a $10 bill. How much change does Sam get?

Task card 2 Halloween Math

One batch of a recipe uses $\frac{1}{3}$ cup of candy corn. Ava makes 2 batches. How many cups of candy corn does Ava use?

Task card 3 Halloween Math

One bag of candy costs $7.55. Ella buys 3 bags of candy. How much does Ella spend?

Task card 4 Halloween Math

Ava buys a costume mask for $9.80 and pays with a $10 bill. How much change does Ava get?

Task card 5 Halloween Math

One batch of a recipe uses $\frac{1}{4}$ cup of candy corn. Omar makes 2 batches. How many cups of candy corn does Omar use?

Task card 6 Halloween Math

A costume box is 9 inches long, 6 inches wide and 5 inches tall. What is its volume in cubic inches?

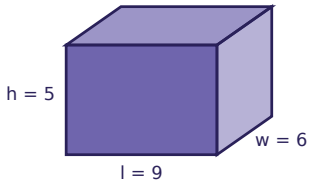

Task card 7 Halloween Math

One pumpkin costs $5.50. Lily buys 2 pumpkins. How much does Lily spend?

Task card 8 Halloween Math

A costume box is 4 inches long, 7 inches wide and 2 inches tall. What is its volume in cubic inches?

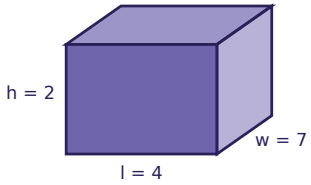

Task card 9 Halloween Math

One pumpkin costs $4.05. Ben buys 3 pumpkins. How much does Ben spend?

Task card 10 Halloween Math

One costume mask costs $5.60. Zoe buys 6 costume masks. How much does Zoe spend?

Task card 11 Halloween Math

A costume box is 5 inches long, 3 inches wide and 8 inches tall. What is its volume in cubic inches?

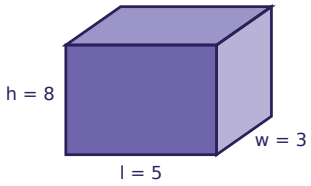

Task card 12 Halloween Math

Zoe buys a costume mask for $9.82 and pays with a $10 bill. How much change does Zoe get?

Task card 13 Halloween Math

One batch of a recipe uses $\frac{5}{6}$ cup of candy corn. Lily makes 2 batches. How many cups of candy corn does Lily use?

Task card 14 Halloween Math

Sam buys a bag of candy for $6.29 and pays with a $10 bill. How much change does Sam get?

Task card 15 Halloween Math

A costume box is 11 inches long, 8 inches wide and 7 inches tall. What is its volume in cubic inches?

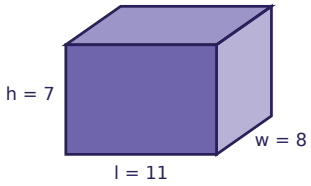

Task card 16 Halloween Math

One batch of a recipe uses $\frac{3}{8}$ cup of candy corn. Mia makes 4 batches. How many cups of candy corn does Mia use?

Task card 17 Halloween Math

One batch of a recipe uses $\frac{2}{3}$ cup of candy corn. Mia makes 3 batches. How many cups of candy corn does Mia use?

Task card 18 Halloween Math

One pumpkin costs $7.85. Noah buys 4 pumpkins. How much does Noah spend?

Task card 19 Halloween Math

A costume box is 11 inches long, 6 inches wide and 5 inches tall. What is its volume in cubic inches?

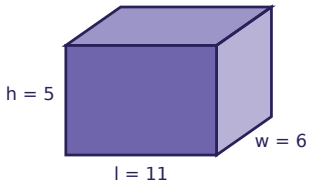

Task card 20 Halloween Math

One costume mask costs $8.35. Noah buys 2 costume masks. How much does Noah spend?

Task card 21 Halloween Math

Sam buys a pumpkin for $4.02 and pays with a $10 bill. How much change does Sam get?

Task card 22 Halloween Math

Noah buys a costume mask for $11.96 and pays with a $20 bill. How much change does Noah get?

Task card 23 Halloween Math

One batch of a recipe uses $\frac{3}{8}$ cup of candy corn. Lily makes 4 batches. How many cups of candy corn does Lily use?

Task card 24 Halloween Math

A costume box is 9 inches long, 4 inches wide and 2 inches tall. What is its volume in cubic inches?

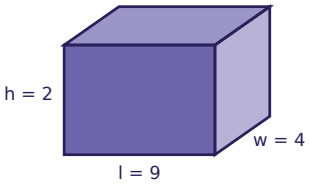

Halloween Math Task Cards

Recording sheet · Grade 5 · Read each story and solve. Write money like $4.50 and fractions like 1 1/2.

Name: _____ Date: _____

Scan to check your answers

1	2	3	4
5	6	7	8
9	10	11	12
13	14	15	16
17	18	19	20
21	22	23	24

Halloween Math Task Cards: Answer Key

Grade 5 · Medium

The answers online

1. $4.90	**2.** $\frac{2}{3}$	**3.** $22.65
4. $0.20	**5.** $\frac{1}{2}$	**6.** 270
7. $11.00	**8.** 56	**9.** $12.15
10. $33.60	**11.** 120	**12.** $0.18
13. $1\frac{2}{3}$	**14.** $3.71	**15.** 616
16. $1\frac{1}{2}$	**17.** 2	**18.** $31.40
19. 330	**20.** $16.70	**21.** $5.98
22. $8.04	**23.** $1\frac{1}{2}$	**24.** 72