Task card 1 Halloween Math

One batch of a recipe uses $\frac{3}{8}$ cup of candy corn. Lily makes 5 batches. How many cups of candy corn does Lily use?

Task card 2 Halloween Math

A costume box is 10 inches long, 8 inches wide and 2 inches tall. What is its volume in cubic inches?

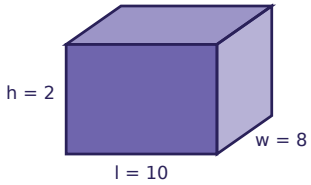

Task card 3 Halloween Math

One bag of candy costs $3.45. Mia buys 3 bags of candy. How much does Mia spend?

Task card 4 Halloween Math

Ella buys a costume mask for $5.23 and pays with a $10 bill. How much change does Ella get?

Task card 5 Halloween Math

One pumpkin costs $7.65. Omar buys 5 pumpkins. How much does Omar spend?

Task card 6 Halloween Math

A costume box is 10 inches long, 8 inches wide and 4 inches tall. What is its volume in cubic inches?

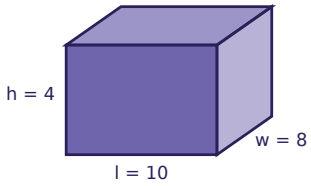

Task card 7 Halloween Math

Ben buys a bag of candy for $7.32 and pays with a $10 bill. How much change does Ben get?

Task card 8 Halloween Math

One batch of a recipe uses $\frac{2}{3}$ cup of candy corn. Sam makes 3 batches. How many cups of candy corn does Sam use?

Task card 9 Halloween Math

One batch of a recipe uses $\frac{5}{8}$ cup of candy corn. Omar makes 6 batches. How many cups of candy corn does Omar use?

Task card 10 Halloween Math

A costume box is 10 inches long, 6 inches wide and 8 inches tall. What is its volume in cubic inches?

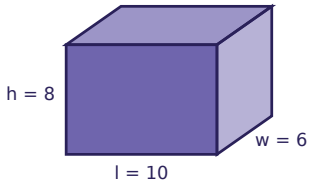

Task card 11 Halloween Math

A costume box is 4 inches long, 10 inches wide and 3 inches tall. What is its volume in cubic inches?

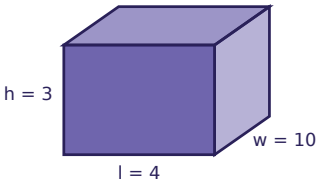

Task card 12 Halloween Math

One batch of a recipe uses $\frac{2}{3}$ cup of candy corn. Leo makes 7 batches. How many cups of candy corn does Leo use?

Task card 13 Halloween Math

One pumpkin costs $7.25. Leo buys 8 pumpkins. How much does Leo spend?

Task card 14 Halloween Math

Mia buys a pumpkin for $7.61 and pays with a $10 bill. How much change does Mia get?

Task card 15 Halloween Math

One costume mask costs $8.95. Omar buys 5 costume masks. How much does Omar spend?

Task card 16 Halloween Math

Noah buys a costume mask for $5.42 and pays with a $10 bill. How much change does Noah get?

Task card 17 Halloween Math

One batch of a recipe uses $\frac{2}{3}$ cup of candy corn. Omar makes 5 batches. How many cups of candy corn does Omar use?

Task card 18 Halloween Math

Omar buys a costume mask for $7.70 and pays with a $10 bill. How much change does Omar get?

Task card 19 Halloween Math

A costume box is 4 inches long, 9 inches wide and 8 inches tall. What is its volume in cubic inches?

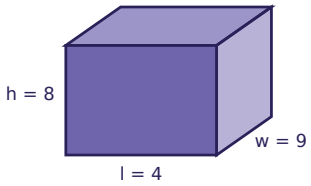

Task card 20 Halloween Math

Omar buys a costume mask for $9.44 and pays with a $10 bill. How much change does Omar get?

Task card 21 Halloween Math

One pumpkin costs $4.10. Noah buys 2 pumpkins. How much does Noah spend?

Task card 22 Halloween Math

One batch of a recipe uses $\frac{5}{8}$ cup of candy corn. Zoe makes 5 batches. How many cups of candy corn does Zoe use?

Task card 23 Halloween Math

One bag of candy costs $5.40. Lily buys 2 bags of candy. How much does Lily spend?

Task card 24 Halloween Math

A costume box is 12 inches long, 5 inches wide and 2 inches tall. What is its volume in cubic inches?

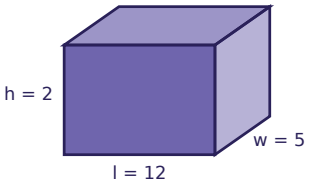

Halloween Math Task Cards

Recording sheet · Grade 5 · Read each story and solve. Write money like $4.50 and fractions like 1 1/2.

Name: _____ Date: _____

Scan to check your answers

1	2	3	4
5	6	7	8
9	10	11	12
13	14	15	16
17	18	19	20
21	22	23	24

Halloween Math Task Cards: Answer Key

Grade 5 · Hard

The answers online

1. $1\frac{7}{8}$	**2.** 160	**3.** $10.35
4. $4.77	**5.** $38.25	**6.** 320
7. $2.68	**8.** 2	**9.** $3\frac{3}{4}$
10. 480	**11.** 120	**12.** $4\frac{2}{3}$
13. $58.00	**14.** $2.39	**15.** $44.75
16. $4.58	**17.** $3\frac{1}{3}$	**18.** $2.30
19. 288	**20.** $0.56	**21.** $8.20
22. $3\frac{1}{8}$	**23.** $10.80	**24.** 120