Task card 1 Halloween Math

One batch of a recipe uses $\frac{1}{3}$ cup of candy corn. Zoe makes 3 batches. How many cups of candy corn does Zoe use?

Task card 2 Halloween Math

One costume mask costs $6.75. Noah buys 3 costume masks. How much does Noah spend?

Task card 3 Halloween Math

A costume box is 7 inches long, 3 inches wide and 3 inches tall. What is its volume in cubic inches?

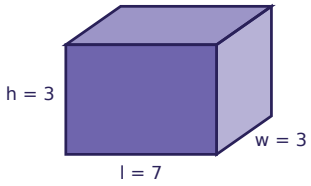

Task card 4 Halloween Math

One batch of a recipe uses $\frac{1}{4}$ cup of candy corn. Noah makes 3 batches. How many cups of candy corn does Noah use?

Task card 5 Halloween Math

Leo buys a costume mask for $10.70 and pays with a $20 bill. How much change does Leo get?

Task card 6 Halloween Math

A costume box is 6 inches long, 4 inches wide and 4 inches tall. What is its volume in cubic inches?

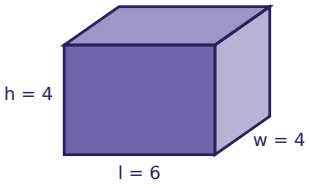

Task card 7 Halloween Math

Lily buys a pumpkin for $6.65 and pays with a $10 bill. How much change does Lily get?

Task card 8 Halloween Math

One costume mask costs $10.20. Mia buys 3 costume masks. How much does Mia spend?

Task card 9 Halloween Math

Omar buys a pumpkin for $7.60 and pays with a $10 bill. How much change does Omar get?

Task card 10 Halloween Math

One bag of candy costs $7.85. Omar buys 4 bags of candy. How much does Omar spend?

Task card 11 Halloween Math

One costume mask costs $9.85. Ella buys 4 costume masks. How much does Ella spend?

Task card 12 Halloween Math

A costume box is 7 inches long, 6 inches wide and 3 inches tall. What is its volume in cubic inches?

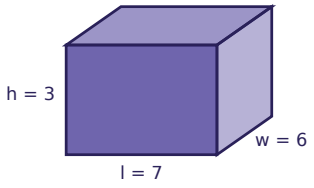

Task card 13 Halloween Math

A costume box is 4 inches long, 3 inches wide and 4 inches tall. What is its volume in cubic inches?

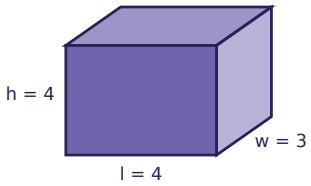

Task card 14 Halloween Math

One batch of a recipe uses $\frac{3}{4}$ cup of candy corn. Lily makes 4 batches. How many cups of candy corn does Lily use?

Task card 15 Halloween Math

One batch of a recipe uses $\frac{1}{3}$ cup of candy corn. Leo makes 2 batches. How many cups of candy corn does Leo use?

Task card 16 Halloween Math

Omar buys a costume mask for $11.25 and pays with a $20 bill. How much change does Omar get?

Task card 17 Halloween Math

Leo buys a pumpkin for $5.15 and pays with a $10 bill. How much change does Leo get?

Task card 18 Halloween Math

One batch of a recipe uses $\frac{1}{3}$ cup of candy corn. Omar makes 3 batches. How many cups of candy corn does Omar use?

Task card 19 Halloween Math

One bag of candy costs $4.95. Ava buys 3 bags of candy. How much does Ava spend?

Task card 20 Halloween Math

One bag of candy costs $7.50. Omar buys 5 bags of candy. How much does Omar spend?

Task card 21 Halloween Math

A costume box is 4 inches long, 7 inches wide and 2 inches tall. What is its volume in cubic inches?

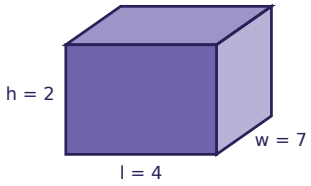

Task card 22 Halloween Math

One batch of a recipe uses $\frac{1}{2}$ cup of candy corn. Ella makes 2 batches. How many cups of candy corn does Ella use?

Task card 23 Halloween Math

A costume box is 8 inches long, 7 inches wide and 4 inches tall. What is its volume in cubic inches?

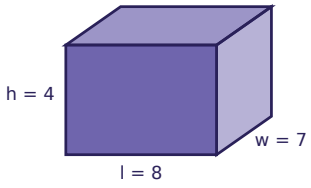

Task card 24 Halloween Math

Mia buys a bag of candy for $5.65 and pays with a $10 bill. How much change does Mia get?

Halloween Math Task Cards

Recording sheet · Grade 5 · Read each story and solve. Write money like $4.50 and fractions like 1 1/2.

Name: _____ Date: _____

Scan to check your answers

1	2	3	4
5	6	7	8
9	10	11	12
13	14	15	16
17	18	19	20
21	22	23	24

Halloween Math Task Cards: Answer Key

Grade 5 · Easy

The answers online

1. 1	**2.** $20.25	**3.** 63
4. $\frac{3}{4}$	**5.** $9.30	**6.** 96
7. $3.35	**8.** $30.60	**9.** $2.40
10. $31.40	**11.** $39.40	**12.** 126
13. 48	**14.** 3	**15.** $\frac{2}{3}$
16. $8.75	**17.** $4.85	**18.** 1
19. $14.85	**20.** $37.50	**21.** 56
22. 1	**23.** 224	**24.** $4.35