Halloween Math · 1

One batch of a recipe uses $\frac{3}{8}$ cup of candy corn. Lily makes 5 batches. How many cups of candy corn does Lily use?

Halloween Math · 2

A costume box is 10 inches long, 8 inches wide and 2 inches tall. What is its volume in cubic inches?

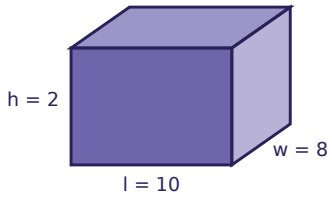

Halloween Math · 3

One bag of candy costs $3.45. Mia buys 3 bags of candy. How much does Mia spend?

Halloween Math · 4

Ella buys a costume mask for $5.23 and pays with a $10 bill. How much change does Ella get?

Halloween Math · 5

One pumpkin costs $7.65. Omar buys 5 pumpkins. How much does Omar spend?

Halloween Math · 6

A costume box is 10 inches long, 8 inches wide and 4 inches tall. What is its volume in cubic inches?

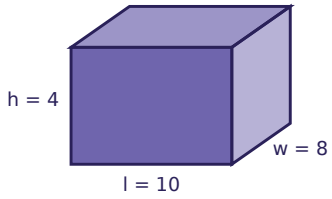

Halloween Math · 7

Ben buys a bag of candy for $7.32 and pays with a $10 bill. How much change does Ben get?

Halloween Math · 8

One batch of a recipe uses $\frac{2}{3}$ cup of candy corn. Sam makes 3 batches. How many cups of candy corn does Sam use?

Halloween Math · 2

ANSWER

160

Halloween Math · 1

ANSWER

$$1\frac{7}{8}$$

Halloween Math · 4

ANSWER

$4.77

Halloween Math · 3

ANSWER

$10.35

Halloween Math · 6

ANSWER

320

Halloween Math · 5

ANSWER

$38.25

Halloween Math · 8

ANSWER

2

Halloween Math · 7

ANSWER

$2.68

Halloween Math · 9

One batch of a recipe uses $\frac{5}{8}$ cup of candy corn. Omar makes 6 batches. How many cups of candy corn does Omar use?

Halloween Math · 10

A costume box is 10 inches long, 6 inches wide and 8 inches tall. What is its volume in cubic inches?

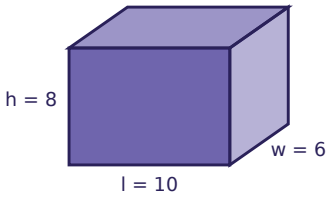

Halloween Math · 11

A costume box is 4 inches long, 10 inches wide and 3 inches tall. What is its volume in cubic inches?

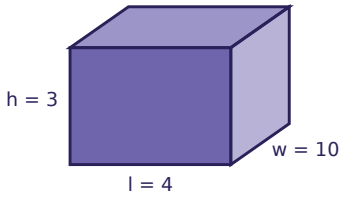

Halloween Math · 12

One batch of a recipe uses $\frac{2}{3}$ cup of candy corn. Leo makes 7 batches. How many cups of candy corn does Leo use?

Halloween Math · 13

One pumpkin costs $7.25. Leo buys 8 pumpkins. How much does Leo spend?

Halloween Math · 14

Mia buys a pumpkin for $7.61 and pays with a $10 bill. How much change does Mia get?

Halloween Math · 15

One costume mask costs $8.95. Omar buys 5 costume masks. How much does Omar spend?

Halloween Math · 16

Noah buys a costume mask for $5.42 and pays with a $10 bill. How much change does Noah get?

Halloween Math · 10

ANSWER

480

Halloween Math · 9

ANSWER

$3\frac{3}{4}$

Halloween Math · 12

ANSWER

$4\frac{2}{3}$

Halloween Math · 11

ANSWER

120

Halloween Math · 14

ANSWER

$2.39

Halloween Math · 13

ANSWER

$58.00

Halloween Math · 16

ANSWER

$4.58

Halloween Math · 15

ANSWER

$44.75

Halloween Math · 17

One batch of a recipe uses $\frac{2}{3}$ cup of candy corn. Omar makes 5 batches. How many cups of candy corn does Omar use?

Halloween Math · 18

Omar buys a costume mask for $7.70 and pays with a $10 bill. How much change does Omar get?

Halloween Math · 19

A costume box is 4 inches long, 9 inches wide and 8 inches tall. What is its volume in cubic inches?

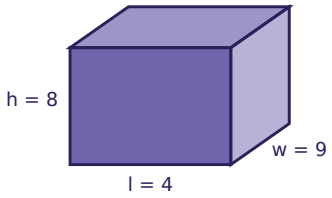

Halloween Math · 20

Omar buys a costume mask for $9.44 and pays with a $10 bill. How much change does Omar get?

Halloween Math · 21

One pumpkin costs $4.10. Noah buys 2 pumpkins. How much does Noah spend?

Halloween Math · 22

One batch of a recipe uses $\frac{5}{8}$ cup of candy corn. Zoe makes 5 batches. How many cups of candy corn does Zoe use?

Halloween Math · 23

One bag of candy costs $5.40. Lily buys 2 bags of candy. How much does Lily spend?

Halloween Math · 24

A costume box is 12 inches long, 5 inches wide and 2 inches tall. What is its volume in cubic inches?

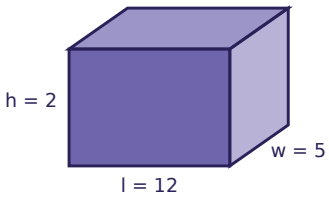

Halloween Math · 18

ANSWER

$2.30

Halloween Math · 17

ANSWER

$3\frac{1}{3}$

Halloween Math · 20

ANSWER

$0.56

Halloween Math · 19

ANSWER

288

Halloween Math · 22

ANSWER

$3\frac{1}{8}$

Halloween Math · 21

ANSWER

$8.20

Halloween Math · 24

ANSWER

120

Halloween Math · 23

ANSWER

$10.80